# MIRROR IMAGE

**BASICS OF MIRROR IMAGE-**

The image that is formed in the mirror of an object is called the mirror image of the object. In this, the image of the object which is near the mirror is formed first in the mirror and the image which is away from the mirror is formed later in the mirror.

I.e -

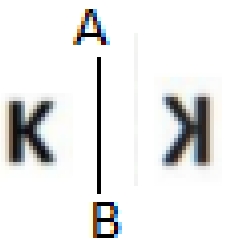

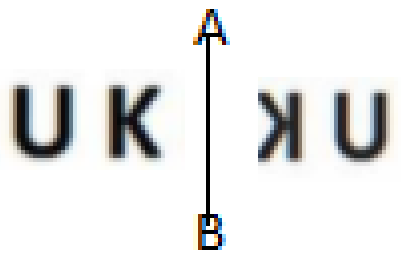

**English Alphabet in mirror image:**

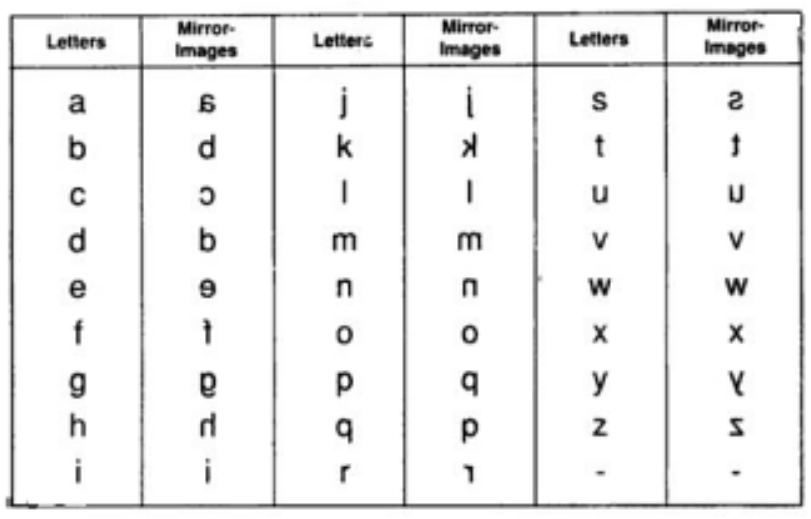

| Letters | Mirror-Images | Letters | Mirror-Images | Letters | Mirror-Images |
|---|---|---|---|---|---|
| a | ɒ | j | ꞁ | s | ƨ |
| b | d | k | ʞ | t | ɟ |
| c | ɔ | l | l | u | u |
| d | b | m | m | v | v |
| e | ɘ | n | n | w | w |
| f | ʇ | o | o | x | x |
| g | ϱ | p | q | y | ʏ |
| h | ʜ | q | p | z | ꙁ |
| i | i | r | ɿ | - | - |

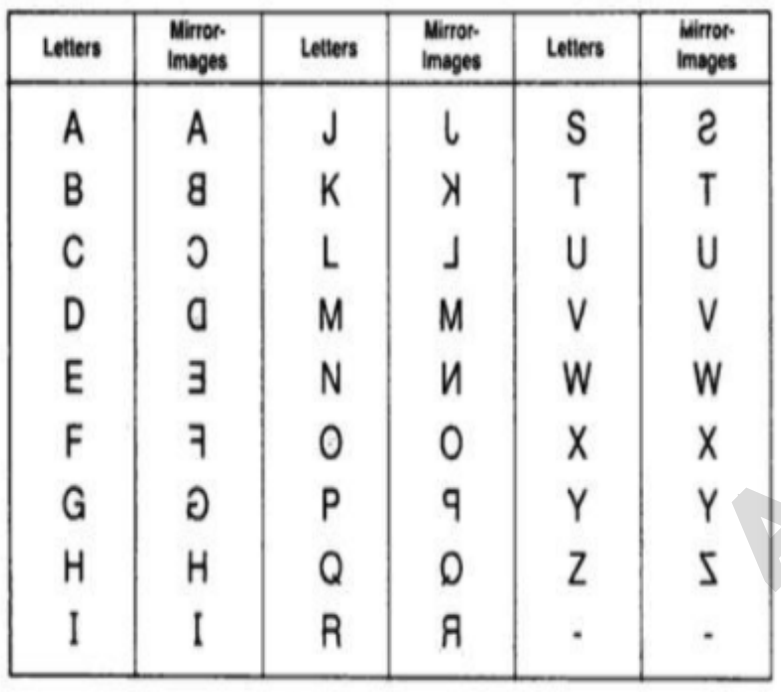

| Letters | Mirror-Images | Letters | Mirror-Images | Letters | Mirror-Images |
|---|---|---|---|---|---|
| A | A | J | Ⴑ | S | Ƨ |
| B | ᗺ | K | ꓘ | T | T |
| C | Ɔ | L | ⅃ | U | U |
| D | ᗡ | M | M | V | V |
| E | Ǝ | N | И | W | W |
| F | ꟻ | O | O | X | X |
| G | Ә | P | ꟼ | Y | Y |
| H | H | Q | Ọ | Z | ꙁ |
| I | I | R | Я | - | - |

**Numbers in mirror image:**

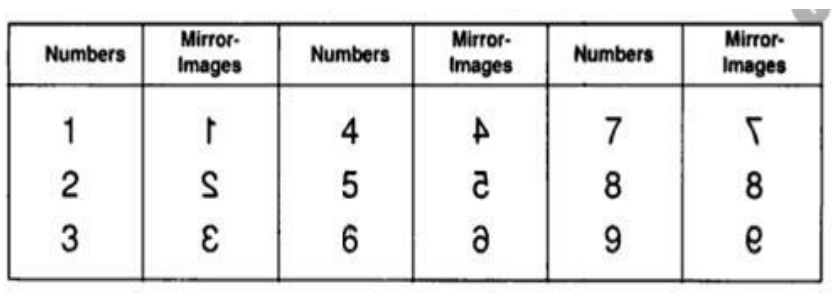

| Numbers | Mirror-Images | Numbers | Mirror-Images | Numbers | Mirror-Images |
|---|---|---|---|---|---|
| 1 | Ɩ | 4 | ᔭ | 7 | Ⴈ |
| 2 | Ƨ | 5 | ट | 8 | 8 |
| 3 | Ɛ | 6 | ∂ | 9 | ɘ |

**Now, see the above table carefully and solve the questions:**

## Questions :-

**SSC CPO 2018 Tier I**

**Q.1.** Select the correct mirror image of the given figure when the mirror is placed on the right of the figure.

SSC CPO 12/03/2019 (Morning)



(a)
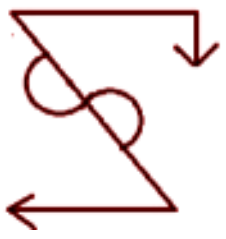

(b)
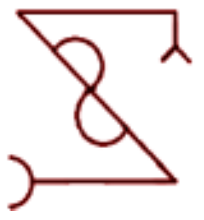

(c)
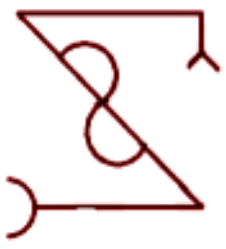

(d)
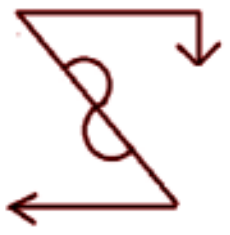

**Q.2.** Select the correct mirror image of the given figure when the mirror is placed on the right of the figure.

SSC CPO 12/03/2019 (Morning)



(a)


(b)


(c)
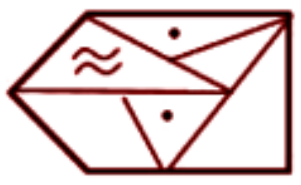

(d)
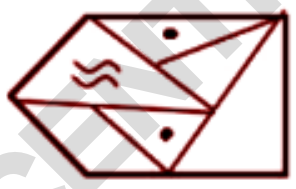

**Q.3.** Select the correct mirror image of the given figure when the mirror is placed on the right of the figure.

SSC CPO 12/03/2019 (Evening)

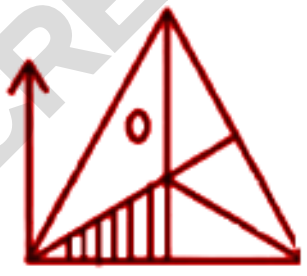

(a)


(b)
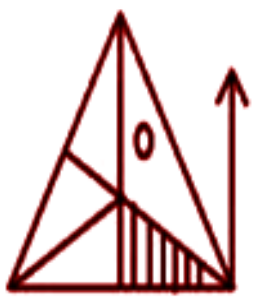

(c)
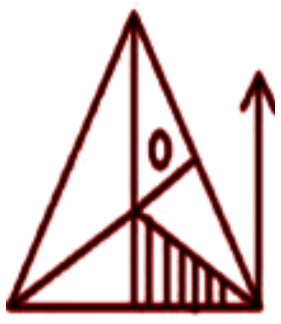

(d)
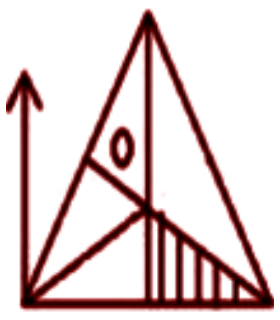

**Q.4.** Select the correct mirror image of the given figure when the mirror is placed on the right of the figure.

SSC CPO 12/03/2019 (Evening)

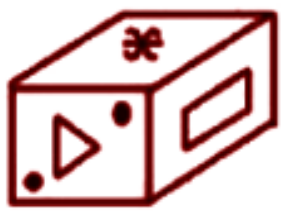

(a)
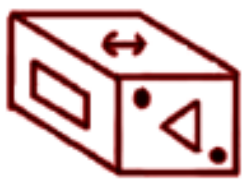

(b)


(c)


(d)


**Q.5.** Select the correct mirror image of the given figure when the mirror is placed on the right of the figure.

SSC CPO 13/03/2019(Morning)



(a)


(b)


(c)


(d)


**Q.6.** Select the correct mirror image of the given figure when the mirror is placed on the right of the figure.

SSC CPO 13/03/2019(Morning)

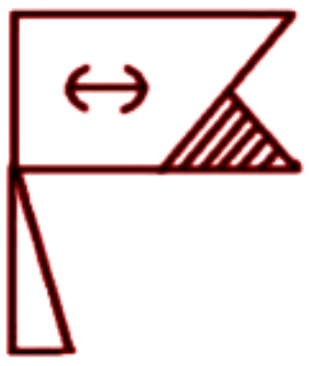

(a)
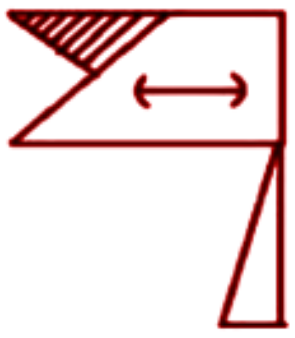

(b)
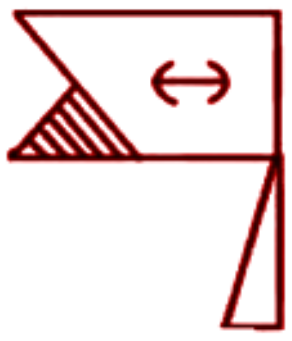

(c)
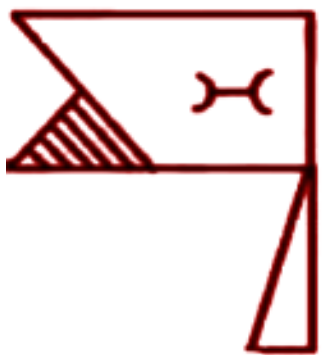

(d)
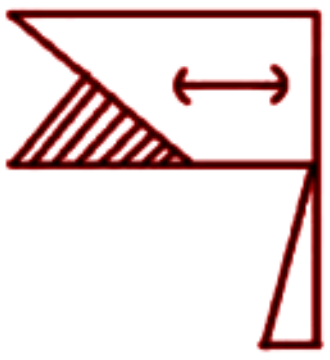

**Q.7.** Select the correct image of the given figure when the mirror is placed on the right of the figure:
SSC CPO 13/03/2019(Evening)

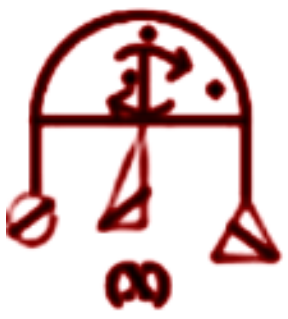

(a) 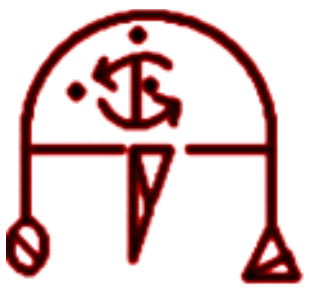
(b) 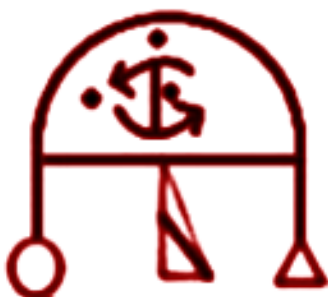
(c) 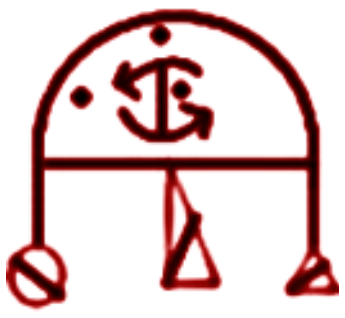
(d) 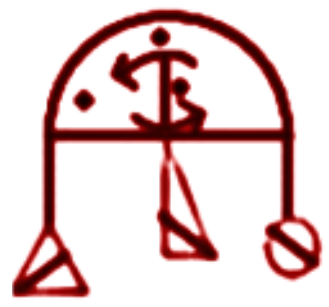

**Q.8.** Select the correct mirror image of the given figure when the mirror is placed on the right of the figure:
SSC CPO 13/03/2019(Evening)



(a) 
(b) 
(c) 
(d) 

**Q.9.** Select the correct mirror image of the given word when the mirror is placed on the right of the word.
SSC CPO 14/03/2019(Morning)



(a) 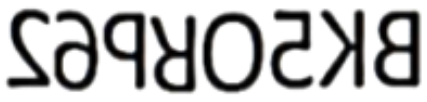
(b) 
(c) 
(d) 

**Q.10.** Select the mirror image of the given figure when the mirror is placed vertically to the right of the figure.
SSC CPO 14/03/2019(Morning)

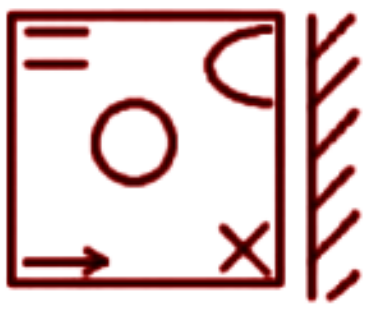

(a) 
(b) 
(c) 
(d) 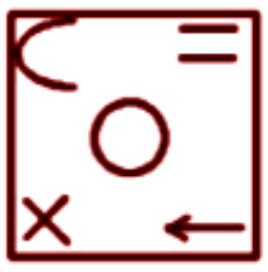

**Q.11.** Choose the mirror image of the given word if the mirror is placed to the right of the word.
SSC CPO 14/03/2019(Evening)

**E8t4g9C**

(a) 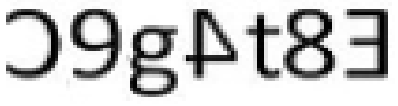
(b) 
(c) 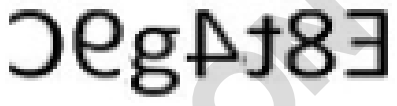
(d) 

**Q.12.** Select the correct image formed on the right end of the given shape keeping the mirror vertically
SSC CPO 14/03/2019(Evening)

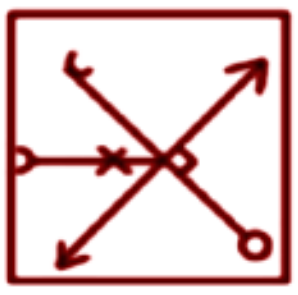

(a) 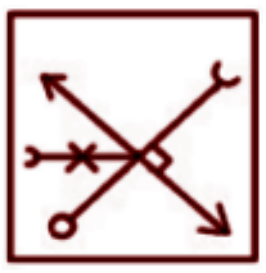
(b) 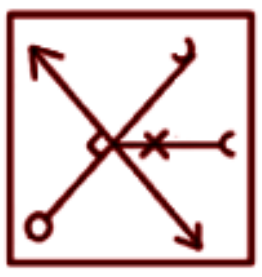
(c) 
(d) 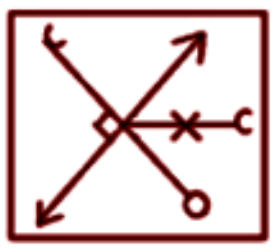

**Q.13.** Select the option that most closely resembles the mirror image of the given figure, when the mirror is placed on its right side.
SSC CPO 15/03/2019(Morning)

TER72HG

(a) 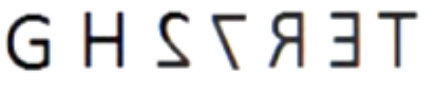
(b) 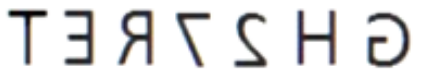
(c) 
(d) 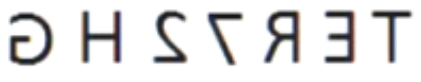

**Q.14.** Select the option that most closely resembles the mirror image of the given figure, when the mirror is placed on its right side.
SSC CPO 15/03/2019(Morning)

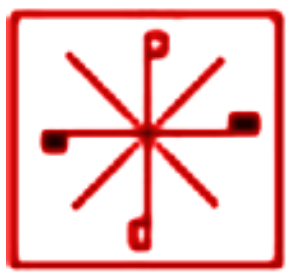

(a) 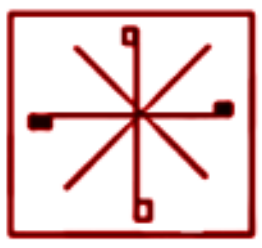
(b) 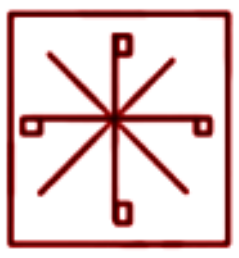
(c) 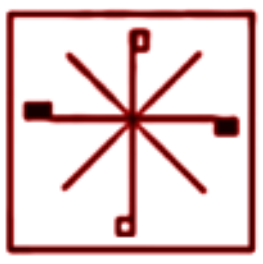
(d) 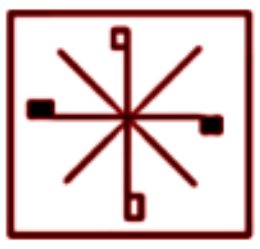

**Q.15.** Select the correct image of the given figure when the mirror is placed on the right of the figure:
SSC CPO 15/03/2019(Evening)

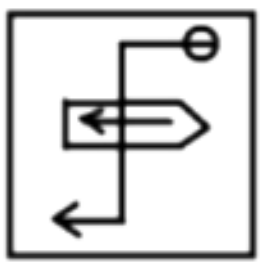

(a) 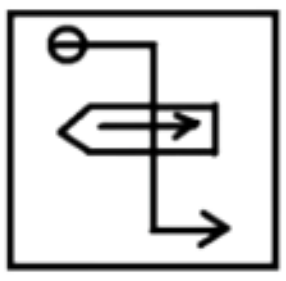
(b) 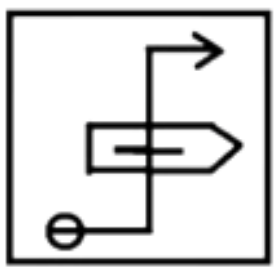
(c) 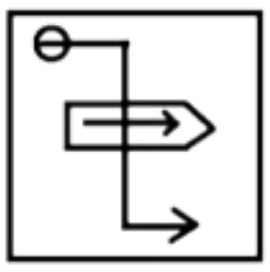
(d) 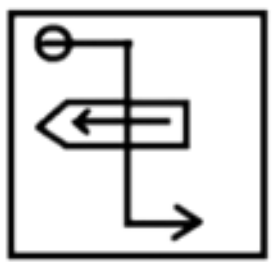

**Q.16.** Choose the mirror image of the given word if the mirror is placed to the right of the word.
SSC CPO 15/03/2019(Evening)

**BKUCL31**

(a) 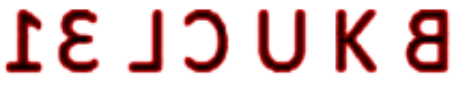
(b) 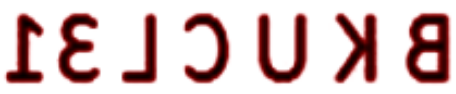

(c) 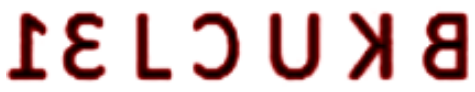

(d) 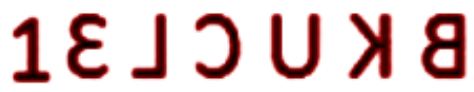

**Q.17.** Select the correct mirror image of the given figure, when the mirror is placed at the right side.
SSC CPO 16/03/2019(Morning)

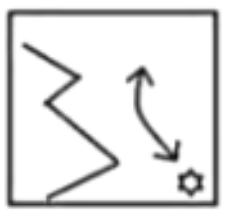

(a) 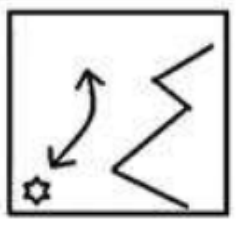

(b) 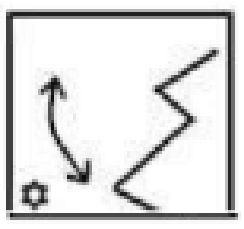

(c) 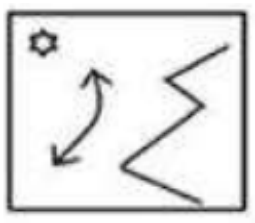

(d) 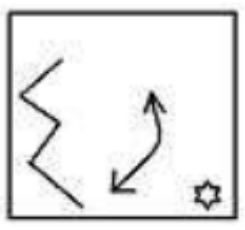

**Q.18.** Select the correct mirror image of the given image, when the mirror is placed at the right side.
SSC CPO 16/03/2019(Morning)

EFRI95uh

(a) 

(b) 

(c) 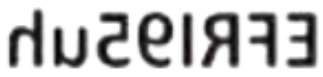

(d) 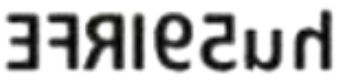

**Q.19.** Find the best possible mirror image of the given figure according to the position of the mirror.
SSC CPO 16/03/2019(Afternoon)



(a) 

(b) 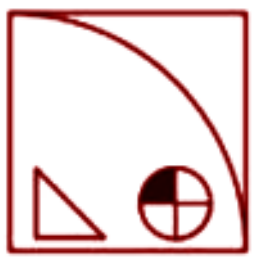

(c) 

(d) 

**Q.20.** Choose the mirror image of the given word if the mirror is placed to the right of the word.
SSC CPO 16/03/2019(Afternoon)

**MOUNTAIN**

(a) 

(b) **MOUNTAIN**

(c) 

(d) **NIATNUOM**

**Q.21.** Select the correct mirror image of the given figure when the mirror is placed on the right of the figure.
SSC CPO 16/03/2019(Evening)



(a) 

(b) 

(c) 

(d) 

**Q.22.** Select the correct mirror image of the given figure when the mirror is placed on the right of the figure.
SSC CPO 16/03/2019(Evening)



(a) 

(b) 

(c) 

(d) 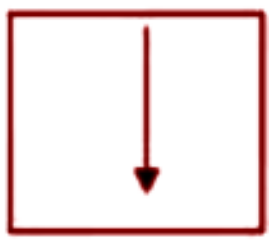

**SSC CGL 2018 Tier I**

**Q.23.** Select the correct mirror image of the given figure when the mirror is placed to the right of the figure.



SSC CGL 04/06/2019 (Morning)

(a) 

(b) 

(c) 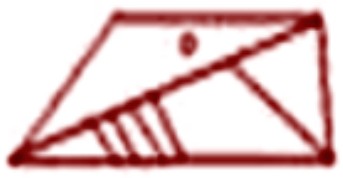

(d) 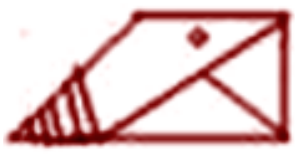

**Q.24.** Select the correct mirror image of the given figure when the mirror is placed to the right of the figure.



SSC CGL 04/06/2019 (Afternoon)

(a) 

(b) 

(c) 

(d) 

**Q.25.** Select the correct mirror image of the given figure when the mirror is placed to the right of the figure.

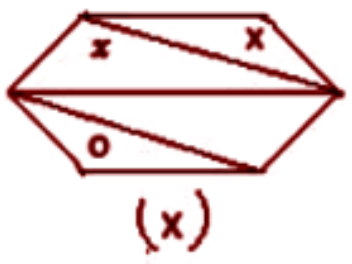

SSC CGL 04/06/2019 (Evening)

(a) 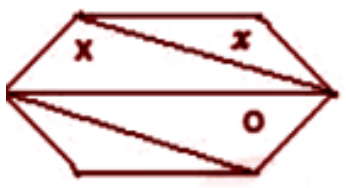

(b) 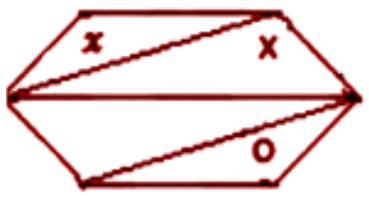

(c) 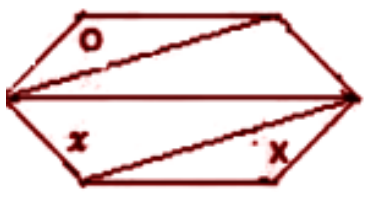

(d) 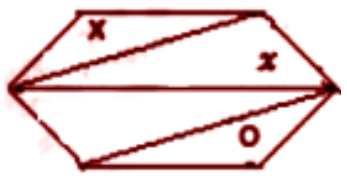

**Q.26.** Select the correct mirror image of the given figure when the mirror is placed to the right of the figure



SSC CGL 06/06/2019 (Morning)

(a) 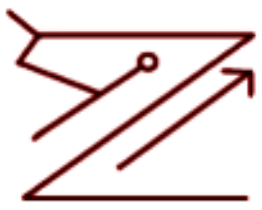

(b) 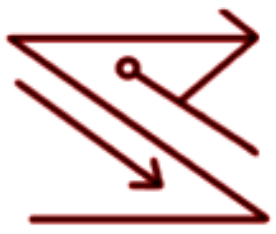

(c) 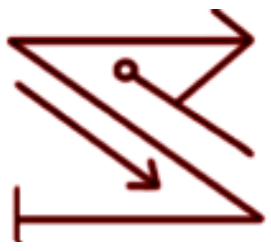

(d) 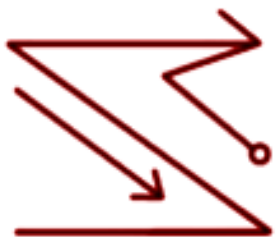

**Q.27.** Select the correct mirror image of the given figure when the mirror is placed to the right of the figure.

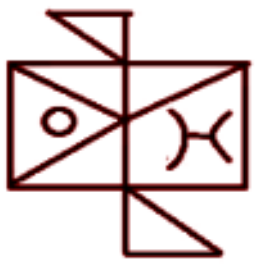

SSC CGL 06/06/2019 (Afternoon)

(a) 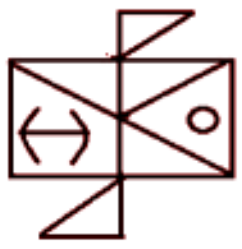

(b) 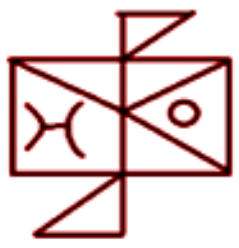

(c) 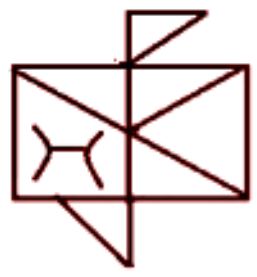

(d) 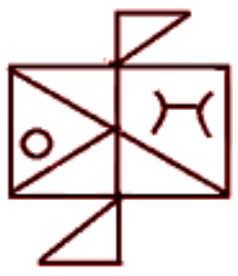

**Q.28.** Identify the mirror image of the following figure when a mirror is placed to the right of the figure.



SSC CGL 06/06/2019 (Evening)

(a) 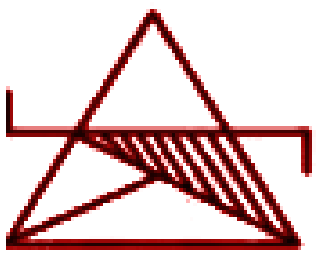

(b) 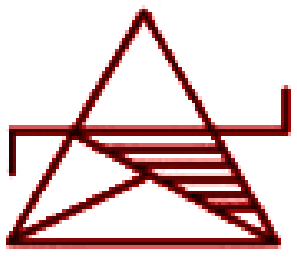

(c) 

(d) 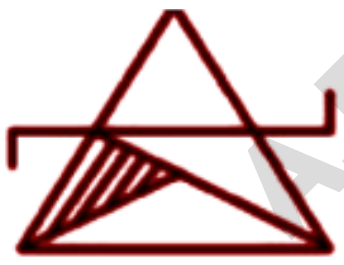

**Q.29.** Identify the mirror image of the following figure if the mirror is placed to the right of the figure.

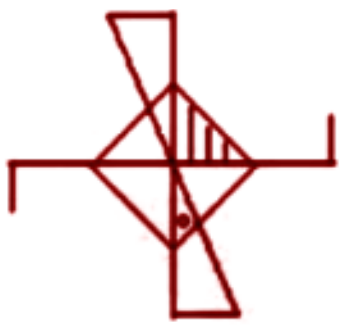

SSC CGL 07/06/2019 (Morning)

(a) 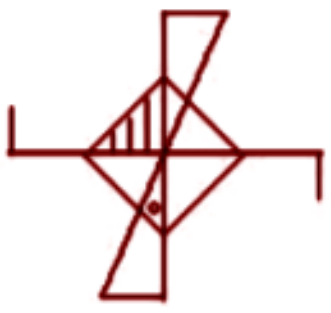

(b) 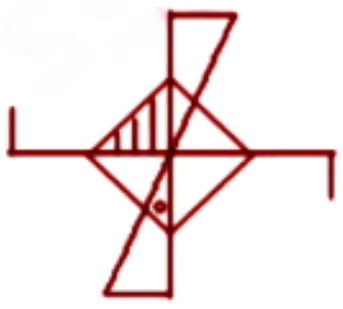

(c) 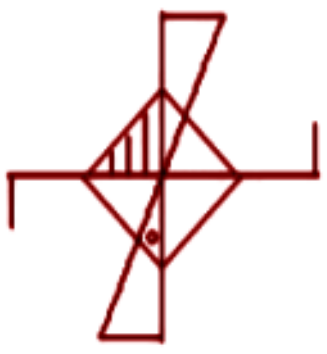

(d) 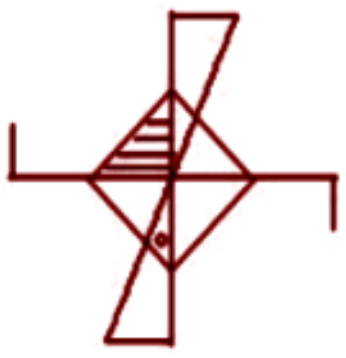

**Q.30.** Select the mirror image of the given figure when the mirror is placed on the right side of the figure.



SSC CGL 07/06/2019 (Afternoon)

(a) 

(b) 

(c) 

(d) 

**Q.31.** Select the mirror image of the given figure when the mirror is placed to the right of the figure.



SSC CGL 07/06/2019 (Evening)

(a) 

(b) 

(c) 

(d) 

**Q.32.** Select the mirror image of the given figure when the mirror is placed to the right of the figure.

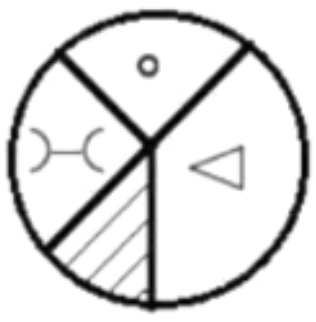

SSC CGL 10/06/2019 (Morning)

(a) 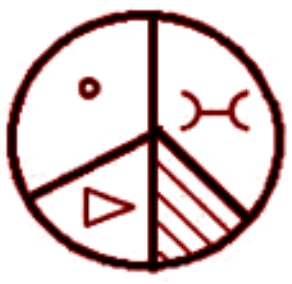

(b) 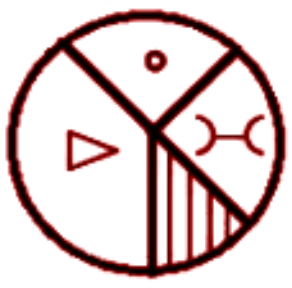

(c) 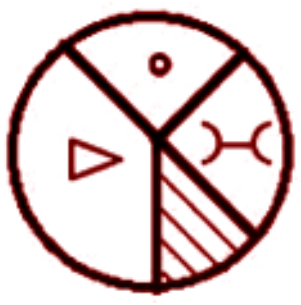

(d) 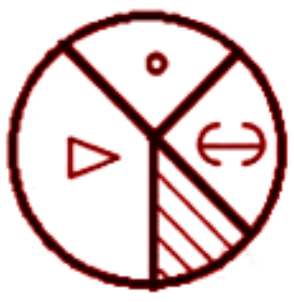

**Q.33.** Select the correct mirror image of the given figure when the mirror is placed to the right of the figure.

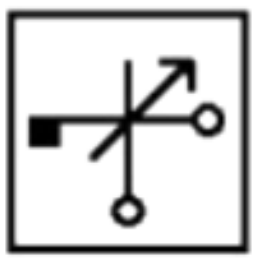

SSC CGL 10/06/2019 (Afternoon)

(a) 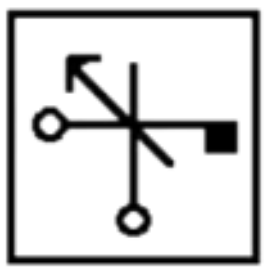

(b) 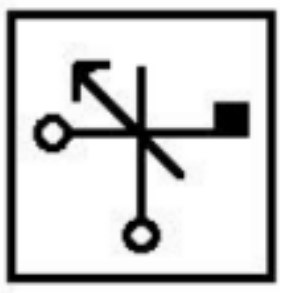

(c) 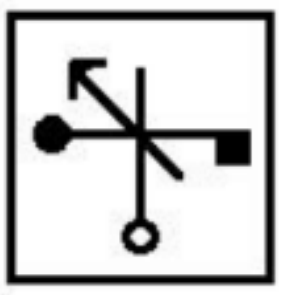

(d) 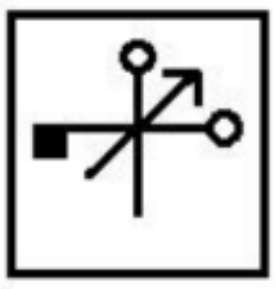

**Q.34.** Select the correct mirror image of the given figure when the mirror is placed to the right of the figure.

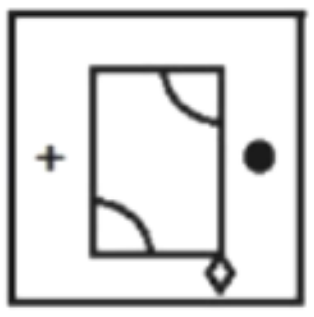

SSC CGL 10/06/2019 (Evening)

(a) 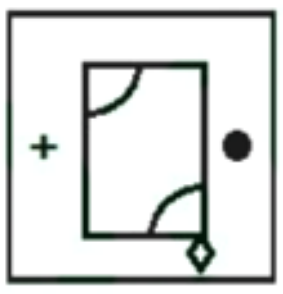

(b) 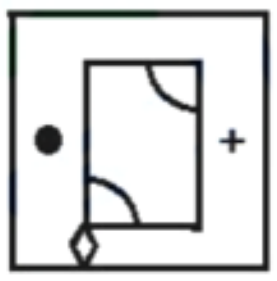

(c) 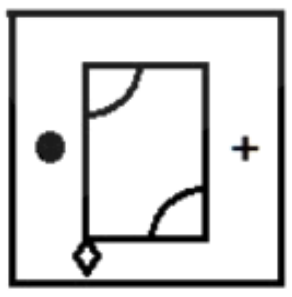

(d) 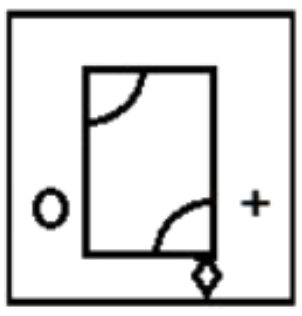

**Q.35.** Select the correct mirror image of the given figure when the mirror is placed to the right of the figure.

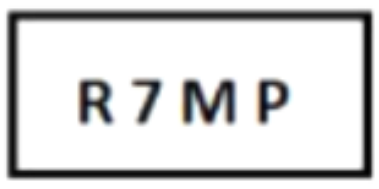

SSC CGL 11/06/2019 (Morning)

(a) 

(b) 

(c)  (d) 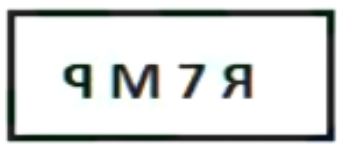

**Q.36.** Select the correct mirror image of the given figure when the mirror is placed to the right of the figure.



SSC CGL 11/06/2019 (Afternoon)

(a) 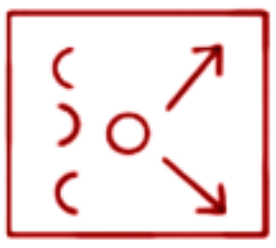 (b) 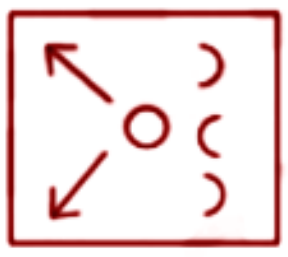

(c) 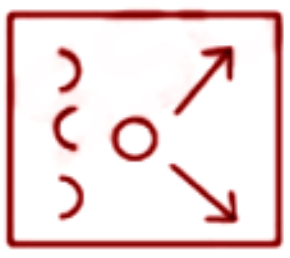 (d) 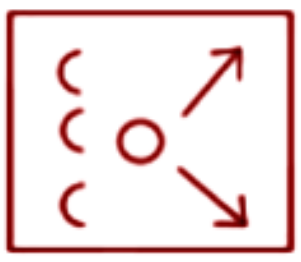

**Q.37.** Select the correct mirror image of the given figure when a vertical mirror is placed on the right of the figure.



SSC CGL 11/06/2019 (Evening)

(a)  (b) 

(c)  (d) 

**Q.38.** Select the correct mirror image of the given figure when the mirror is placed to the right of the figure.



SSC CGL 12/06/2019 (Morning)

(a)  (b) 

(c)  (d) 

**Q.39.** Select the correct mirror image of the given figure when the mirror is placed to the right of the figure.

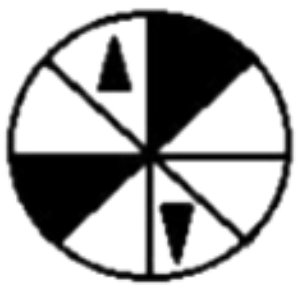

SSC CGL 12/06/2019 (Afternoon)

(a) 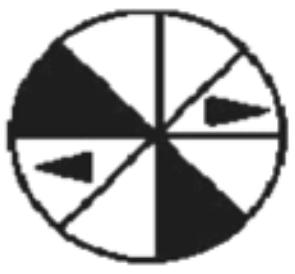 (b) 

(c)  (d) 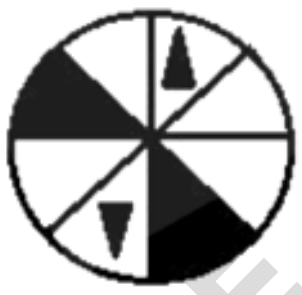

**Q.40.** Select the correct mirror image of the given figure when a vertical mirror is placed on the right of the figure.



SSC CGL 12/06/2019 (Evening)

(a)  (b) 

(c) 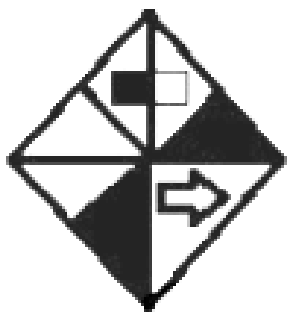 (d) 

**Q.41.** Select the correct mirror image of the given figure when the mirror is placed to the right of the figure.



SSC CGL 13/06/2019 (Morning)

(a)  (b) 

(c)  (d) 

**Q.42.** Select the correct mirror image of the given figure when the mirror is placed to the right of the figure.



SSC CGL 13/06/2019 (Afternoon)

(a)  (b) 

(c)  (d) 

**Q.43.** Select the correct mirror image of the following word when the mirror is placed to the right of the word.

**HINT**

SSC CGL 13/06/2019 (Evening)

(a) 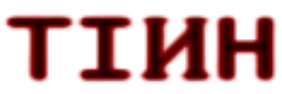

(b) 

(c) 

(d) 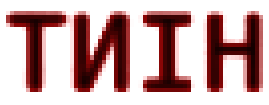

**SSC CHSL 2018 Tier I**

**Q.44.** Select the correct mirror image of the given figure when the mirror is placed to the right side of the figure.



SSC CHSL 01/07/2019 (Evening)

(a) 

(b) 

(c) 

(d) 

**Q.45.** Select the correct mirror image of the given figure when the mirror is placed to the right of the figure.



SSC CHSL 02/07/2019 (Morning)

(a) 

(b) 

(c) 

(d) 

**Q.46.** Select the correct mirror image of the given figure when the mirror is placed to the right of the figure.



SSC CHSL 02/07/2019 (Afternoon)

(a) 

(b) 

(c) 

(d) 

**Q.47.** Select the correct mirror image of the given figure when the mirror is placed to the right of the figure.

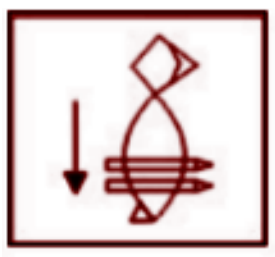

SSC CHSL 02/07/2019 (Evening)

(a) 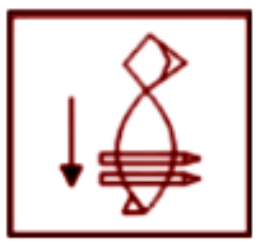

(b) 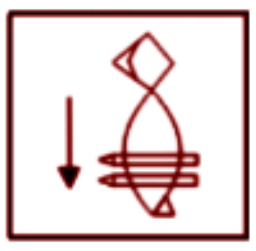

(c) 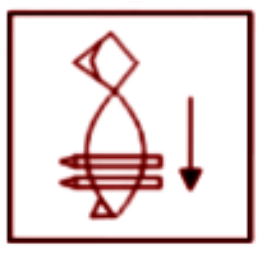

(d) 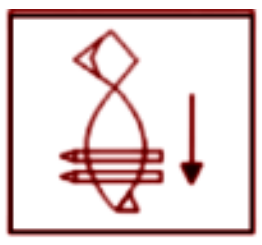

**Q.48.** Select the correct mirror image of the given figure when the mirror is placed to the right of the figure.



SSC CHSL 03/07/2019 (Morning)

(a) 

(b) 

(c) 

(d) 

**Q.49.** Select the correct mirror image of the given combination when the mirror is placed to the right.

RGYbsQ791

SSC CHSL 03/07/2019 (Afternoon )

(a) 

(b) 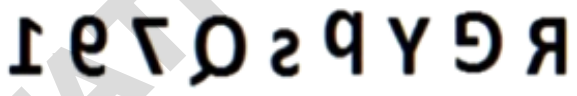

(c) 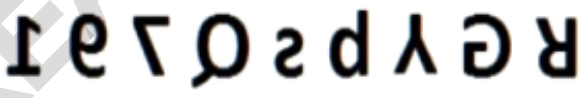

(d) 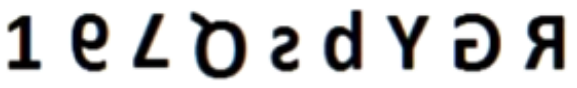

**Q.50.** Select the option that depicts how the given transparent sheet of paper would appear if it is folded at the dotted line?



SSC CHSL 03/07/2019 (Evening )

(a) 

(b) 

(c) 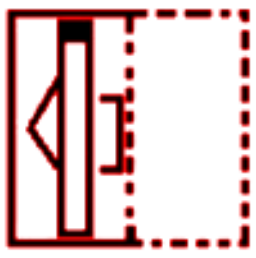

(d) 

**Q.51.** Select the correct mirror image of the given combination when the mirror is placed to the right of the figure.

UKR4edm8

SSC CHSL 03/07/2019 (Evening )

(a) 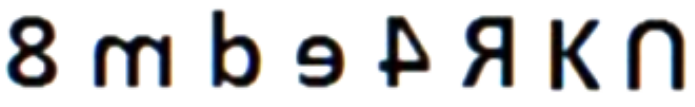

(b) 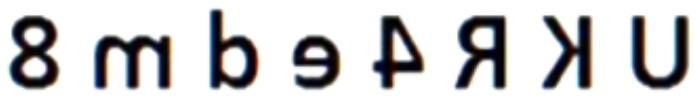

(c) 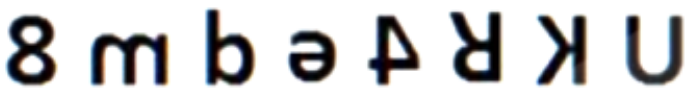

(d) 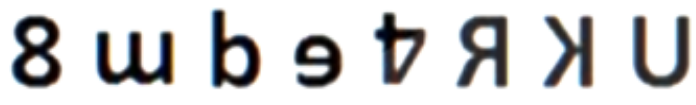

**Q.52.** Select the correct mirror image of the given when the mirror is placed to the right of the figure.

BVCZ21Qf

SSC CHSL 04/07/2019 ( Morning )

(a) 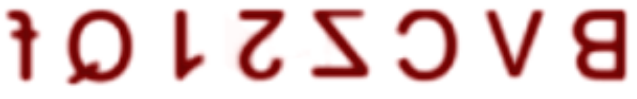

(b) 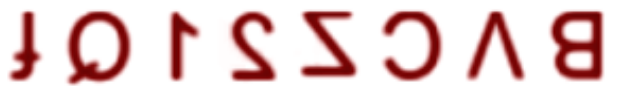

(c) 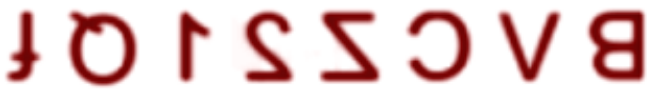

(d) 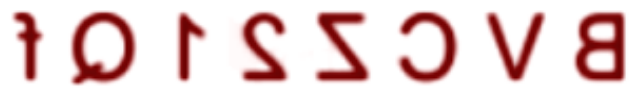

**Q.53.** Select the correct mirror image of the given figure when the mirror is placed to the right of the figure.

YRedf875

SSC CHSL 04/07/2019 ( Afternoon )

(a) 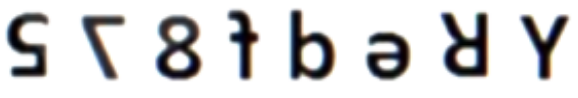

(b) 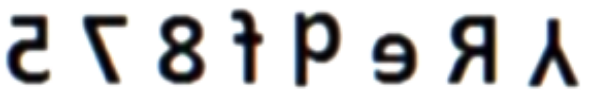

(c) 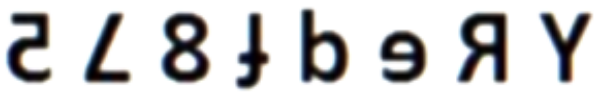

(d) 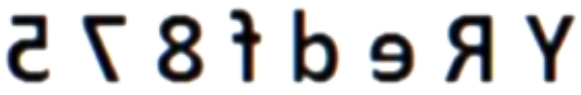

**Q.54.** Select the correct mirror image of the given figure when the mirror is placed to the right of the figure.

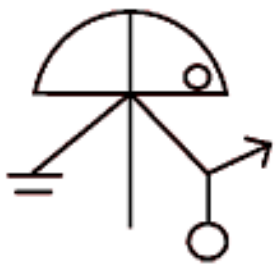

SSC CHSL 04/ 07/2019 (Evening)

(a) 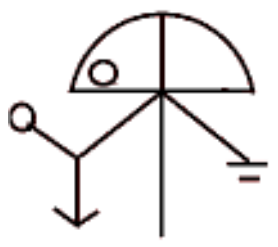 (b) 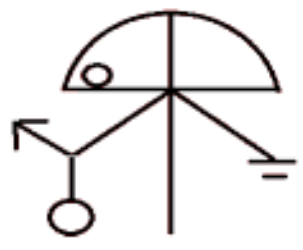

(c) 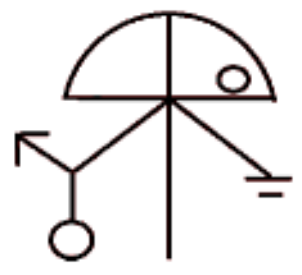 (d) 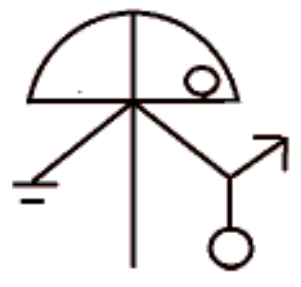

**Q.55.** Select the correct mirror image of the given figure when the mirror is placed to the right of the figure.

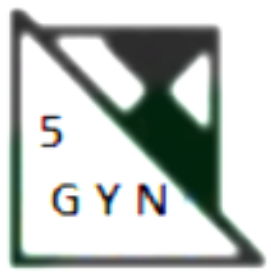

SSC CHSL 05/07/2019 (Morning )

(a)  (b) 

(c)  (d) 

**Q.56.** Select the correct mirror image of the given figure when the mirror is placed to the right of the figure.

54rgBG9Q6

SSC CHSL 05/07/2019 ( afternoon )

(a) 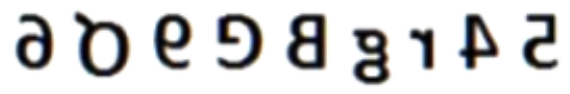

(b) 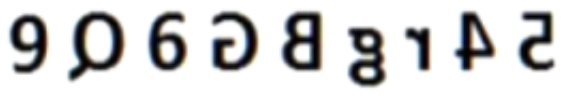

(c) 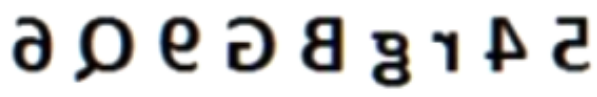

(d) 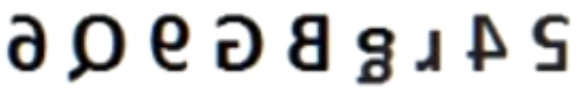

**Q.57.** Select the correct mirror image of the given figure when the mirror is placed to the right of the figure.

4RF893Zfk2

SSC CHSL 05/07/2019 ( Evening )

(a) 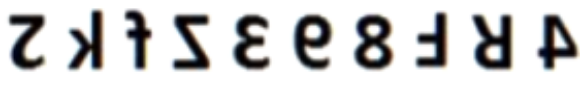

(b) 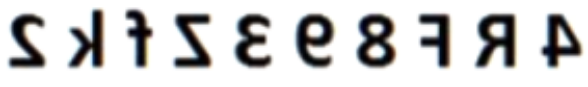

(c) 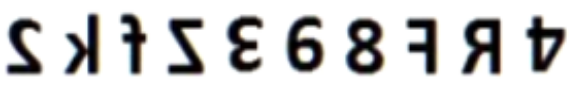

(d) 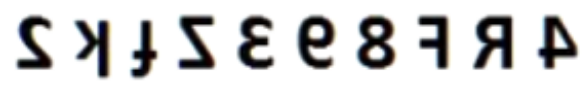

**Q.58.** Select the correct mirror image of the given figure when the right of the figure.

GJ753fgQ

SSC CHSL 08/07/2019 ( Morning )

(a) 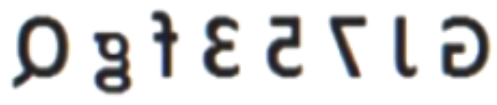

(b) 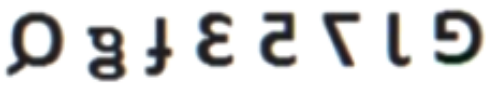

(c) 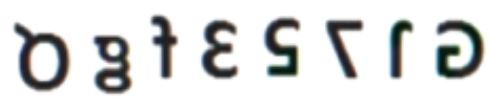

(d) 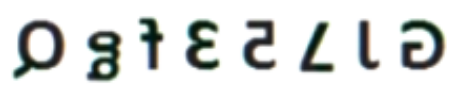

**Q.59.** Select the correct mirror image of the given figure when the mirror is placed to the right of the figure.

64EKPC92

SSC CHSL 08/07/2019 ( Afternoon )

(a) 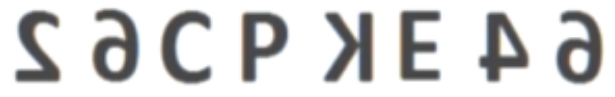

(b) 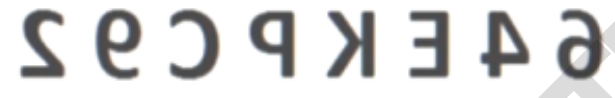

(c) 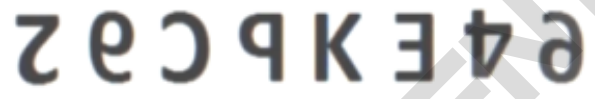

(d) 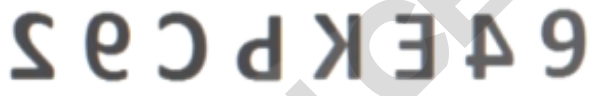

**Q.60.** Select the correct mirror image of the given figure when the mirror is placed to the right of the figure.

BfDeY532

SSC CHSL 08/07/2019 ( Evening )

(a) 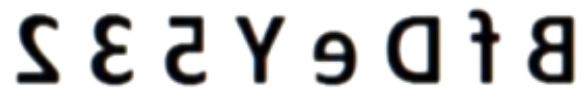

(b) 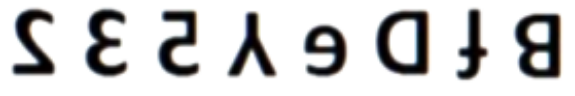

(c) 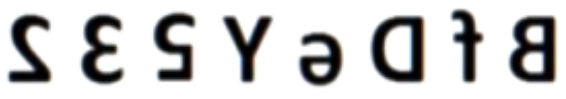

(d) 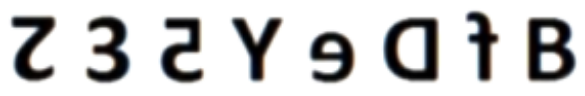

**Q.61.** Select the correct mirror image of the given figure when the mirror is placed to the right of the figure.

GJL71pfm

SSC CHSL 09/07/2019 ( Morning )

(a) 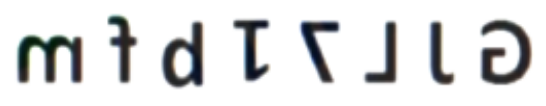

(b) 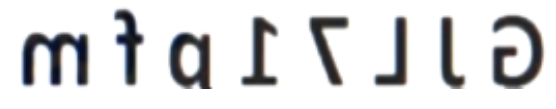

(c) 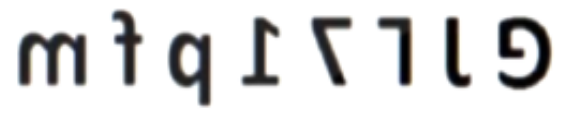

(d) 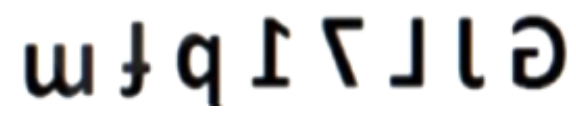

**Q.62.** Select the correct mirror image of the given figure when the mirror is placed to the right of the figure.



SSC CHSL 09/07/2019 (Afternoon)

(a) 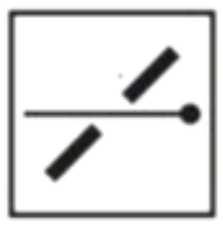 (b) 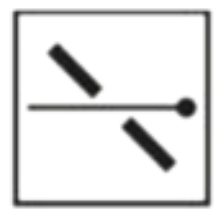

(c) 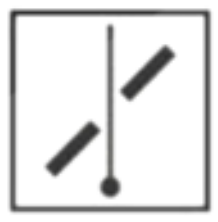 (d) 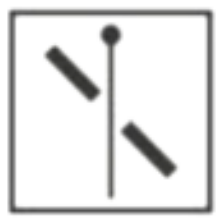

**Q.63.** Select the correct mirror image of the given figure when the mirror is placed at the bottom of the figure.

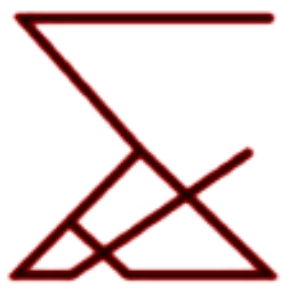

SSC CHSL 09/07/2019 ( Evening )

(a)  (b) 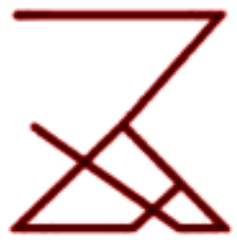

(c)  (d) 

**Q.64.** Select the correct mirror image of the given figure when the mirror is placed to the right of the figure?

A5TP

SSC CHSL 10/07/2019 (Morning)

(a) 

(b) 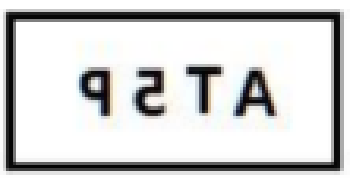

(c) 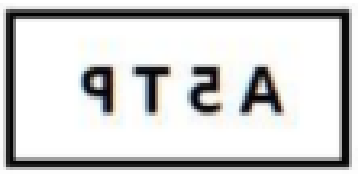

(d) 

**Q.65.** Select the correct mirror image of the given figure when the mirror is placed to the left of the figure?



SSC CHSL 10/07/2019 (Afternoon)

(a)


(b)


(c)


(d)


**Q.66**. Select the correct mirror image of the given figure when the mirror is placed to the right of the figure?



SSC CHSL 10/07/2019 ( Evening)

(a)


(b)


(c)


(d)


**Q.67**. Select the correct mirror image of the given figure when the mirror is placed to the right of the figure?



SSC CHSL 11/07/2019 ( Morning)

(a)


(b)


(c)


(d)


**Q.68.** Select the correct mirror image of the given figure when the mirror is placed to the left of the figure.



SSC CHSL 11/07/2019 ( Afternoon )

(a)


(b)


(c)


(d)
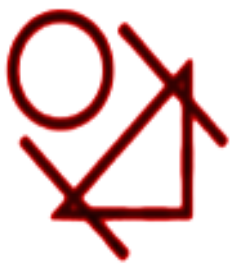

**Q.69** Select the correct mirror image of the given figure when the mirror is placed to the right of the figure.



SSC CHSL 11/07/2019 ( Evening )

(a)


(b)


(c)


(d)


## SSC MTS 2019 Tier I

**Q.70.** Select the correct mirror image of the given figure when the mirror is placed at line AB.

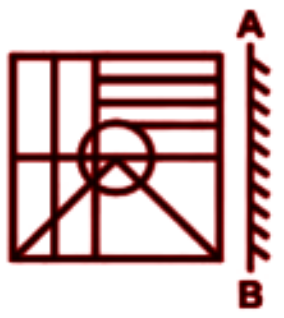

SSC MTS 02/08/2019 (Morning)

(a)
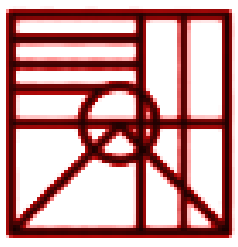

(b)
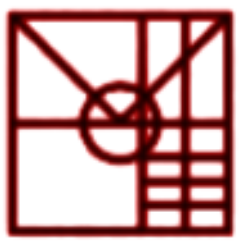

(c)


(d)
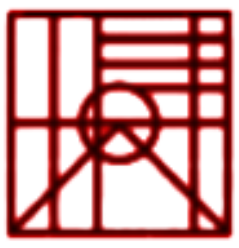

**Q.71.** Select the correct mirror image of the given figure when the mirror is placed at line AB.

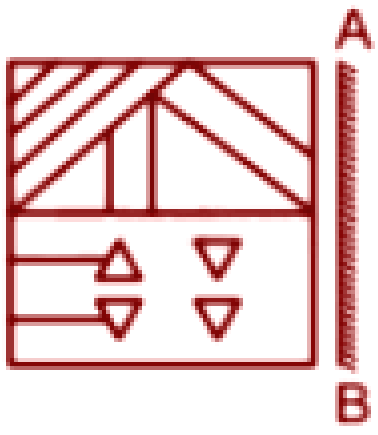

SSC MTS 02/08/2019 (Afternoon)

(a)


(b)


(c)


(d)


**Q.72.** Select the correct mirror image of the given figure when the mirror is placed at line AB.

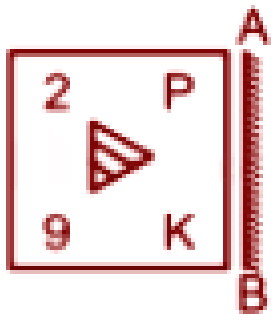

SSC MTS 02/08/2019 (Evening)

(a)


(b)


(c)


(d)


**Q.73.** Select the correct mirror image of the given figure when the mirror is placed at line AB.



SSC MTS 05/08/2019 (Morning)

(a) 

(b) 

(c) 

(d) 

**Q.74.** Select the correct mirror image of the given figure when the mirror is placed at line AB.

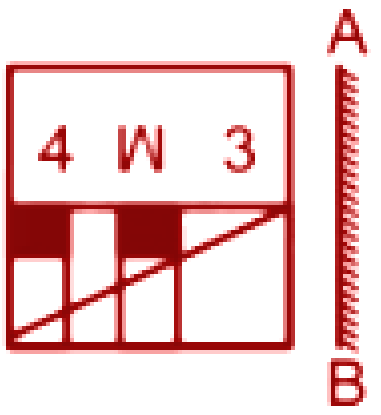

SSC MTS 05/08/2019 (Afternoon)

(a) 

(b) 

(c) 

(d) 

**Q.75.** Select the correct mirror image of the given figure when the mirror is placed at line AB.



SSC MTS 05/08/2019 (Evening)

(a) 

(b) 

(c) 

(d) 

**Q.76.** If a mirror is placed on the line AB, then which of the answer figures is the right image of the given figure?

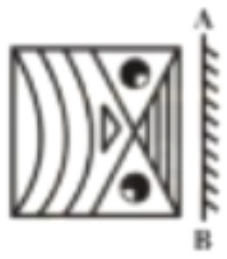

SSC MTS 06/08/2019 (Morning)

(a) 

(b) 

(c) 

(d) 

**Q.77.** IF a mirror is placed on the line AM,then which of the answer figures is the right image of the given figure?



SSC MTS 06/08/2019 (Afternoon)

(a) 

(b) 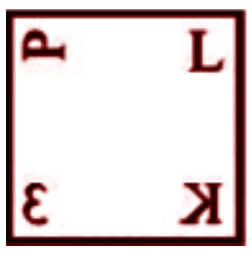

(c) 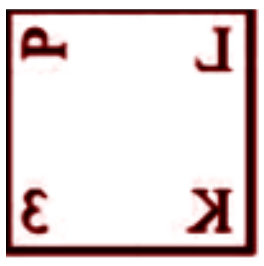

(d) 

**Q.78.** Select the correct mirror image of the given figure when the mirror is placed at line AB.

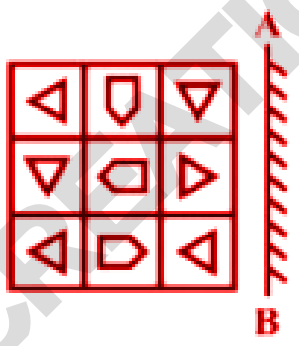

SSC MTS 06/08/2019 (Evening)

(a) 

(b) 

(c) 

(d) 

**Q.79.** Select the correct mirror image of the given figure when the mirror is placed at line AB



SSC MTS 07/08/2019 (Morning)

(a) 

(b) 

(c) 

(d) 

**Q.80.** Select the correct mirror image of the given figure when the mirror is placed at line AB.



SSC MTS 07/08/2019 (Afternoon)

(a) 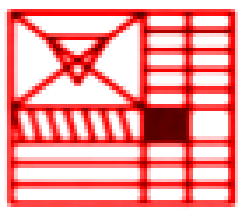

(b) 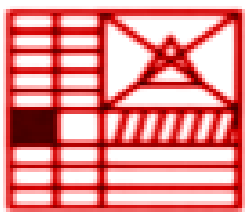

(c) 

(d) 

**Q.81.** Select the correct mirror image of the given figure when the mirror is placed at line AB.



SSC MTS 07/08/2019 (Evening)

(a) 

(b) 

(c) 

(d) 

**Q.82.** Select the correct mirror image of the given figure when the mirror is placed at line AB.

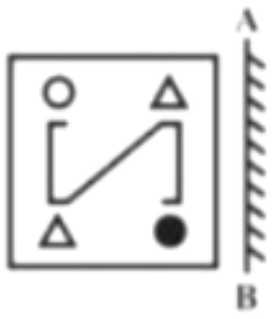

SSC MTS 08/08/2019 (Morning)

(a) 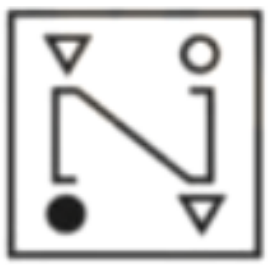

(b) 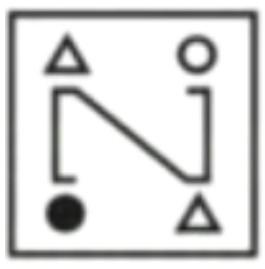

(c) 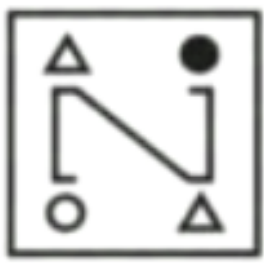

(d) 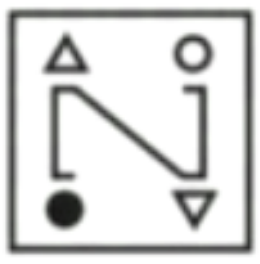

**Q.83.** Select the correct mirror image of the given figure when the mirror is placed at line AB.



SSC MTS 08/08/2019 (Afternoon)

(a) 

(b) 

(c) 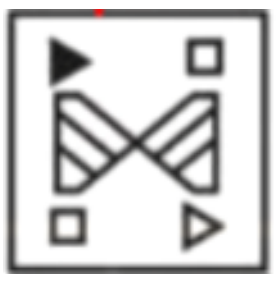

(d) 

**Q.84.** Select the correct mirror image of the given figure when the mirror is placed at line AB.



SSC MTS 08/08/2019 (Evening)

(a) 

(b) 

(c) 

(d) 

**Q.85.** Select the correct mirror image of the given figure when the mirror is placed at line AB.

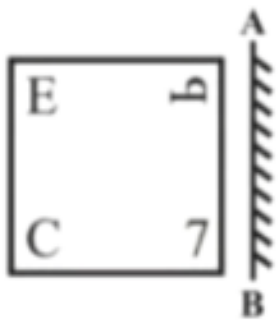

SSC MTS 09/08/2019 (Morning)

(a) 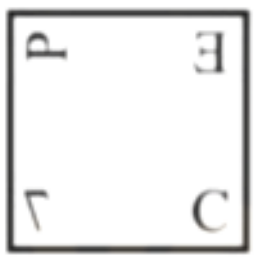

(b) 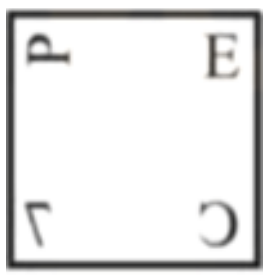

(c) 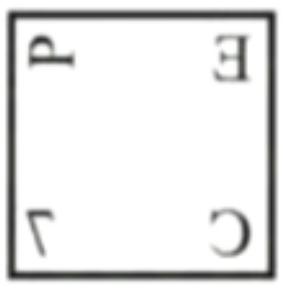

(d) 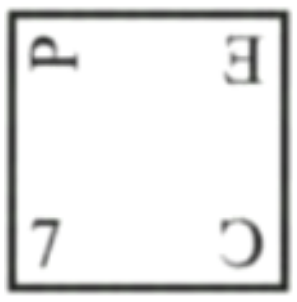

**Q.86.** Select the correct mirror image of the given figure when the mirror is placed at line AB.

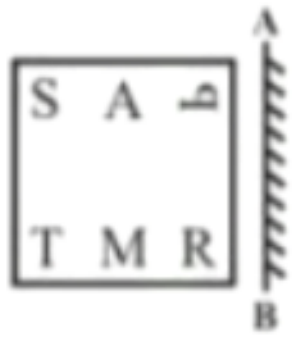

SSC MTS 09/08/2019 (Afternoon)

(a) 

(b) 

(c) 

(d) 

**Q.87.** If a mirror is placed on the line AB, then which of the answer figures is the right image of the given figure?

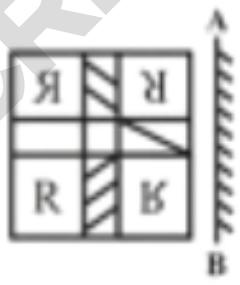

SSC MTS 09/08/2019 (Evening)

(a) 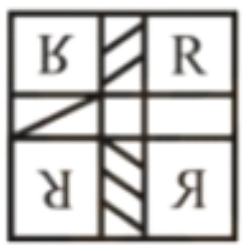

(b) 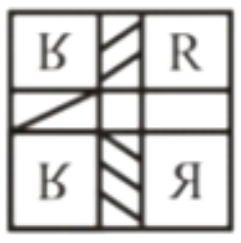

(c) 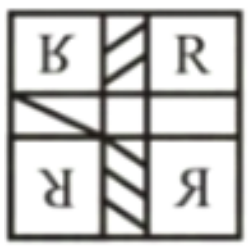

(d) 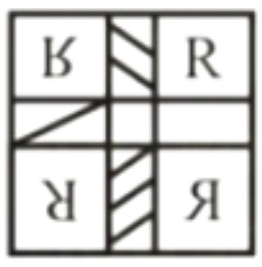

**Q.88.** Choose the option that most closely resembles the mirror image of the given figure when the mirror is placed at the right side.



SSC MTS 13/08/2019 (Morning)

(a) 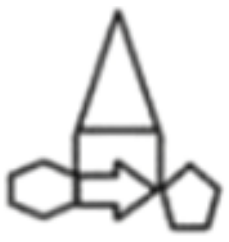

(b) 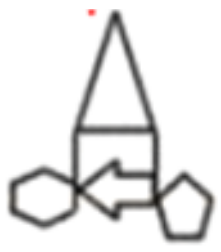

(c) 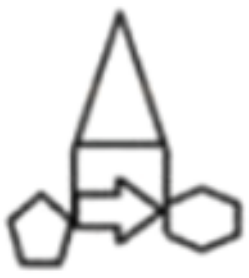

(d) 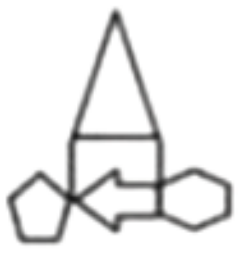

**Q.89.** Select the correct mirror image of the given figure when the mirror is placed to the right of the figure.



SSC MTS 13/08/2019 (Afternoon)

(a) 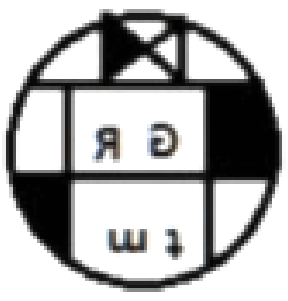

(b) 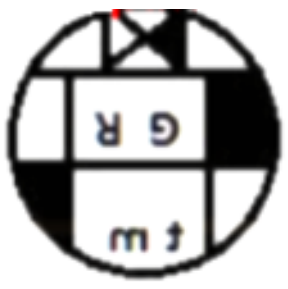

(c) 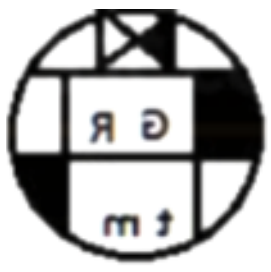

(d) 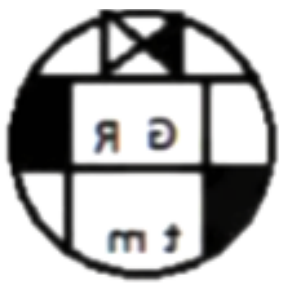

**Q.90.** Select the correct mirror image of the given letter-number cluster when the mirror is placed below the cluster.

**R Y 9 4 k m S**

SSC MTS 13/08/2019 (Evening)

(a) 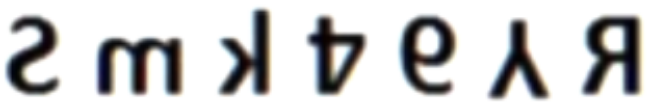

(b) 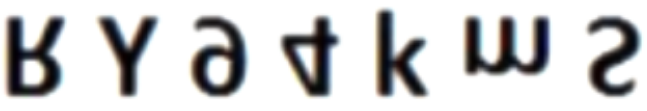

(c) 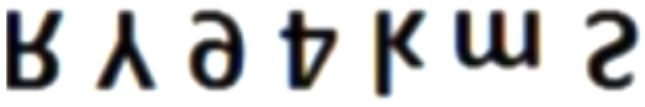

(d) 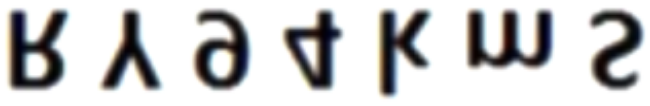

**Q.91.** Select the correct mirror image of the given figure when the mirror is placed to the right side of the figure.



SSC MTS 14/08/2019 (Morning)

(a)


(b)


(c)


(d)


**Q.92.** Select the correct mirror image of the given figure when the mirror is placed to the right of the figure.

642hn3K

SSC MTS 14/08/2019 (Afternoon)

(a)
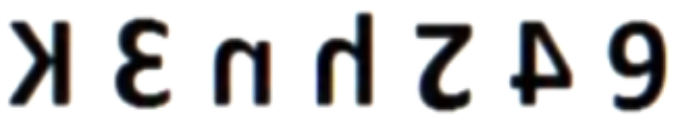

(b)
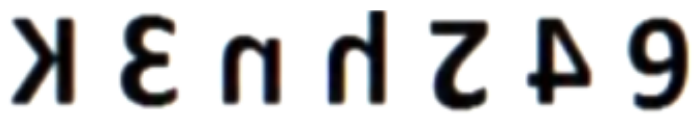

(c)
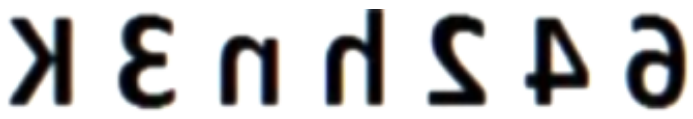

(d)
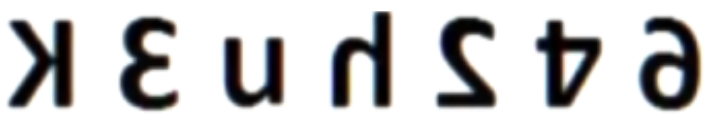

**Q.93.** Select the correct mirror image of the given letter-number cluster when the mirror is placed at the right side of the cluster.

RGftBQZ54

SSC MTS 14/08/2019 (Evening)

(a)
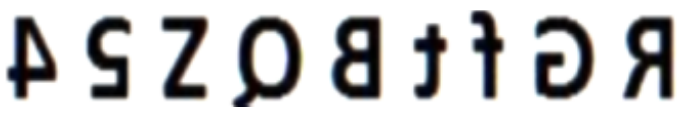

(b)
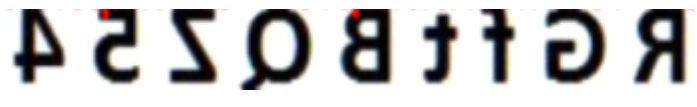

(c)
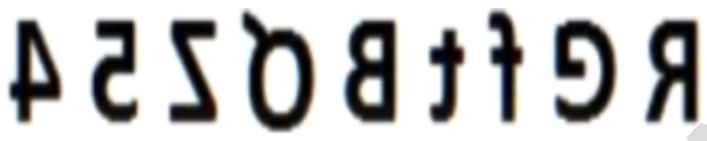

(d)
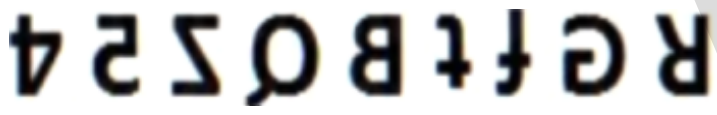

**Q.94.** Select the correct mirror image of the given figure when the mirror is placed at line AB.



SSC MTS 16/08/2019 (Morning)

(a)


(b)


(c)


(d)


**Q.95.** If a mirror is placed on the line AB, then which of the answer figures of the right image of the given figure?

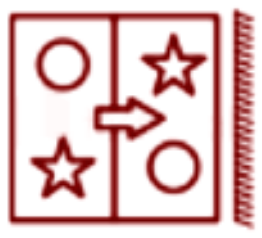

SSC MTS 16/08/2019 (Afternoon)

(a)


(b)


(c)


(d)


**Q.96.** Choose the option that most closely resembles the mirror image of the given figure when the mirror is placed at the right side.

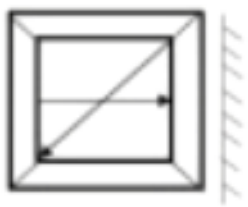

SSC MTS 16/08/2019 (Evening)

(a)
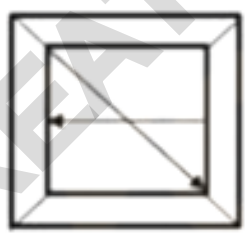

(b)
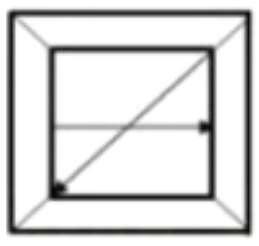

(c)
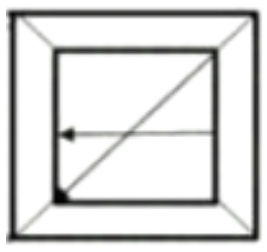

(d)
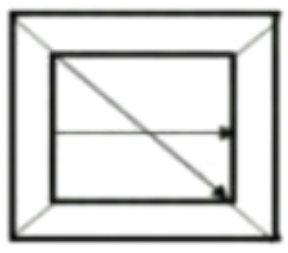

**Q.97.** Select the correct mirror image of the given figure when the mirror is placed at the right side of the given figure.



SSC MTS 19/08/2019 (Morning)

(a)
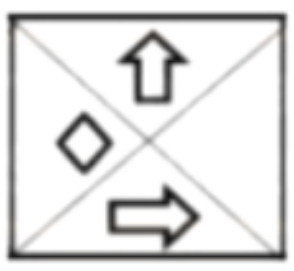

(b)
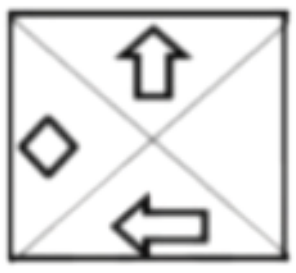

(c)


(d)
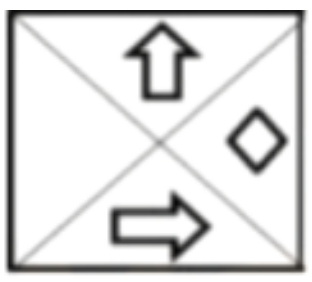

**Q.98.** Choose the option that most closely resembles the mirror image of the given image when mirror is place along the image as shown below.

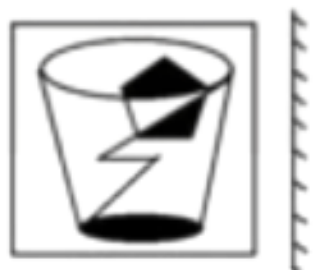

SSC MTS 19/08/2019 (Afternoon)

(a)


(b)


(c)


(d)


**Q.99.** If a mirror is placed on the line XY, then which of the answer figures will be the right mirror image of the given figure?



SSC MTS 19/08/2019 (Evening)

(a)


(b)


(c)


(d)
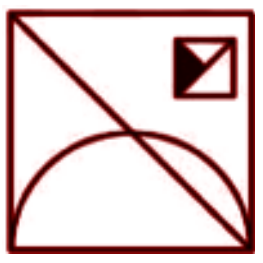

**Q.100.** If a mirror is placed on the line XY, then which of the answer figures will be right mirror image of the given figure?

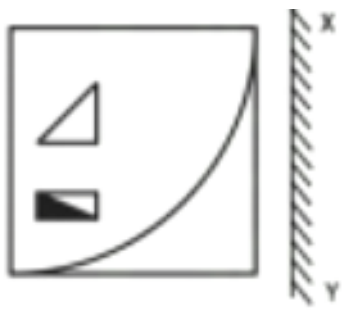

SSC MTS 20/08/2019 (Morning)

(a) 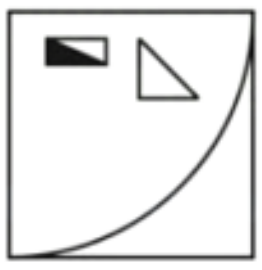
(b) 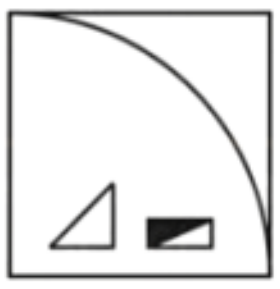
(c) 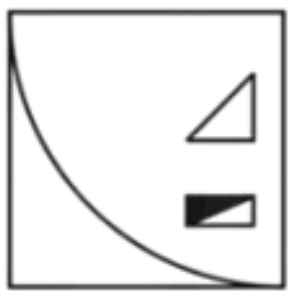
(d) 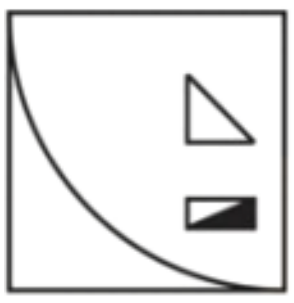

**Q.101.** Choose the option that most closely resembles the mirror image of the given figure when the mirror is placed at the right side.

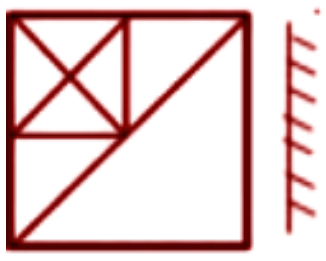

SSC MTS 20/08/2019 (Afternoon)

(a) 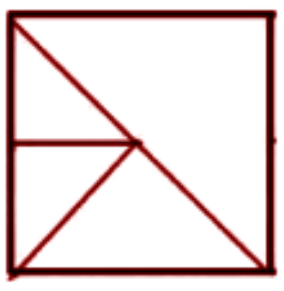
(b) 
(c) 
(d) 

**Q.102.** Choose the option that most closely matches the mirror image of the given figure when the mirror is placed at the right side.

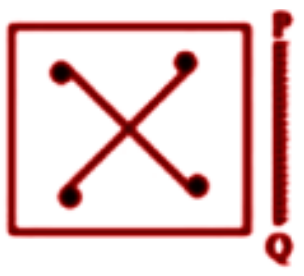

SSC MTS 20/08/2019 (Evening)

(a) 
(b) 
(c) 
(d) 

**Q.103.** If a mirror is placed on the line XY, then which of the answer figures will be the right mirror image of the given figure?

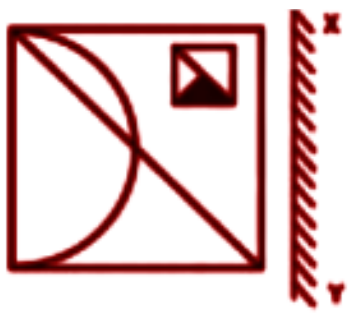

SSC MTS 21/08/2019 (Morning)

(a) 
(b) 
(c) 
(d) 

**Q.104.** If a mirror is placed on the line XY, which of the answer figures will be the right mirror image of the given figure?



SSC MTS 21/08/2019 (Afternoon)

(a) 
(b) 
(c) 
(d) 

**Q.105.** Choose the alternative which most closely resembles the water image of the given figure.

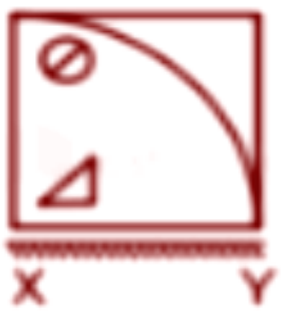

SSC MTS 21/08/2019 (Evening)

(a) 
(b) 
(c) 
(d) 

**Q.106.**. Choose the option that most closely resembles the mirror image of the given figure when mirror is placed at right side.



SSC MTS 22/08/2019 (Morning)

(a) 
(b) 
(c) 
(d) 

**Q.107.** If a mirror is placed on the line XY, then which of the answer figures will be the right mirror image of the given figure?



SSC MTS 22/08/2019 (Afternoon)

(a) 
(b) 
(c) 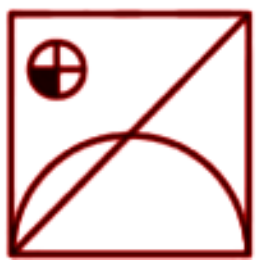
(d) 

**Q.108.** If a mirror is placed on the line XY. then which of the answer figures will be the right mirror image of the given figure?



SSC MTS 22/08/2019 (Evening)

(a) 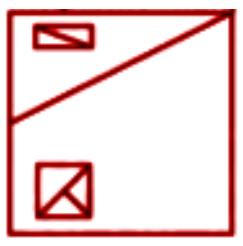
(b) 
(c) 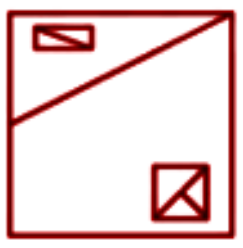
(d) 

## SSC CPO 2019 Tier I

**Q.109.** Which of the option figures is the exact mirror image of the given problem figure when the mirror is held to the right side of the problem figure?

**ALPha797charLIE**

SSC CPO 09/12/2019 (Morning)

(a) 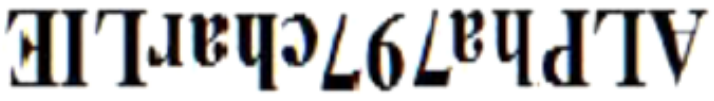

(b) 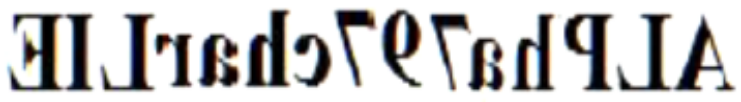

(c) 

(d) 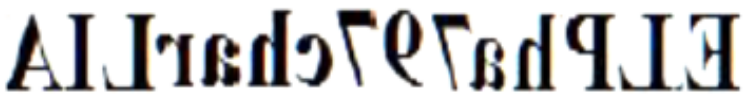

**Q.110.** Which of the option figures is the exact mirror image of the given problem figure when the mirror is held to the right side of the problem figure?



SSC CPO 09/12/2019 (Morning)

(a) 

(b) 

(c) 

(d) 

**Q.111.** Select the option that most closely resembles the mirror image of the given figure, when the mirror is placed to the right side of the figure.

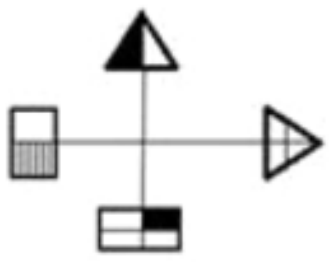

SSC CPO 09/12/2019 (Evening)

(a) 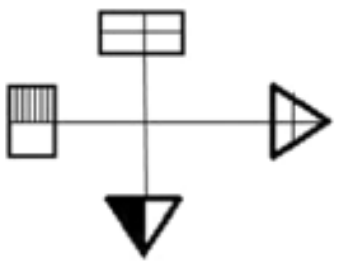

(b) 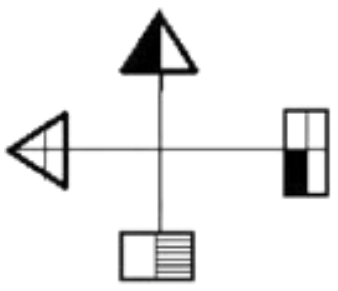

(c) 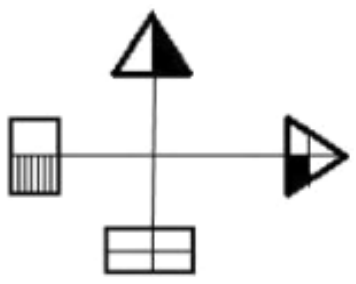

(d) 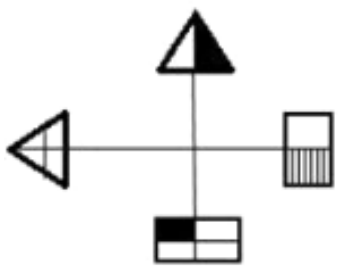

**Q.112.** Select the option that most closely resembles the mirror image of the given figure, when the mirror is placed to the right side of the figure.



SSC CPO 09/12/2019 (Evening)

(a) 

(b) 

(c) 

(d) 

**Q.113.** Which of the option figures is the exact image of the given problem figure when the mirror is held to the right side of the problem figure ?

Problem Figure:



SSC CPO 11/12/2019 (Morning)

(a) 

(b) 

(c) 

(d) 

**Q.114.** Which of the option figures is the exact mirror image of the given problem figure when the mirror is held on the right side of the problem figure ?

Problem Figure :

**Cc479LJyRST**

SSC CPO 11/12/2019 (Morning)

(a) 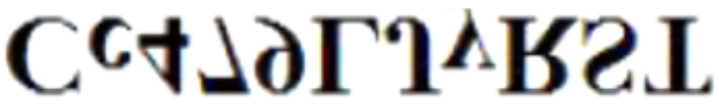

(b) 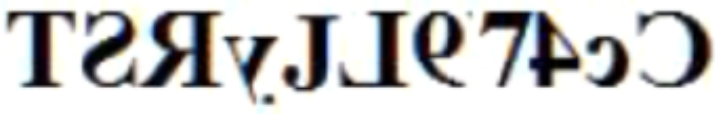

(c) 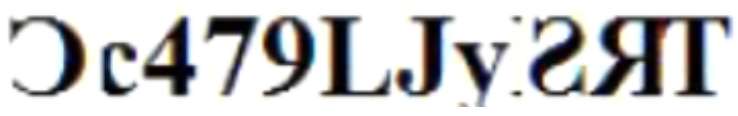

(d) 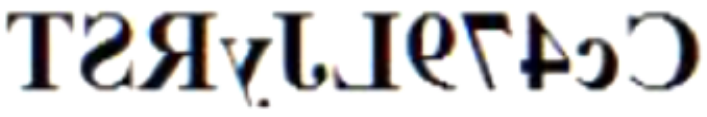

**Q.115.** Which of the options is the exact mirror image of the given figure when the mirror is held at the right side?

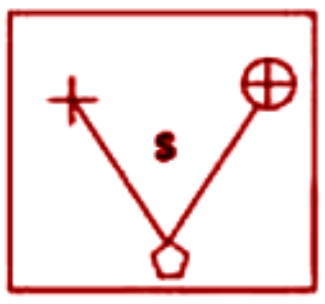

SSC CPO 11/12/2019 (Evening)

(a) 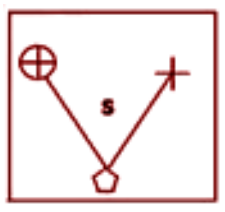

(b) 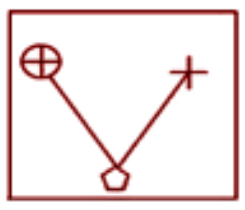

(c) 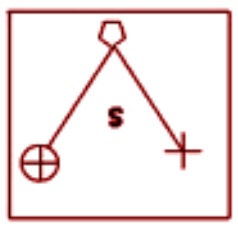

(d) 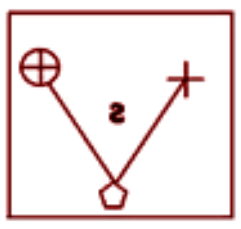

**Q.116.** Which of the options is the exact mirror image of the given figure when the mirror is held at the right side?

**jsVR72k59moPG**

SSC CPO 11/12/2019 (Evening)

(a) 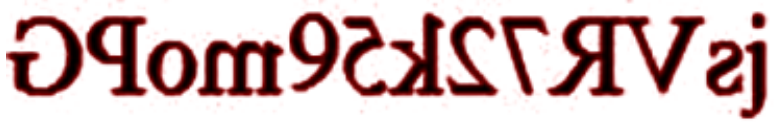

(b) 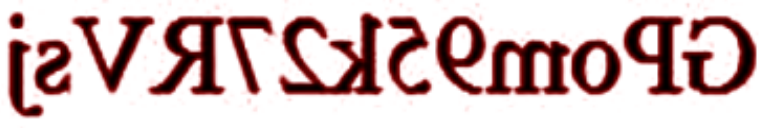

(c) 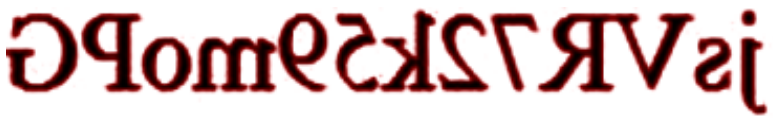

(d) 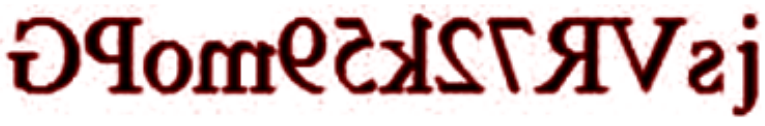

**Q.117.** Which of the option figures is the exact mirror image of the given problem figure when the mirror is held to the right side of the problem figure?

Problem Figure :

LVN35ER24

SSC CPO 12/12/2019 (Morning)

(a) 

(b) 

(c) 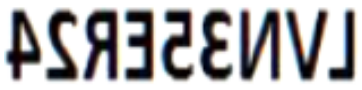

(d) 

**Q.118.** Which of the option figures is the exact mirror image of the given problem when the mirror is held to the right side of the problem figure?

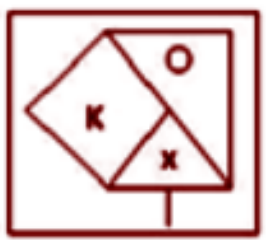

SSC CPO 12/12/2019 (Morning)

(a) 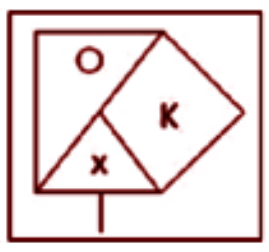

(b) 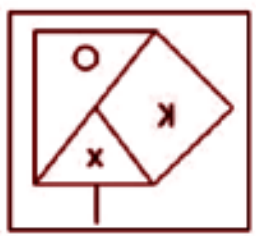

(c) 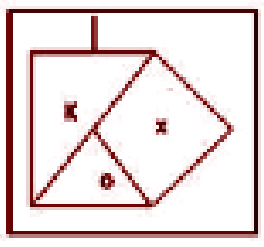

(d) 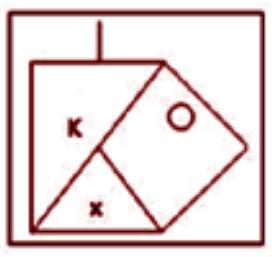

**Q.119.** Which of the options is the exact mirror image of the given figure when the mirror is held at the right side?

BZF3Q12AW

SSC CPO 12/12/2019 (Evening)

(a) 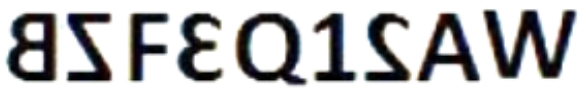

(b) 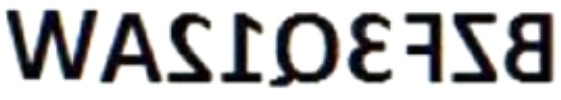

(c) 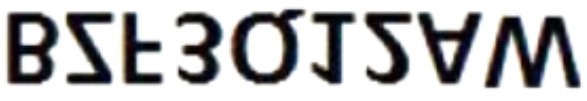

(d) 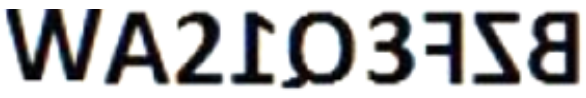

**Q.120.** Which of the options is the exact mirror image of the given figure when the mirror is held at the right side?



SSC CPO 12/12/2019 (Evening)

(a) 

(b) 

(c) 

(d) 

**Q.121.** Select the correct mirror image of the given combination when the mirror is held at the right side.

JKWM691F

SSC CPO 13/12/2019 (Morning)

(a) 

(b) 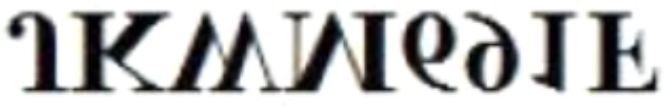

(c) 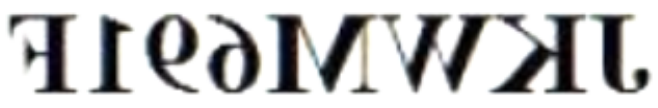

(d) 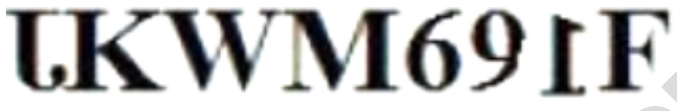

**Q.122.** Select the answer figure that is the correct mirror image of the given figure when the mirror is held at the right side.

**Figure:**



**Answer Figure:**



SSC CPO 13/12/2019 (Morning)

(a) B (b) C (c) A (d) D

**Q.123.** Select the correct mirror image of the given figure when the mirror is held at the right side.



SSC CPO 13/12/2019 (Evening)

(a) 

(b) 

(c) 

(d) 

**Q.124.** Select the correct mirror image of the given combination when the mirror is held at the right side.



SSC CPO 13/12/2019 (Evening)

(a) 

(b) 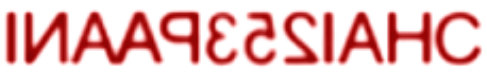

(c) 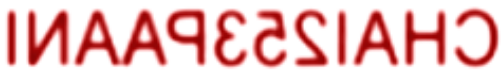

(d) 

### SSC CGL 2019 Tier I

**Q.125.** Which of the option figures is the exact mirror image of the given figure when the mirror is held at the right side ?
SSC CGL 03/03/2020 (Morning)

RST2PK9LOX

(a) 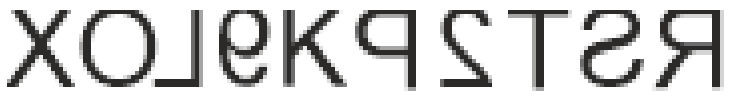

(b) 

(c) 

(d) 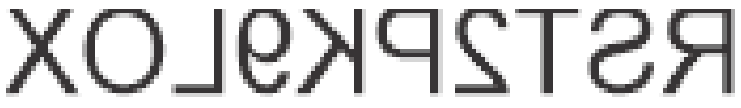

**Q.126.** Select the correct mirror image of the given figure when the mirror is placed on the right of the figure.
SSC CGL 03/03/2020 (Afternoon)

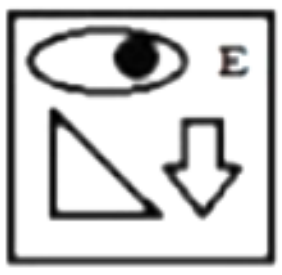

(a) 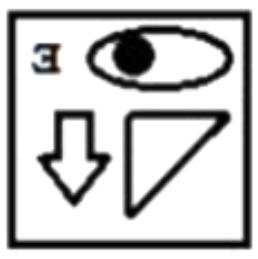

(b) 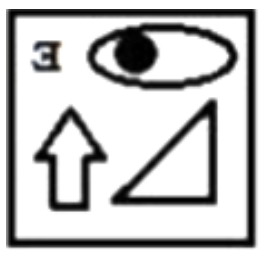

(c) 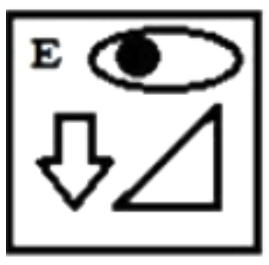

(d) 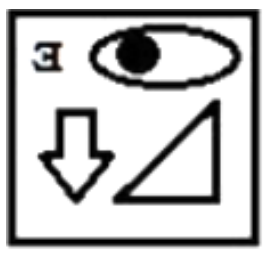

**Q.127.** Which of the option figures is the exact mirror image of the given alphanumeric- cluster when the mirror is held at the right side of the cluster ?
SSC CGL 03/03/2020 (evening)

**5 G 7 N P Q 4**

(a) 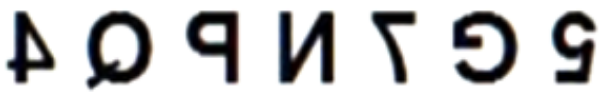

(b) 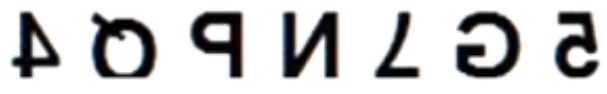

(c) 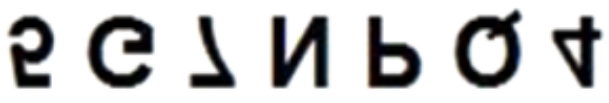

(d) 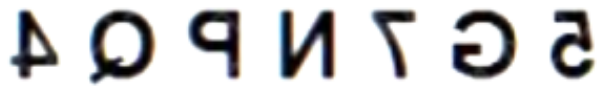

**Q.128.** Which of the option figures is the exact mirror image of the given figure when the mirror is held at the right side?
SSC CGL 04/03/2020 (morning)

#PaV$ArK@

(a) 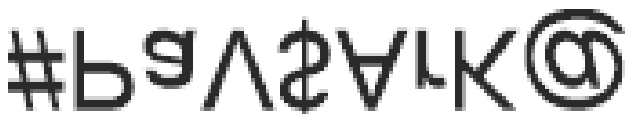

(b) 

(c) 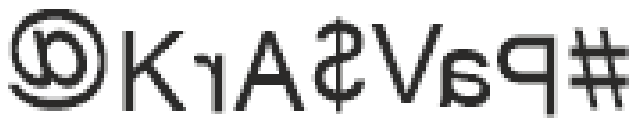

(d) 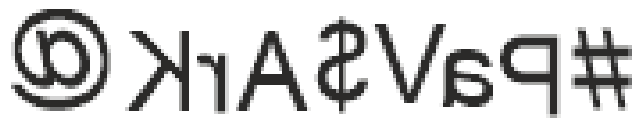

**Q.129.** Select the correct mirror image of the given figure when a mirror is placed on the right of the figure.
SSC CGL 04/03/2020(afternoon)



(a) 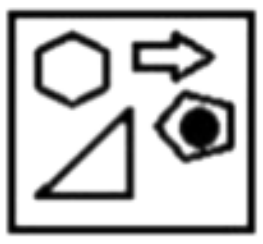

(b) 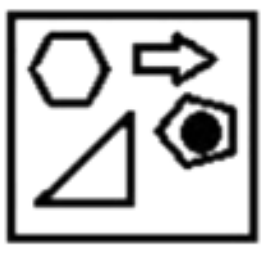

(c) 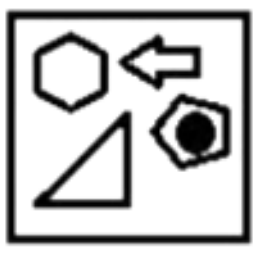

(d) 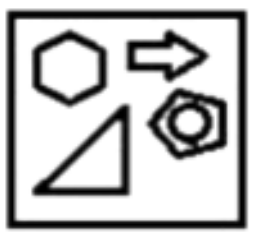

**Q.130.** Select the correct mirror image of the given figure when a mirror is placed on the right side of the figure.
SSC CGL 04/03/2020(Evening)



(a) 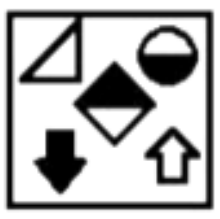

(b) 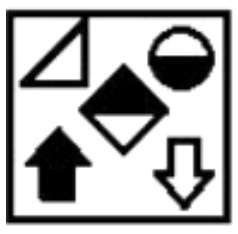

(c) 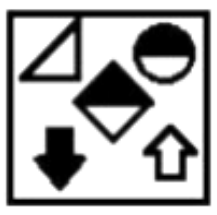

(d) 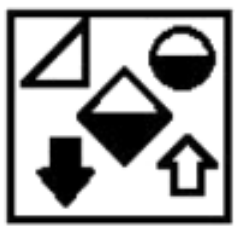

**Q.131.** Which of the option figures is the exact mirror image of the given figure when the mirror is held at the right side ?
SSC CGL 05/03/2020(Morning)

**qv56jk89lm**

(a) 

(b) 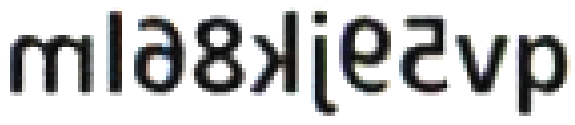

(c) 

(d) 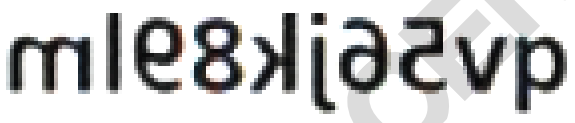

**Q.132.** Select the correct image of the given figure when the mirror is placed on its right side.
SSC CGL 05/03/2020(Afternoon)

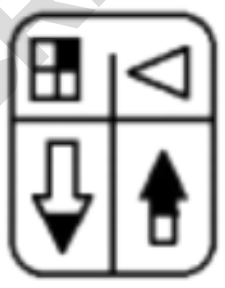

(a) 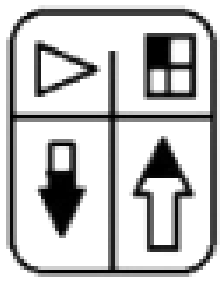

(b) 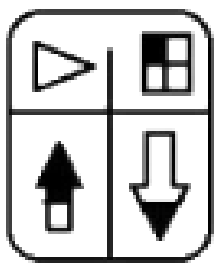

(c) 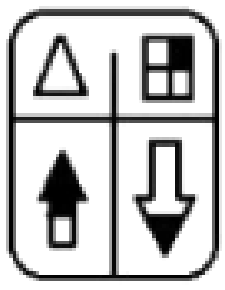

(d) 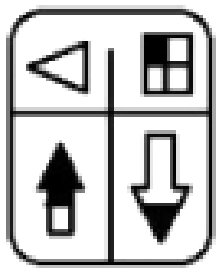

**Q.133.** Select the correct mirror image of the given figure when a vertical mirror is placed on the right side of the figure.
SSC CGL 05/03/2020(Evening)



(a) 

(b) 

(c) 

(d) 

**Q.134.** Select the correct mirror image of the given figure when a mirror is placed on the right of the figure.
SSC CGL 06/03/2020(Morning)



(a) 

(b) 

(c) 

(d) 

**Q.135.** Which of the option figures is the exact mirror image of the given figure when the mirror is held at the right side ?
SSC CGL 06/03/2020(Afternoon)

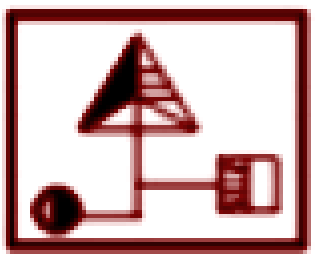

(a) 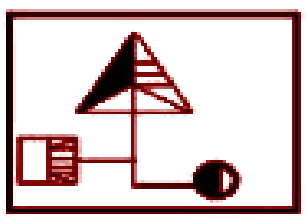

(b) 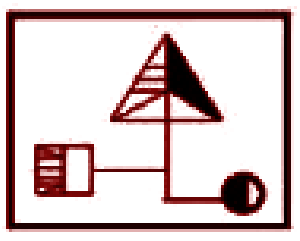

(c) 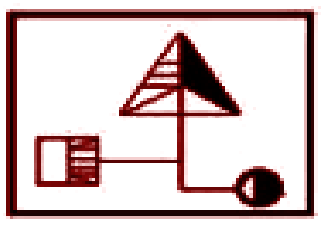

(d) 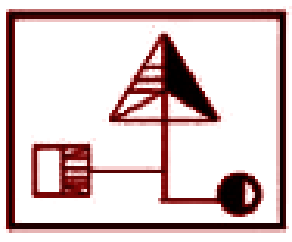

**Q.136.** Select the correct mirror image of the given when a mirror is placed on the right side of the figure.
SSC CGL 06/03/2020(Evening)



(a)


(b)
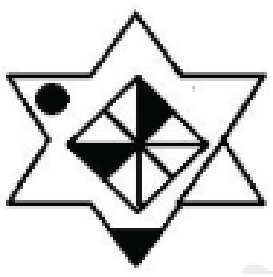

(c)
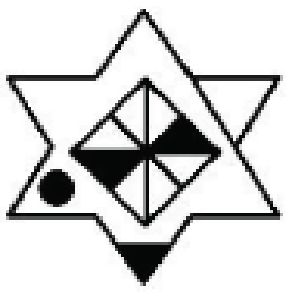

(d)


**Q.137.** Which of the option figures is the exact mirror image of the given figure when the mirror is held at the right side ?
SSC CGL 07/03/2020(Morning)

BRWOQWRB

(a)
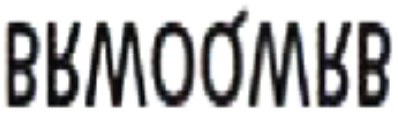

(b)


(c)
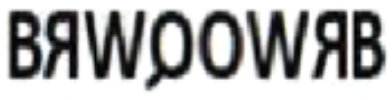

(d)


**Q.138.** Select the correct mirror image of the given alphanumeric- cluster when a vertical mirror is placed on the right side of the cluster.
SSC CGL 07/03/2020(Afternoon)

**6 5 4 H B M A**

(a)
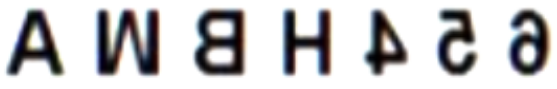

(b)
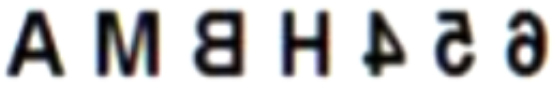

(c)
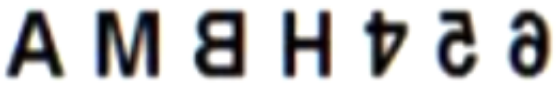

(d)
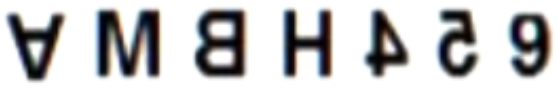

**Q.139.** Select the correct mirror image of the given figure when a mirror is placed on the right of the figure.
SSC CGL 07/03/2020(Evening)



(a)


(b)


(c)


(d)
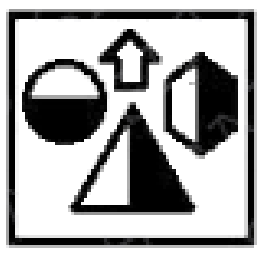

**Q.140.** Select the correct mirror image of the given letter-cluster when a vertical mirror is placed on the cluster

**R Q B K H N T**

SSC CGL 09/03/2020(Morning)

(a)
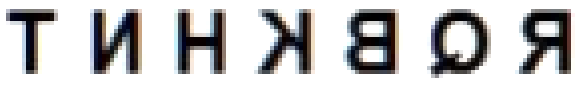

(b)
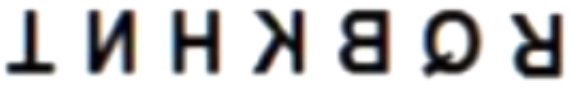

(c)
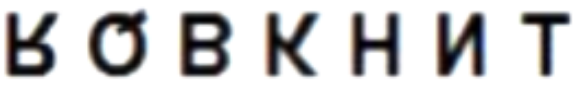

(d)
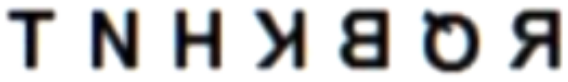

**Q.141.** Select the correct mirror image of the given letter-cluster when a vertical mirror is placed on the right side of the cluster.

**E W G Z M P K**

SSC CGL 09/03/2020(Afternoon)

(a)
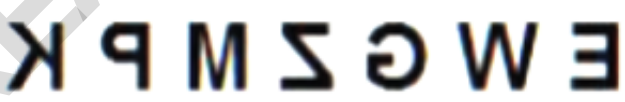

(b)


(c)
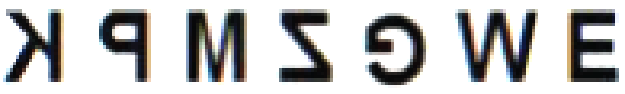

(d)


**Q.142.** Select the correct mirror image of the given alphanumeric-cluster when a mirror is placed on the right side of the cluster.
SSC CGL 09/03/2020(Evening)

5G7NPQ4

(a)
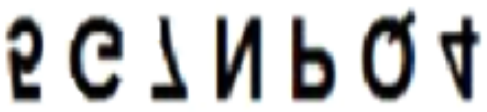

(b)
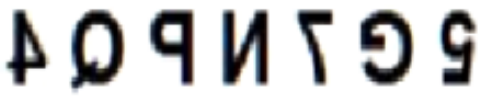

(c)
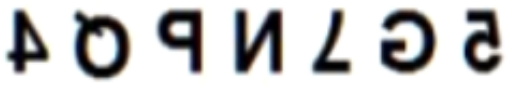

(d)
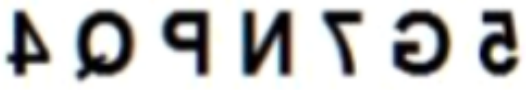

## SSC CHSL 2019 Tier I

**Q.143.** Select the correct mirror image of the given figure when a mirror is placed on the line PQ.
Question figure:
SSC CHSL 17/03/2020 (Morning)



(a)


(b)


(c)


(d)


**Q.144.** Select the correct mirror image from the answer figures when the mirror is placed on the line PQ as shown in the question figure.
SSC CHSL 17/03/2020 (Afternoon)

**Question figure:**



(a)


(b)


(c)


(d)


**Q.145.** If a mirror is placed on line PQ in the question figure, then which of the given answer figures is the correct mirror image of the question figure?
SSC CHSL 17/03/2020 (Evening)

**Question figure:**



(a) 

(b) 

(c) 

(d) 

**Q.146.** Which of the options is the exact mirror image of the given alphanumeric figure when the mirror is held at the right side?

**AHTOITG46Q34**

SSC CHSL 18/03/2020 (Morning)

(a) 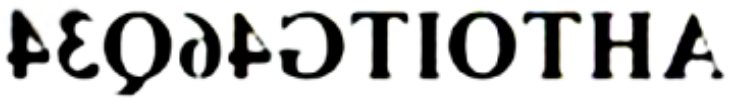

(b) 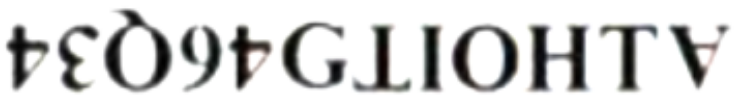

(c) 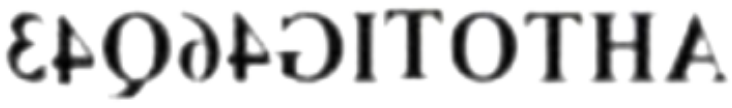

(d) 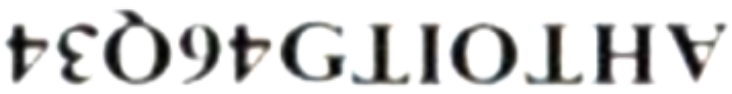

**Q.147.** Select the correct mirror image of the given figure.

SSC CHSL 18/03/2020 (Afternoon)



(a) 

(b) 

(c) 

(d) 

**Q.148.** Select the correct mirror image of the given figure.

SSC CHSL 18/03/2020 (Evening)

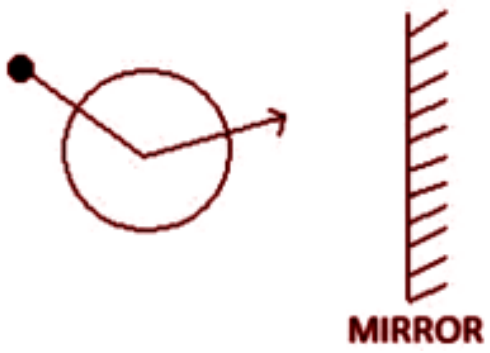

(a) 

(b) 

(c) 

(d) 

**Q.149.** If a mirror is placed on line MN in the question figure, then which of the given answer figures is the correct mirror image of the question figure?

SSC CHSL 19/03/2020 (Morning)

Question Figure:



(a) 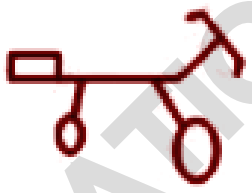

(b) 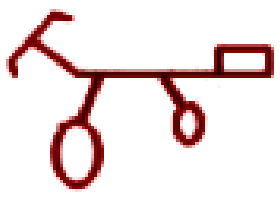

(c) 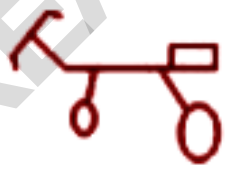

(d) 

**Q.150.** Select the correct mirror image of the given letter cluster when a vertical mirror is placed on the right of the cluster.

**F G E R M**

SSC CHSL 19/03/2020 (Afternoon)

(a) 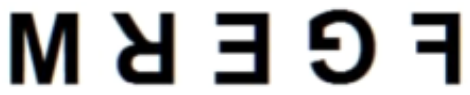

(b) 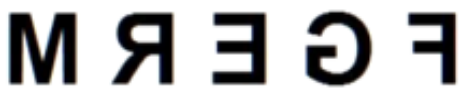

(c) 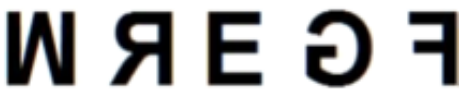

(d) 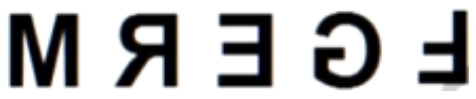

**Q.151.** Select the correct mirror image of the given figure when a vertical mirror is placed on the right of the figure.

SSC CHSL 19/03/2020 (Evening)



(a) 

(b) 

(c) 

(d) 

**Q.152.** Select the correct mirror image of the given figure.

SSC CHSL 12/10/2020 (Morning)

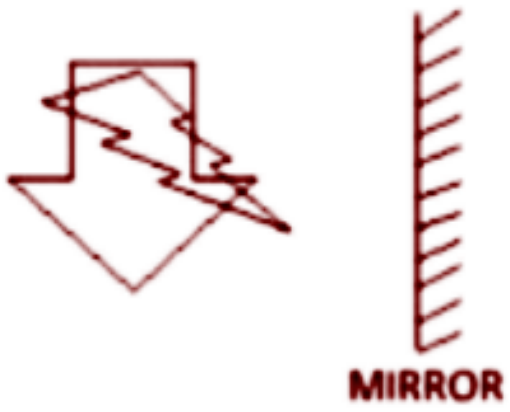

(a) 

(b) 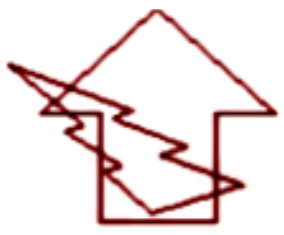

(c) 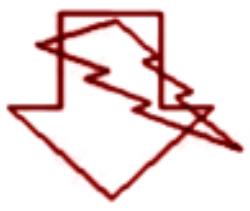

(d) 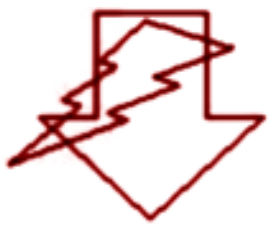

**Q.153.** Select the correct mirror image of the given figure.

SSC CHSL 12/10/2020 (Afternoon)

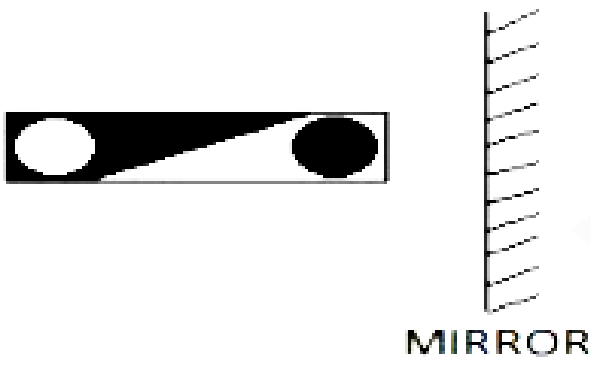

(a) 

(b) 

(c) 

(d) 

**Q.154.** Select the correct mirror image of the given figure when the mirror is placed to the right side of the figure.

SSC CHSL 12/10/2020 (Evening)



(a) 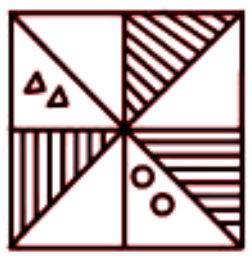
(b) 

(c) 
(d) 

**Q.155.** Select the correct mirror image of the given number-cluster when a mirror is placed on the right side of the cluster.

**9 5 6 4 3 7**

SSC CHSL 13/10/2020 (Morning)

(a) 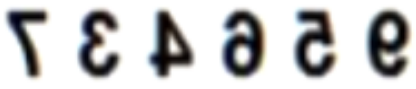

(b) 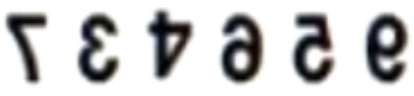

(c) 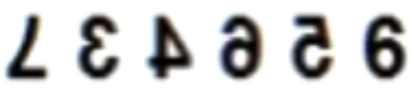

(d) 

**Q.156.** Select the correct mirror image of the given figure when a mirror is placed on the right side of the figure.

SSC CHSL 13/10/2020 (Afternoon)

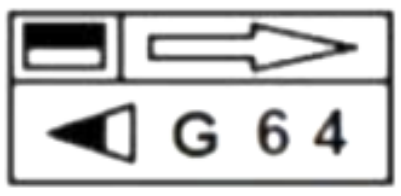

(a) 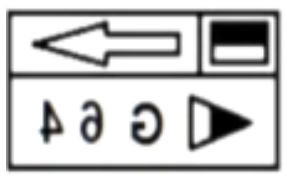
(b) 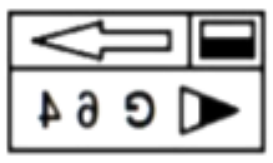

(c) 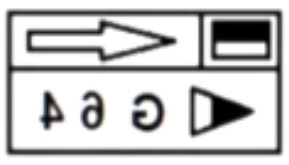
(d) 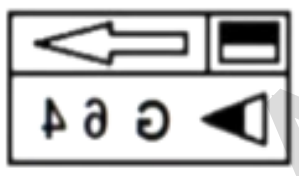

**Q.157.** Select the correct mirror image of the given figure when the mirror is placed to the right side of the figure.

SSC CHSL 13/10/2020 (Evening)



(a) 
(b) 

(c) 
(d) 

**Q.158.** Select the correct mirror image of the given figure.

SSC CHSL 14/10/2020 (Morning)

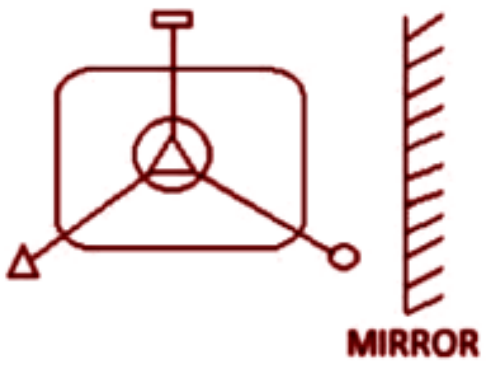

(a) 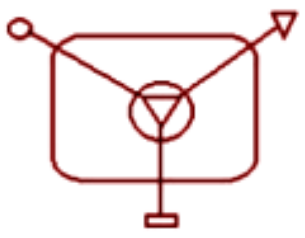
(b) 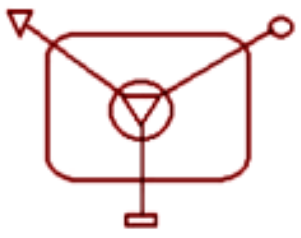

**(c)** 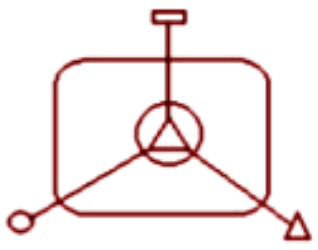
(d) 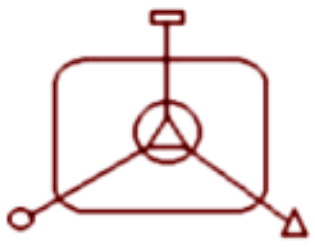

**Q.159.** Select the correct mirror image of the given figure when the mirror is placed to its right side.

SSC CHSL 14/10/2020 (Afternoon)



(a) 
(b) 

**(c)** 
(d) 

**Q.160.** Which of the following options is the correct mirror image of the given figure when the mirror is placed to the right side of the figure.

SSC CHSL 14/10/2020 (Evening)

**aeugh!#%428ghr**

(a) 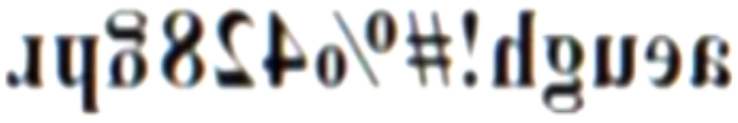

(b) 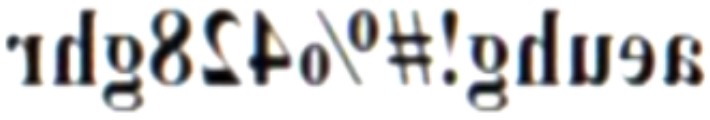

(c) 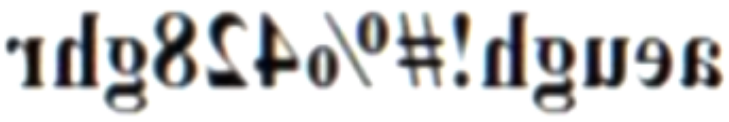

(d) 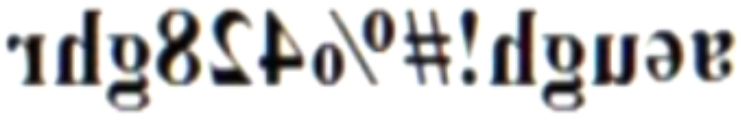

**Q.161.** Select the correct mirror image of the given figure when the mirror is placed to the right side of the figure.

SSC CHSL 15/10/2020 (Morning)



(a) 
(b) 

(c) 
(d) 

**Q.162.** Select the correct mirror image of the given figure when the mirror is placed to the right side of the figure.

SSC CHSL 15/10/2020 (Afternoon)



(a) 
(b) 

**(c)** 
(d) 

**Q.163.** Select the correct mirror image of the given letter-cluster when a vertical mirror is placed on the right side of the cluster.

SSC CHSL 15/10/2020 (Evening)

**R h f g b q**

(a) 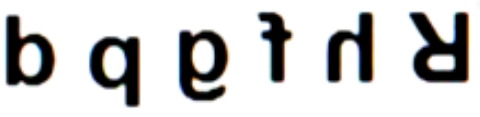

(b) 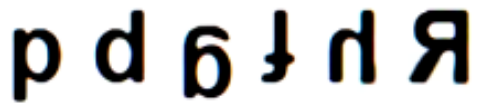

(c) 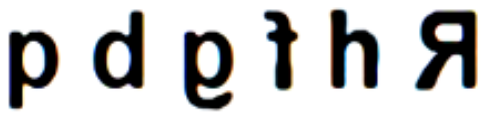

(d) 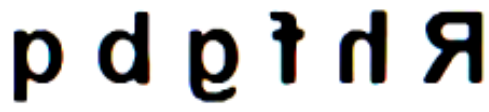

**Q.164.** If a mirror is placed on line PQ in the question figure, then which of the answer figures is the correct mirror image of the question figure?
SSC CHSL 16/10/2020 (Morning)

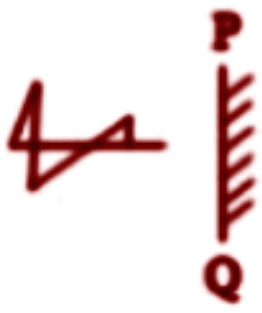

(a) 

(b) 

(c) 

(d) 

**Q.165.** If a mirror is placed on line PQ in the question figure, then which of the answer figures is the correct image of the question figure?
SSC CHSL 16/10/2020 (Afternoon)

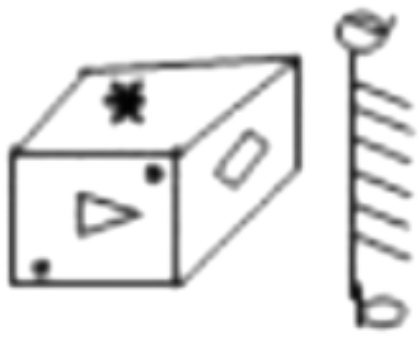

(a) 

(b) 

(c) 

(d) 

**Q.166.** Select the correct mirror image of the given figure when the mirror is placed to the right side of the figure.
SSC CHSL 19/10/2020 (Morning)

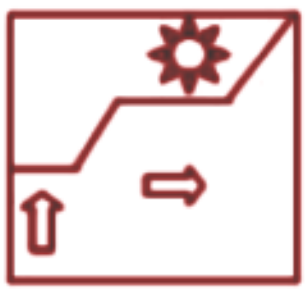

(a) 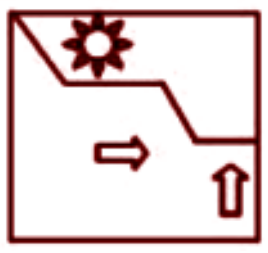

(b) 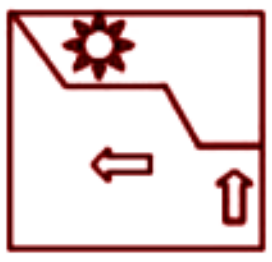

(c) 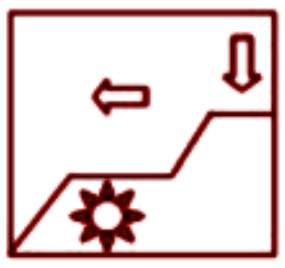

(d) 

**Q.167.** Select the correct mirror image of the given figure when the mirror is placed to the right side of the figure.



SSC CHSL 2019: 19-Oct-20 (Afternoon)

(a) 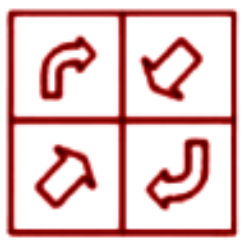

(b) 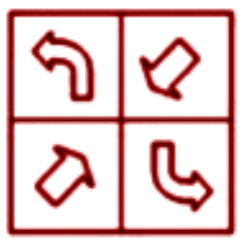

(c) 

(d) 

**Q.168.** Select the correct mirror image of the given figure when the mirror is placed to the right side of the figure.

**GKM#$%NG24**

SSC CHSL 2019: 19-Oct-20 (Evening)

(a) 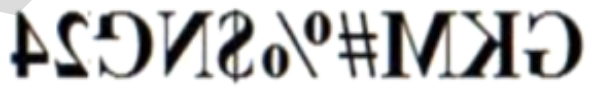

**(b)** 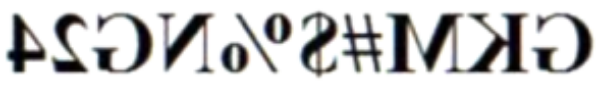

(c) 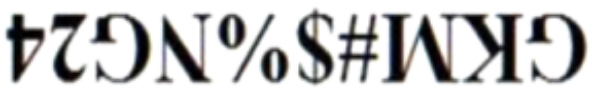

(d) 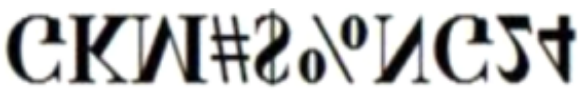

**Q.169.** Select the correct mirror image of the given figure when the mirror is placed to the right side of the figure.



SSC CHSL 2019: 19-Oct-20 (Evening)

(a) 

(b) 

(c) 

(d) 

**Q.170.** Select the correct mirror image of the given figure when the mirror is placed to the right side of the figure.

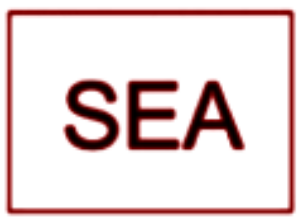

SSC CHSL 2019: 20-Oct-20 (Morning)

(a) 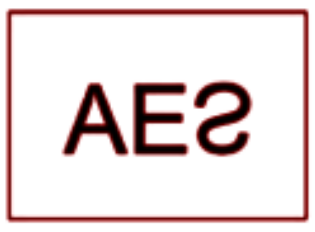

(b) 

(c) 

(d) 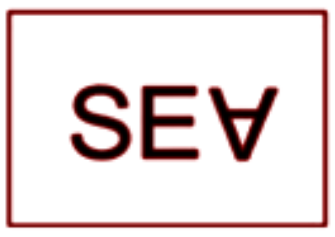

**Q.171.** Select the correct mirror image of the given figure when the mirror is placed to the right side of the figure.



SSC CHSL 2019: 20-Oct-20 (Morning)

(a) 

(b) 

(c) 

(d) 

**Q.172.** Select the correct mirror image of the given figure when the mirror is placed to the right side of the figure.

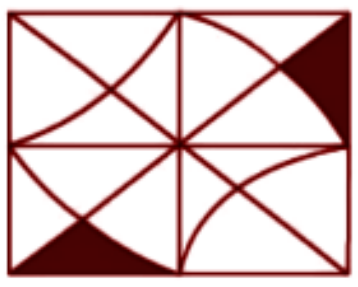

SSC CHSL 2019: 20-Oct-20 (Afternoon)

(a) 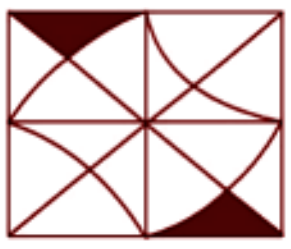

(b) 

(c) 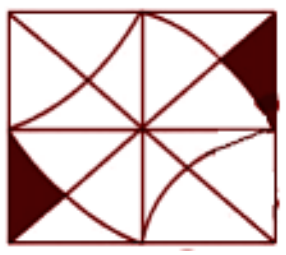

**(d)** 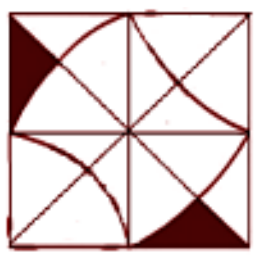

**Q.173.** Select the correct image of the given figure from the options.



SSC CHSL 2019: 20-Oct-20 (Evening)

(a)


(b)


(c)


(d)
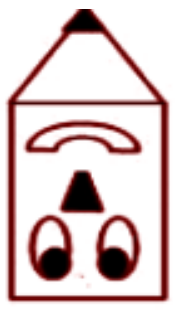

**Q.174.** Select the correct mirror image of the given figure when a mirror is placed on the right of the figure.

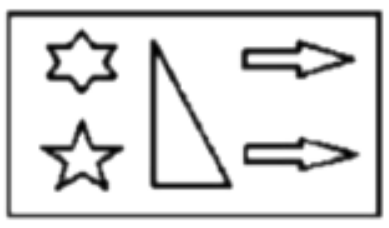

SSC CHSL 2019: 21-Oct-20 (Morning)

(a)
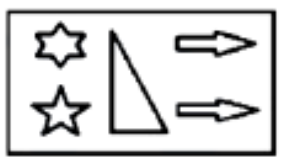

(b)
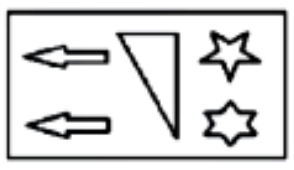

**(c)**
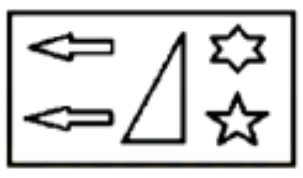

(d)
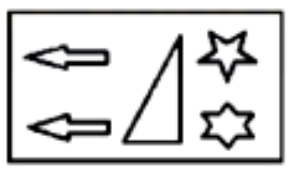

**Q.175.** Select the correct mirror image of the given figure.

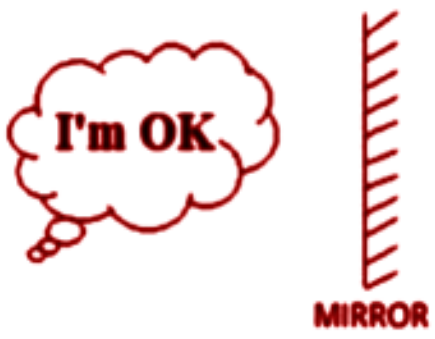

SSC CHSL 2019: 21-Oct-20 (Afternoon)

(a)


(b)


(c)


(d)


**Q.176.** Select the correct mirror image of the given figure when the mirror is placed to the right side of the figure.

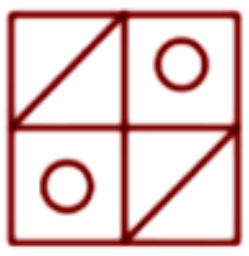

SSC CHSL 2019: 21-Oct-20 (Evening)

(a)
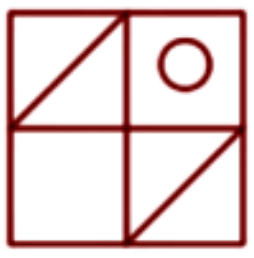

(b)


(c)


(d)


**Q.177.** Select the correct mirror image of the given figure when a mirror is placed on the right of the figure.

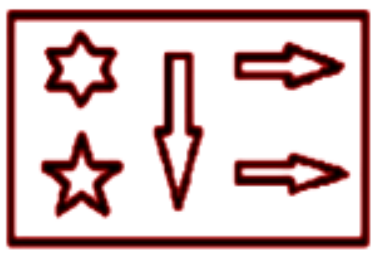

SSC CHSL 2019: 26-Oct-20 (Morning)

(a)


(b)
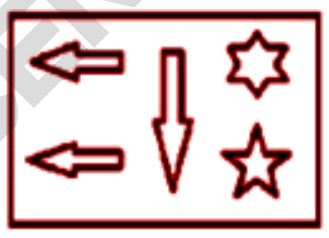

(c)
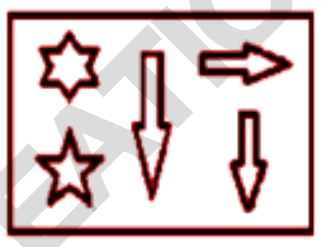

(d)
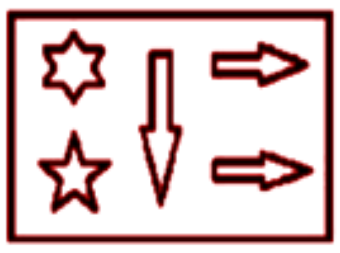

**Q.178.** Select the mirror image of the given figure.



SSC CHSL 2019: 26-Oct-20 (Afternoon)

(a)
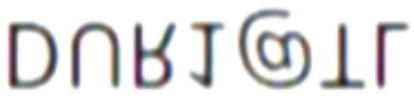

(b)
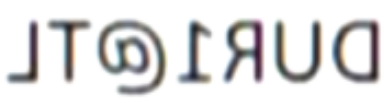

(c)
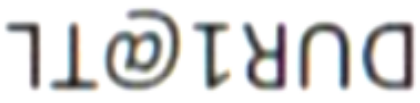

(d)
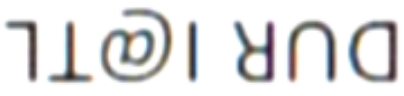

**Q.179.** Select the correct mirror image of the given figure when the mirror is placed to the right side of the figure.

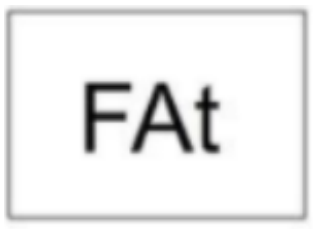

SSC CHSL 2019: 26-Oct-20 (Evening)

(a)


(b)


(c)
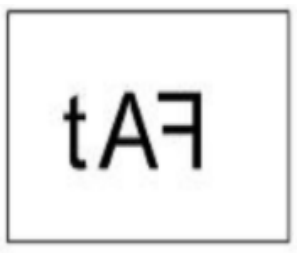

(d)
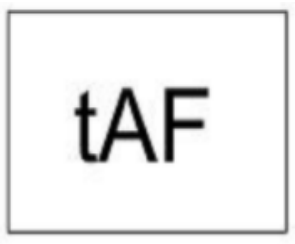

## SSC CPO 2020 Tier I

**Q.180.** Select the correct mirror image of the given combination when the mirror is placed at 'PQ' as shown

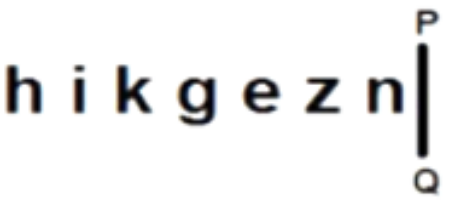

**SSC CPO 23.11.2020 (Morning)**

(a)
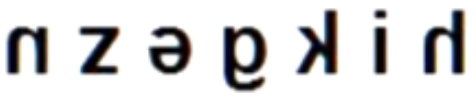

(b)
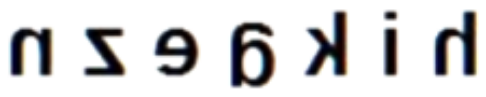

(c)
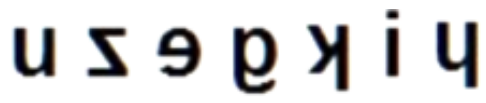

(d)
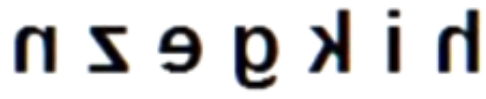

**Q.181.** Select the correct mirror image of the given combination when the mirror is placed at 'PQ' as shown below



**SSC CPO 23.11.2020 (Morning)**

(a)
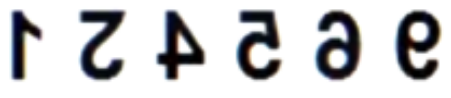

(b)
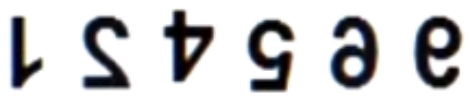

(c)
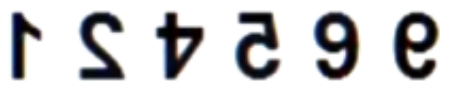

(d)
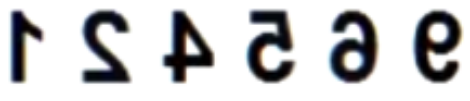

**Q.182.** Select the correct mirror image of the given combination when the mirror is placed at 'PQ' as shown below.

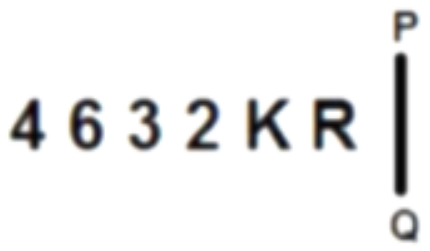

SSC CPO 23.11.2020 (Evening)

(a) 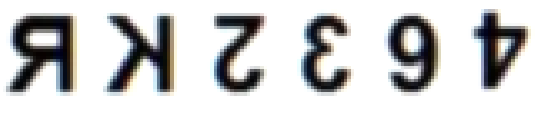

(b) 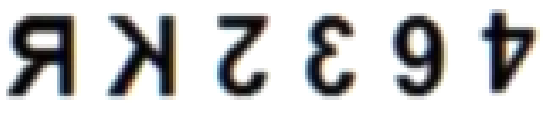

(c) 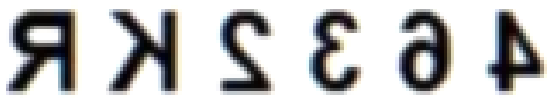

(d) 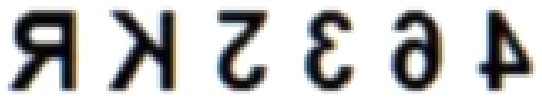

**Q.183.** Select the correct mirror image of the given combination when the mirror is placed at "PQ" as shown below.



SSC CPO 23.11.2020 (Evening)

(a) 

(b) 

(c) 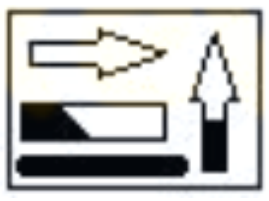

(d) 

**Q.184.** Select the correct mirror image of the given combination when the mirror is placed at 'PQ' as shown below.

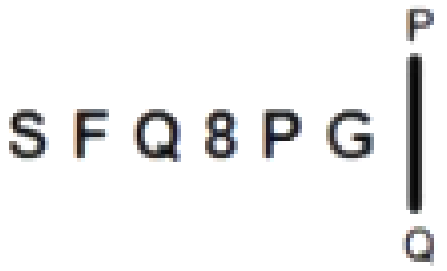

SSC CPO 24.11.2020 (Morning)

(a) 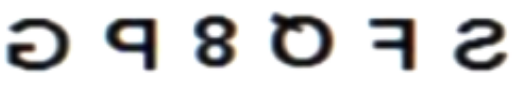

(b) 

(c) 

(d) 

**Q.185.** Select the correct mirror image of the given combination when the mirror is placed at 'PQ' as shown below.



SSC CPO 24.11.2020 (Morning)

(a) 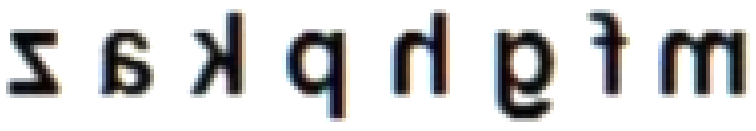

(b) 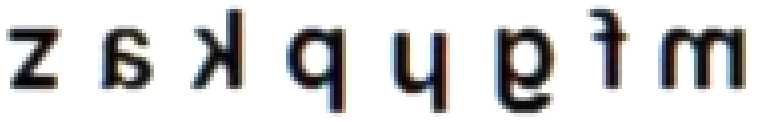

(c) 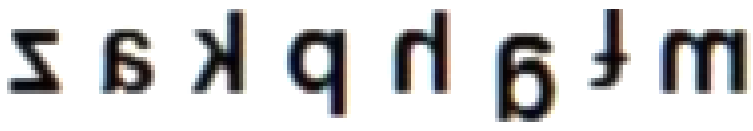

(d) 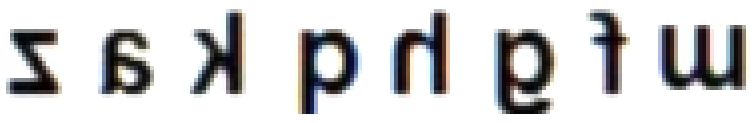

**Q.186.** Select the correct mirror image of the given combination when the mirror is placed at 'PQ' as shown



SSC CPO 24.11.2020 (Evening)

(a) 

(b) 

(c) 

(d) 

**Q.187.** Select the correct mirror image of the given combination when the mirror is placed at 'PQ' as shown

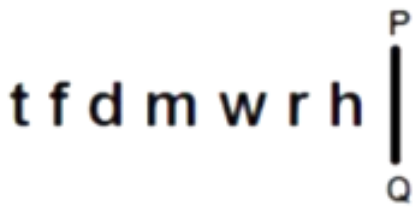

SSC CPO 24.11.2020 (Evening)

(a) 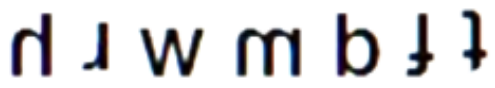

(b) 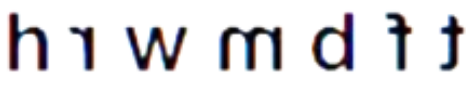

(c) 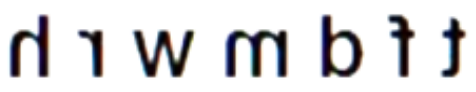

(d) 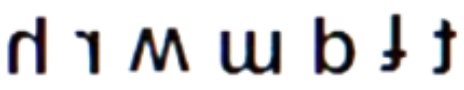

**Q.188.** Select the correct mirror image of the given figure when the mirror is placed to the right side of the figure..

**PQRLG**

SSC CPO 25.11.2020 (Morning)

(a) 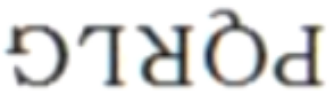

(b) GLRQP

(c) 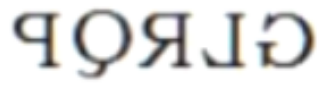

(d) 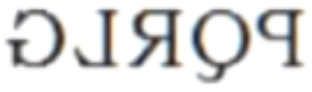

**Q.189.** figure when the mirror is placed to the right side of the figure.



SSC CPO 25.11.2020 (Morning)

(a) 

(b) 

(c) 

(d) 

**Q.190.** Select the correct mirror image of the given figure when the mirror is placed to the right side of the figure.



SSC CPO 25.11.2020 (Evening)

(a) 

(b) 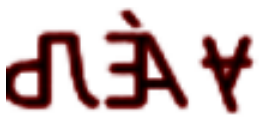

(c) 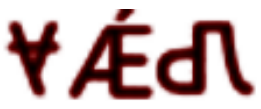

(d) 

## SSC CHSL 2020 Tier I

**Q.191.** Select the correct mirror image of the given combination when the mirror is placed at 'PQ' as shown.



SSC CHSL 12/04/2021 (Morning)

(a) 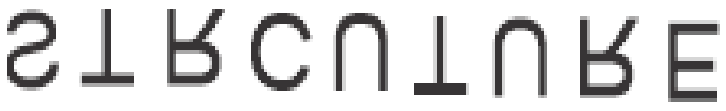

(b) 

(c) 

(d) 

**Q.192.** Select the correct mirror image of the given figure when the mirror is placed at the right side of the figure.

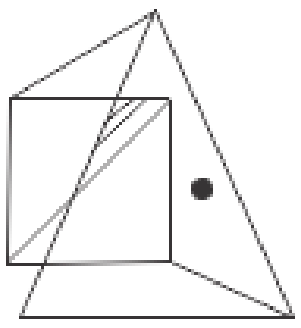

SSC CHSL 12/04/2021 (Afternoon)

(a) 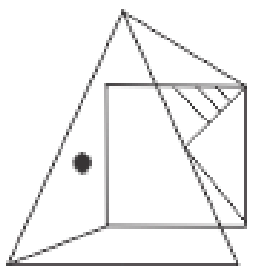

(b) 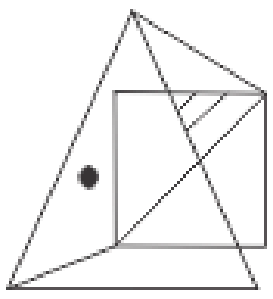

(c) 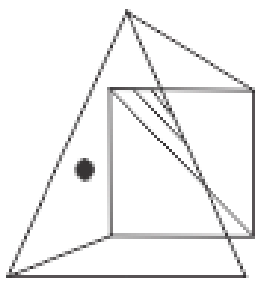

(d) 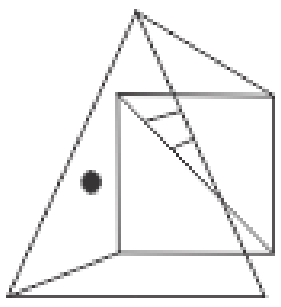

**Q.193.** Select the correct mirror image of the given combination when the mirror is placed at MN as shown.

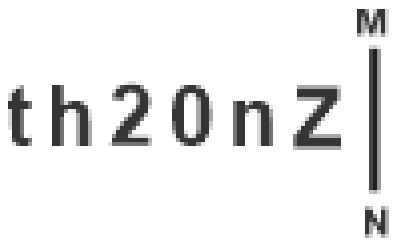

SSC CHSL 12/04/2021 (Evening)

(a) 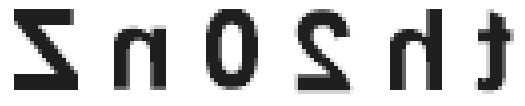

(b) 

(c) 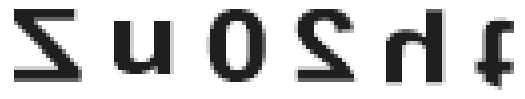

(d) 

**Q.194.** Select the correct mirror image of the given combination when the mirror is placed at 'PQ' as shown.



SSC CHSL 13/04/2021 (Morning)

(a) 

(b) 

(c) 

(d) 

**Q.195.** Select the correct mirror image of the given figure when the mirror is placed at the right side of the figure.

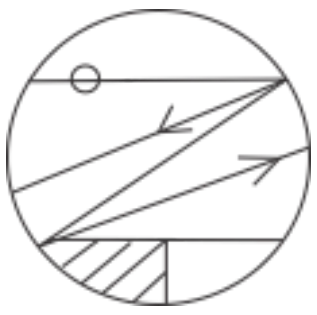

SSC CHSL 13/04/2021 (Afternoon)

(a) 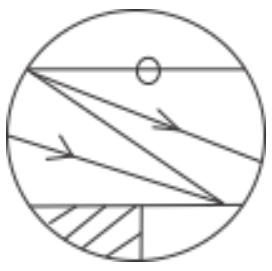

(b) 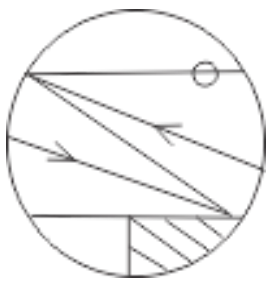

(c) 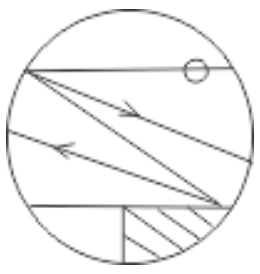

(d) 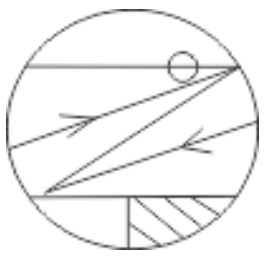

**Q.196.** Select the correct mirror image of the given combination when the mirror is placed at MN as shown.



SSC CHSL 13/04/2021 (Evening)

(a) 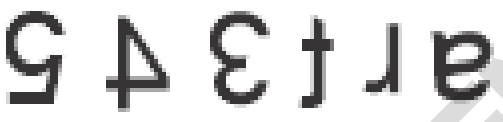

(b) 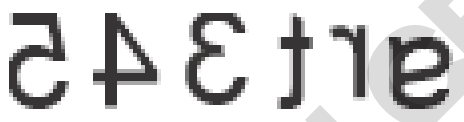

(c) 

(d) 

**Q.197.** Select the mirror image of the given combination when the mirror is placed to the right side of it.

MuNICiPALItY

SSC CHSL 15/04/2021 (Morning)

(a) 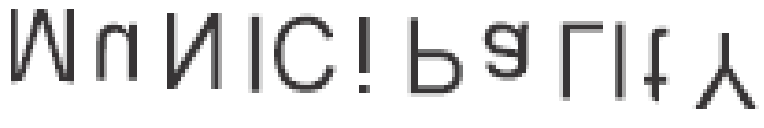

(b) 

(c) 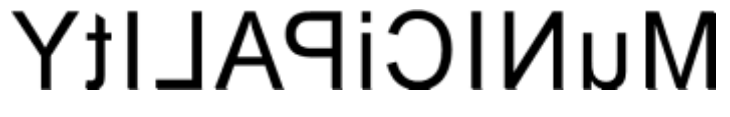

(d) 

**Q.198.** Select the correct mirror image of the given figure when the mirror is placed at the right side of the figure.

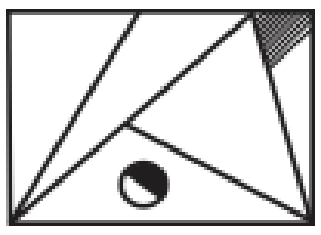

SSC CHSL 15/04/2021 (Afternoon)

(a) 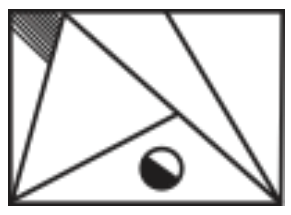

(b) 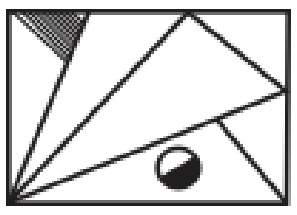

(c) 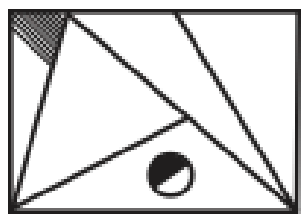

(d) 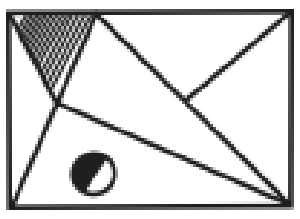

**Q.199.** Select the correct mirror image of the given figure when a mirror is placed on the right side of the figure.

CHEMISTRY

SSC CHSL 15/04/2021 (Evening)

(a) 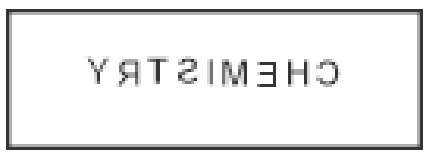

(b) 

(c) 

(d) 

**Q.200.** Select the correct mirror image of the given combination when the mirror is placed at 'PQ' as shown



SSC CHSL 16/04/2021 (Morning)

(a) 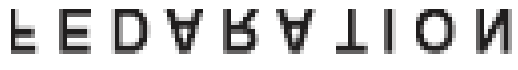

(b) 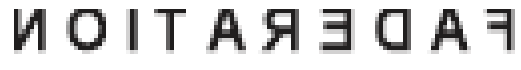

(c) 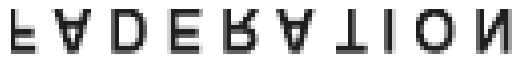

(d) 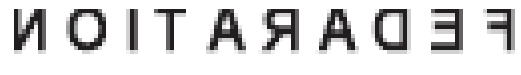

**Q.201.** Select the correct mirror image of the given number cluster when a mirror is placed on its right side.

4 5 6 8 2 1

SSC CHSL 16/04/2021 (Afternoon)

(a) 

(b) 

(c) 

(d) 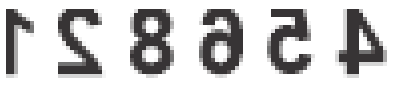

**Q.202.** Select the correct mirror image of the given figure when a mirror is placed on the right side of the figure.



SSC CHSL 16/04/2021 (Evening)

(a) 

(b) 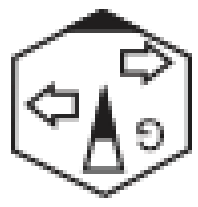

(c) 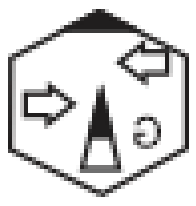

(d) 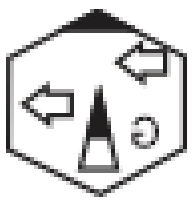

**Q.203.** Select the correct mirror image of the given combination when the mirror is placed at 'PQ' as shown.



SSC CHSL 19/04/2021 (Morning)

(a) 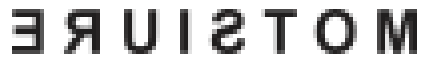

(b) 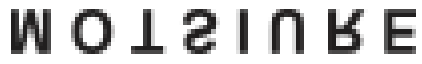

(c) 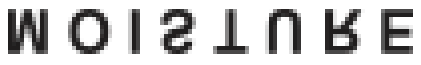

(d) 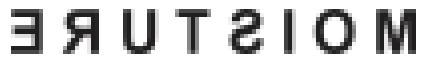

**Q.204.** Select the correct mirror image of the given combination when the mirror is placed at 'PQ' as shown.



SSC CHSL 19/04/2021 (Afternoon)

(a) 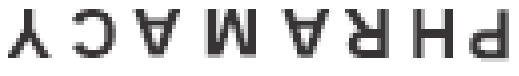

(b) 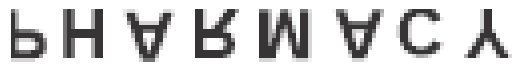

(c) 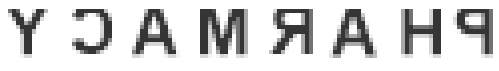

(d) 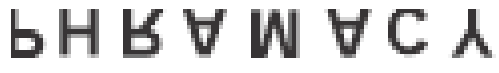

**Q.205.** Select the correct mirror image of the given combination when the mirror is placed at MN as shown.

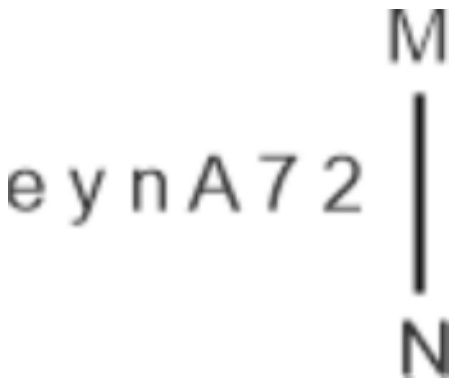

SSC CHSL 19/04/2021 (Evening)

(a) 

(b) 

(c) 

(d) 

**Q.206.** Select the correct mirror image of the given figure when the mirror is placed at the right side of the figure.



SSC CHSL 04/08/2021 (Morning)

(a) 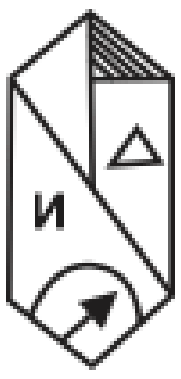

(b) 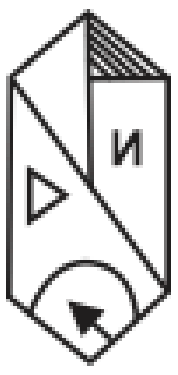

(c) 

(d) 

**Q.207.** Select the correct mirror image of the given combination when the mirror is placed at MN as shown.

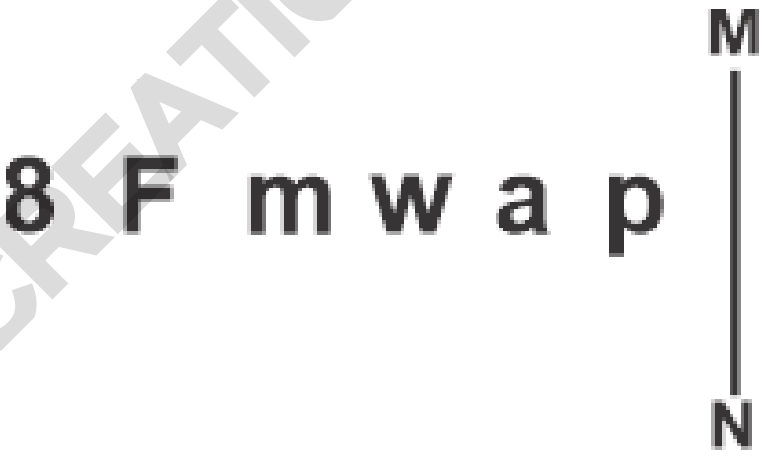

SSC CHSL 04/08/2021 (Afternoon)

(a) 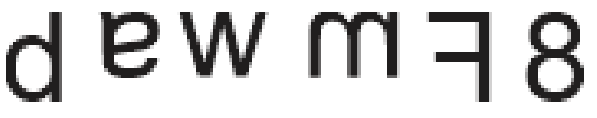

(b) 

(c) 

(d) 

**Q.208.** Select the correct mirror image of the given combination when the mirror is placed at 'PQ' as shown.



SSC CHSL 04/08/2021 (Evening)

(a) 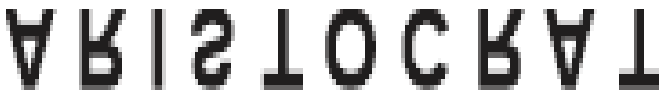

(b) 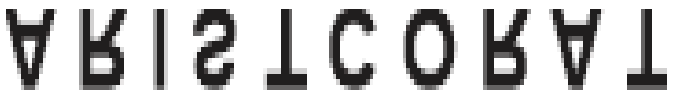

(c) 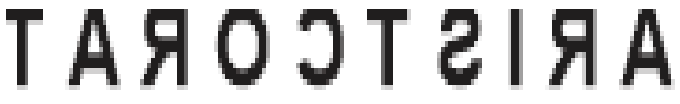

(d) 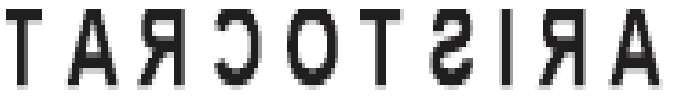

**Q.209.** Select the correct mirror image of the given figure when the mirror is placed at the right side.

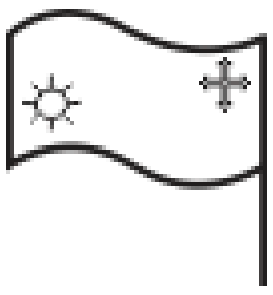

SSC CHSL 05/08/2021 (Morning)

(a) 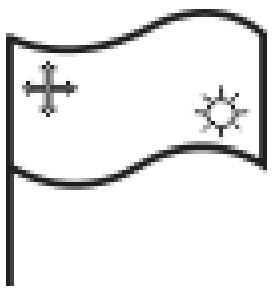

(b) 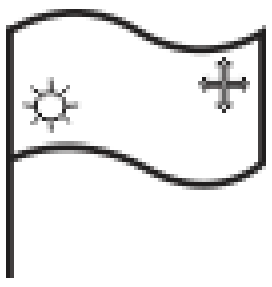

(c) 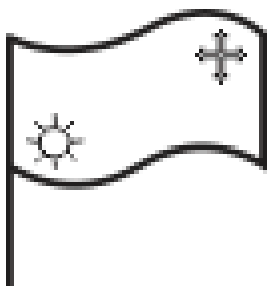

(d) 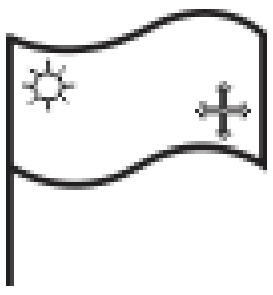

**Q.210.** Select the correct mirror image of the given figure when the mirror is placed at the right side

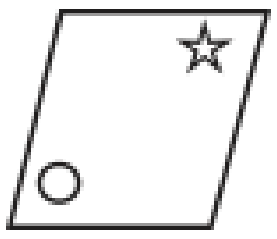

SSC CHSL 05/08/2021 (Afternoon)

(a) 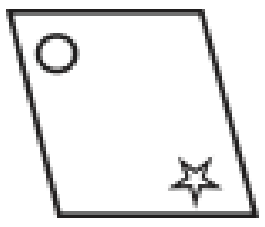

(b) 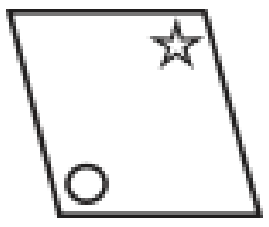

(c) 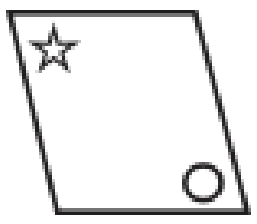

(d) 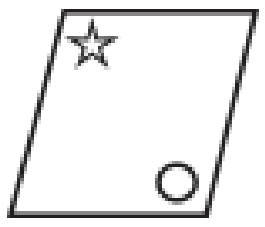

**Q.211.** Select the correct mirror image of the given combination when the mirror is placed at MN as shown.



SSC CHSL 05/08/2021 (Evening)

(a) 

(b) 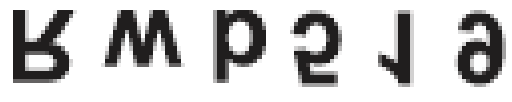

(c) 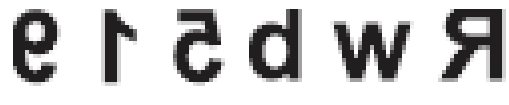

(d) 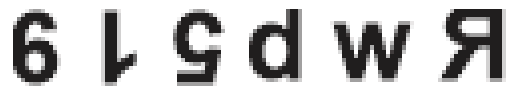

**Q.212.** Select the correct mirror image of the given figure when the mirror is placed at the right side.

**46HSPY**

SSC CHSL 06/08/2021 (Morning)

(a)
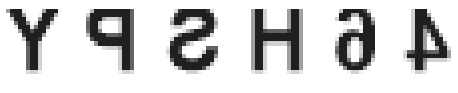

(b)
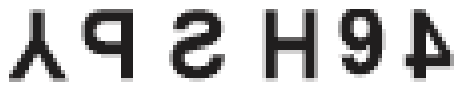

(c)
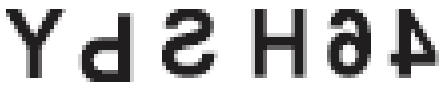

(d)
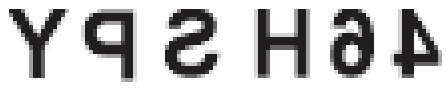

**Q.213.** Select the correct mirror image of the given figure when the mirror is placed at the right side.

**TER$MI5NATE**

SSC CHSL 06/08/2021 (Afternoon)

(a)


(b)


(c)
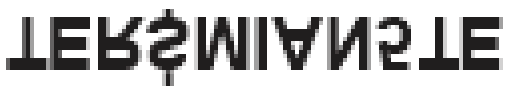

(d)


**Q.214.** Select the correct mirror image of the given letter cluster when a mirror is placed on the right side of the cluster.

**DNKTRA**

SSC CHSL 06/08/2021 (Evening)

(a)
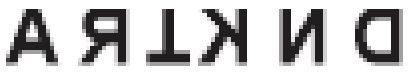

(b)


(c)
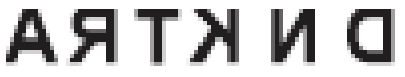

(d)
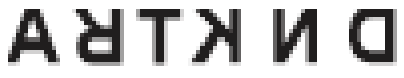

**Q.215.** Select the correct mirror image of the given figure when the mirror is placed at the right side.



SSC CHSL 09/08/2021 (Morning)

(a)


(b)


(c)


(d)
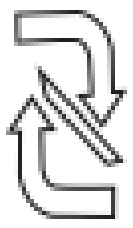

**Q.216.** Select the correct mirror image of the given figure when the mirror is placed at the right side of the figure.

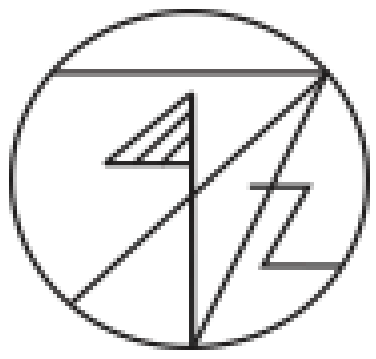

SSC CHSL 09/08/2021 (Afternoon)

(a)
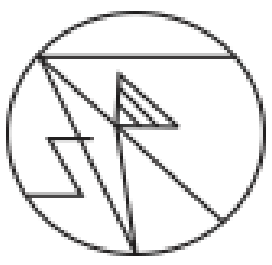

(b)
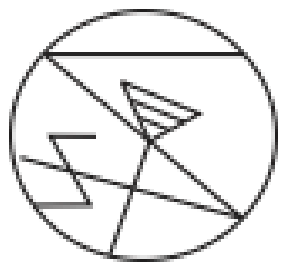

(c)
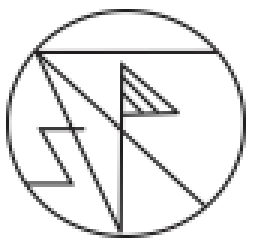

(d)
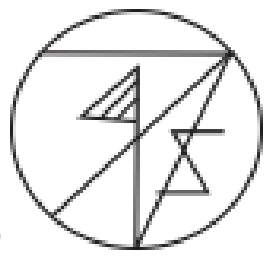

**Q.217.** Select the correct mirror image of the given combination when the mirror is placed at 'PQ' as shown.



SSC CHSL 09/08/2021 (Evening)

(a)


(b)


(c)


(d)


**Q.218.** Select the correct mirror image of the given figure when the mirror is placed at the right side.

GRS?@915

SSC CHSL 10/08/2021 (Morning)

(a)


(b)


(c) 519@?SRG

(d)


**Q.219.** Select the correct mirror image of the given figure when the mirror is placed to the right side of the figure.



SSC CHSL 10/08/2021 (Afternoon)

(a)


(b)


(c)


(d)
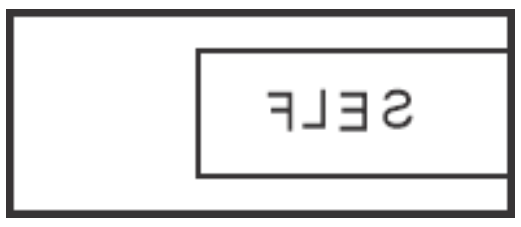

**Q.220.** Select the correct mirror image of the given figure when the mirror is placed at the right side.

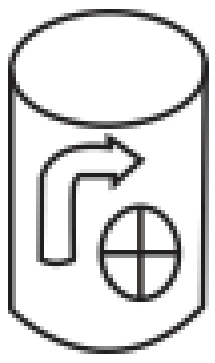

SSC CHSL 10/08/2021 (Evening)

(a)


(b)


(c)
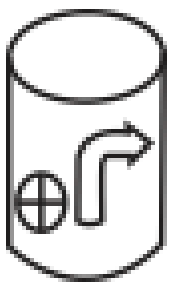

(d)


**Q.221.** Select the correct mirror image of the given figure when the mirror is placed at the right side.

A£CαEß

SSC CHSL 11/08/2021 (Morning)

(a) ßEαC£A

(b)


(c)


(d)


**Q.222.** Select the correct mirror image of the given combination when the mirror is placed at MN as shown.



SSC CHSL 11/08/2021 (Afternoon)

(a) 

(b) 

(c) 

(d) 

**Q.223.** Select the correct mirror image of the given combination when the mirror is placed to the right side of it.

DIViNeMaGIC

SSC CHSL 11/08/2021 (Evening)

(a) 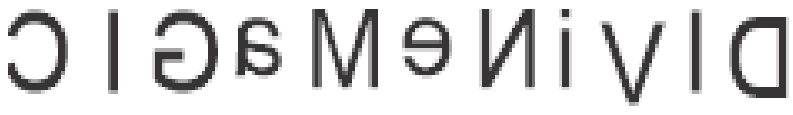

(b) 

(c) 

(d) 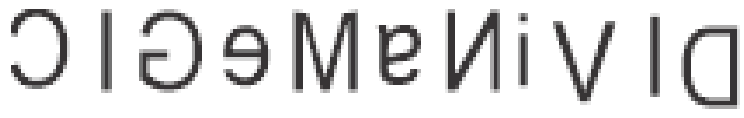

**Q.224.** Select the correct water image of the given letter-cluster.

EDZMKA

SSC CHSL 12/08/2021 (Morning)

(a) 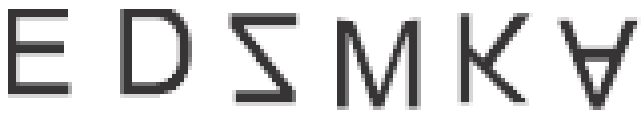

(b) 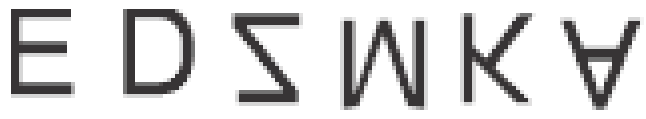

(c) 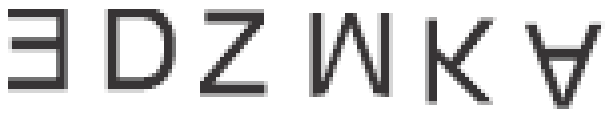

(d) 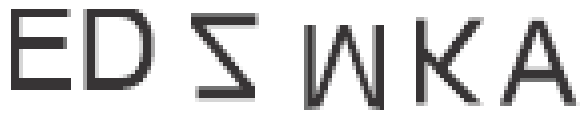

**Q.225.** Select the correct mirror image of the given figure when the mirror is placed at the right side of the figure.

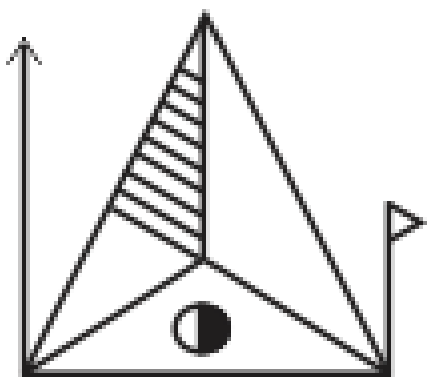

SSC CHSL 12/08/2021 (Afternoon)

(a) 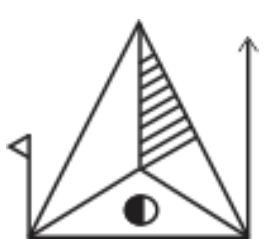

(b) 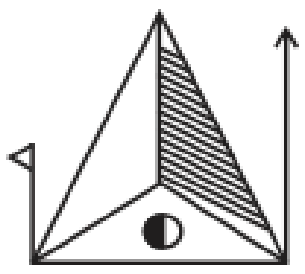

(c) 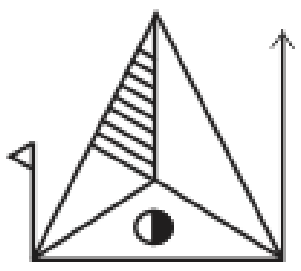

(d) 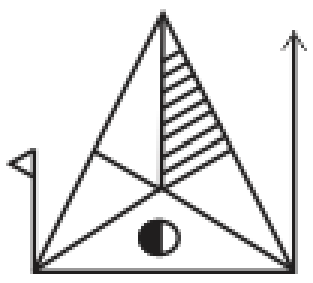

**Q.226.** Select the correct mirror image of the given figure when a mirror is placed on the right side of the figure.



SSC CHSL 12/08/2021 (Evening)

(a) 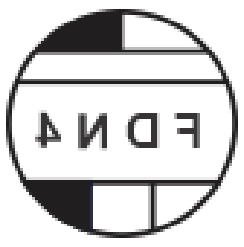

(b) 

(c) 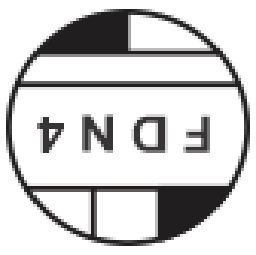

(d) 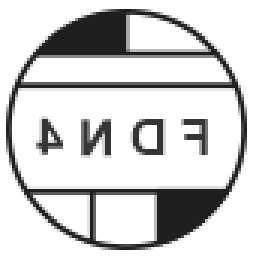

## SSC CGL 2020 Tier I

**Q.227.** Select the correct mirror image of the given combination when the mirror is placed at 'PQ' shown.

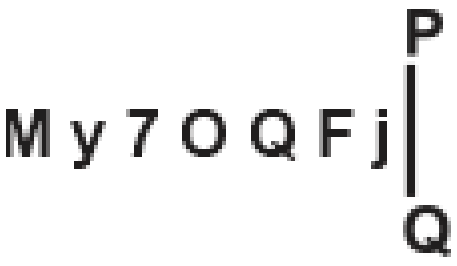

SSC CGL 13/08/2021 (Morning)

(a) 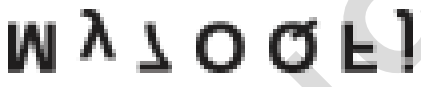

(b) 

(c) 

(d) 

**Q.228.** Select the correct mirror image of the given combination when the mirror is place at 'PQ' as shown.

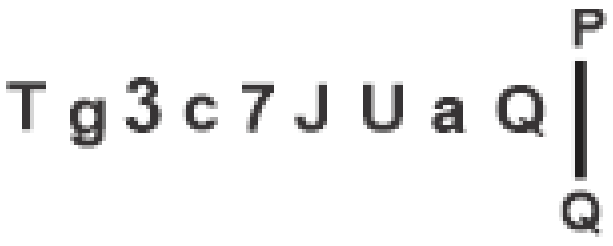

SSC CGL 13/08/2021 (Afternoon)

(a) 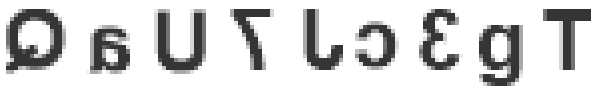

(b) 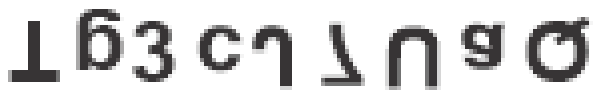

(c) 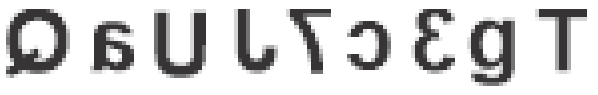

(d) 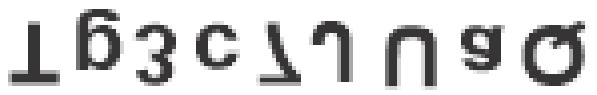

**Q.229.** Select the correct mirror image of the given combination when the mirror is placed at MN as shown.



SSC CGL 16/08/2021 (Morning)

(a) 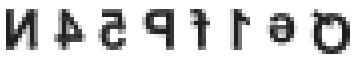

(b) 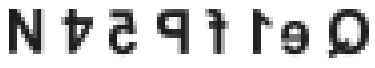

(c) 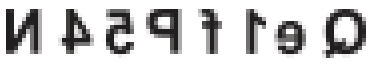

(d) 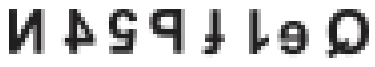

**Q.230.** Select the correct mirror image of the given figure when the mirror is placed at 'AB' as shown.

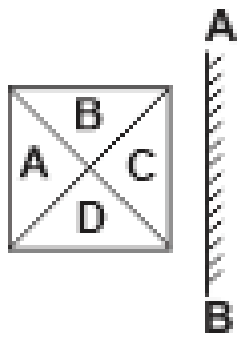

SSC CGL 16/08/2021 (Afternoon)

(a) 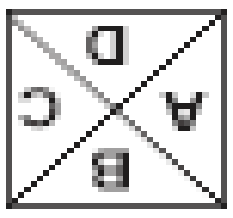

(b) 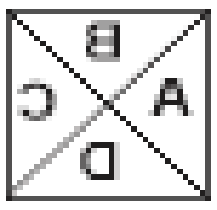

(c) 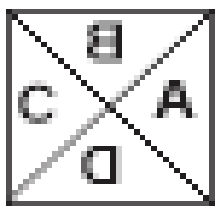

(d) 

**Q.231.** Select the correct mirror image of the given combination when the mirror is placed at MN as shown.



SSC CGL 16/08/2021 (Evening)

(a) 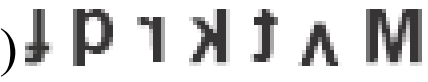

(b) 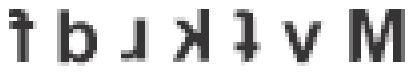

(c) 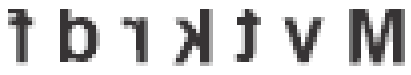

(d) 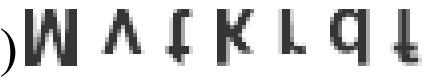

**Q.232.** Select the correct mirror image of the given figure when the mirror is placed at 'AB' as shown.

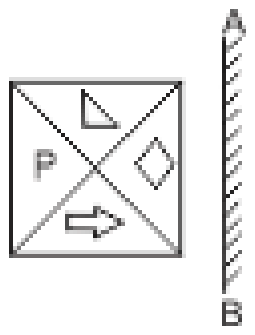

SSC CGL 17/08/2021 (Morning)

(a) 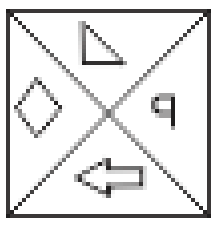

(b) 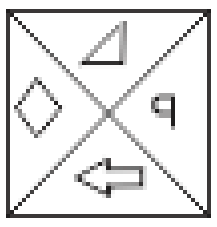

(c) 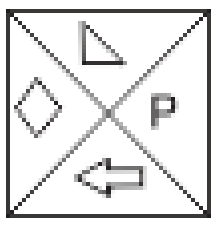

(d) 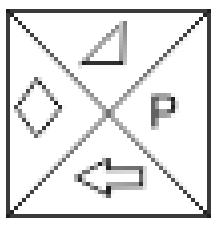

**Q.233.** Select the correct mirror image of the given combination when the mirror is placed at 'PQ' as shown.



SSC CGL 17/08/2021 (Afternoon)

(a) 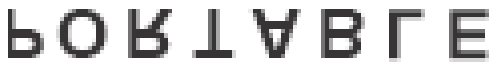

(b) 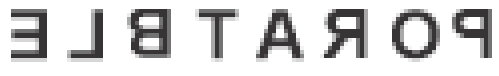

(c) 

(d) 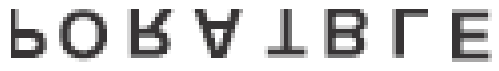

**Q.234.** Select the correct mirror image of the given figure when the mirror is placed to its right side.

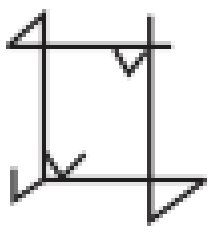

SSC CGL 17/08/2021 (Evening)

(a) 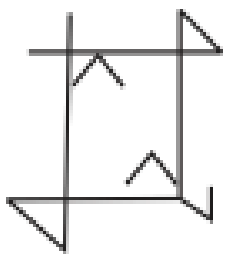

(b) 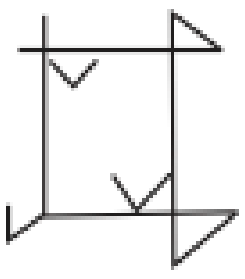

(c) 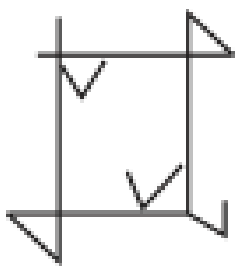

(d) 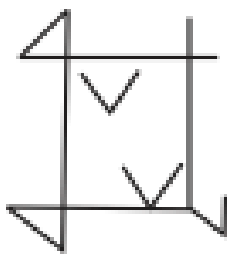

**Q.235.** Select the correct mirror image of the given combination when the mirror is placed at 'PQ' as shown.



SSC CGL 18/08/2021 (Morning)

(a) 

(b) 

(c) 

(d) 

**Q.236.** Select the correct mirror image of the given combination when the mirror is placed at MN as shown.

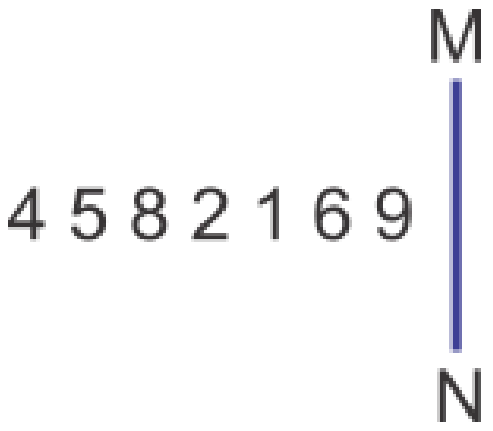

SSC CGL 18/08/2021 (Afternoon)

(a) 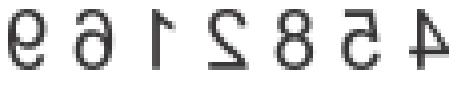

(b) 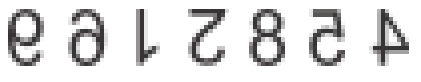

(c) 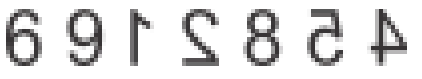

(d) 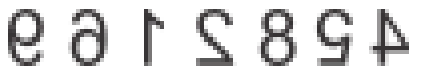

**Q.237.** Select the correct mirror image of the given figure when the mirror is placed at 'AB' as shown.

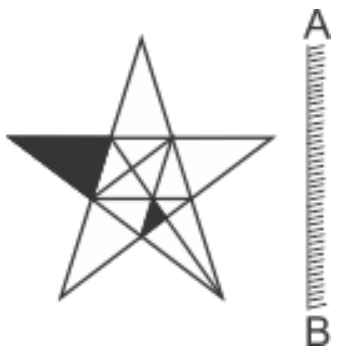

SSC CGL 18/08/2021 (Evening)

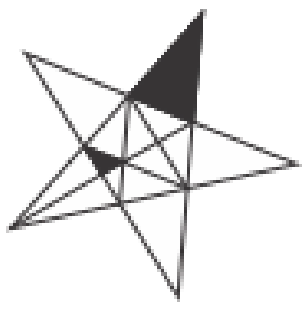
(a)

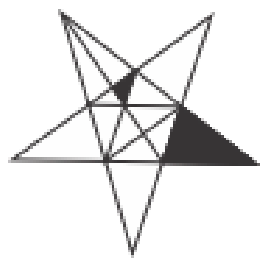
(b)

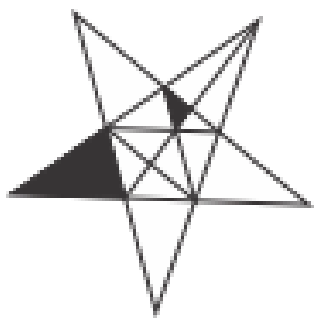
(c)

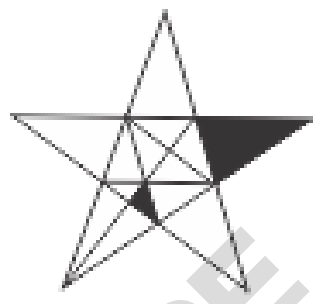
(d)

**Q.238.** Select the correct mirror image of the given combination when the mirror is placed at 'PQ' as shown.

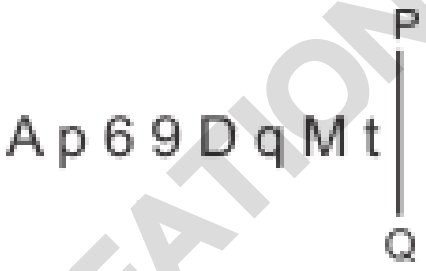

SSC CGL 20/08/2021 (Morning)

(a) 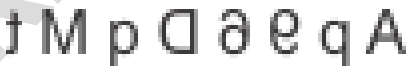

(b) 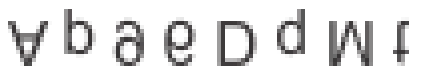

(c) 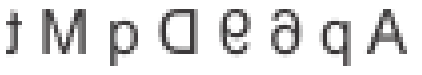

(d) 

**Q.239.** Select the correct mirror image of the given combination when the mirror is placed at 'PQ' as shown.



SSC CGL 20/08/2021 (Afternoon)

(a) 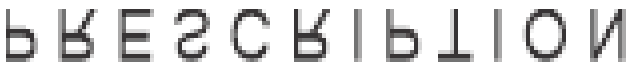

(b) 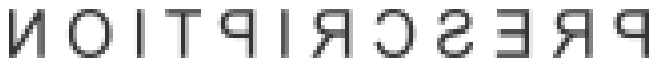

(c) 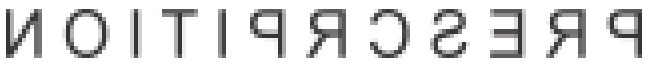

(d) 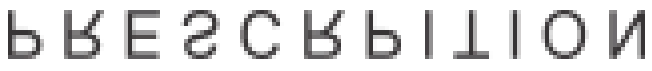

**Q.240.** Select the correct image of the given combination when the mirror is placed at MN as shown.



SSC CGL 20/08/2021 (Evening)

(a) 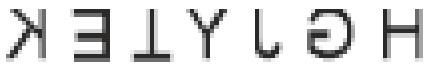

(b) 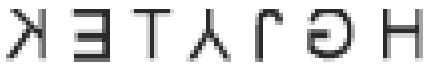

(c) 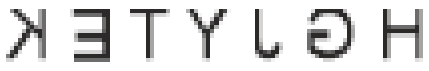

(d) 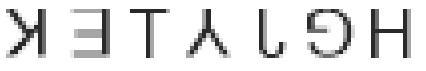

**Q.241.** Select the correct mirror image of the given combination when the mirror is placed at 'PQ' as shown.



SSC CGL 23/08/2021 (Morning)

(a) 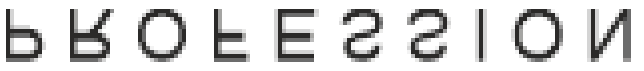

(b) 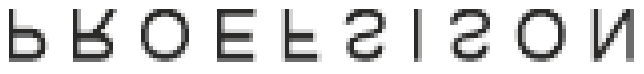

(c) 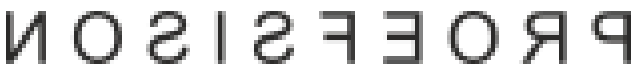

(d) 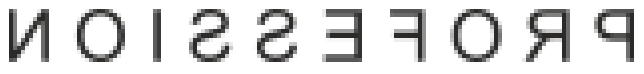

**Q.242.** Select the correct mirror image of the given figure when the mirror is placed at 'AB' as shown.

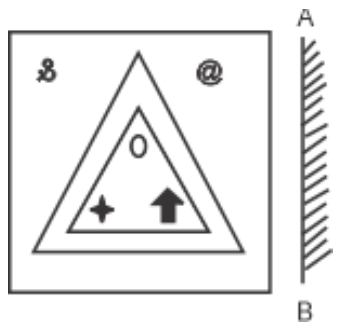

SSC CGL 23/08/2021 (Afternoon)

(a) 

(b) 

(c) 

(d) 

**Q.243.** Select the correct mirror image of the given combination when the mirror is placed at MN as shown.



SSC CGL 23/08/2021 (Evening)

(a) 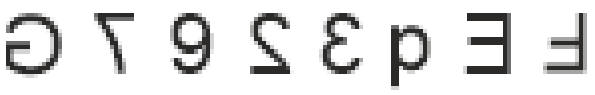

(b) 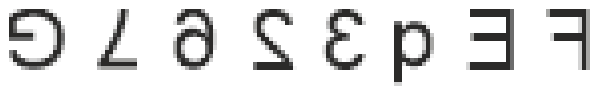

(c) 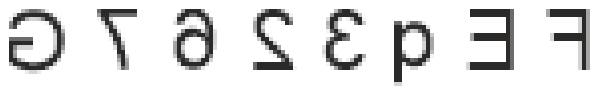

(d) 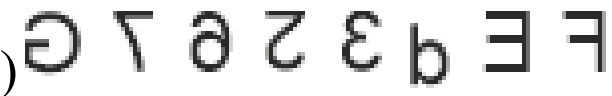

**Q.244.** Select the correct mirror image of the given combination when the mirror is placed at 'PQ' as shown.



SSC CGL 24/08/2021 (Morning)

(a) 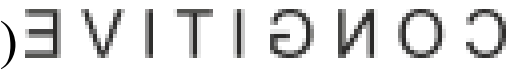

(b) 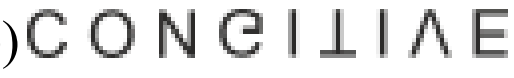

(c) 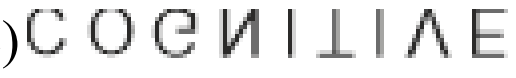

(d) 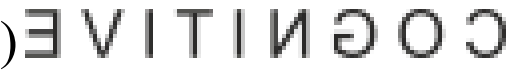

**Q.245.** Select the correct mirror image of the given combination when the mirror is placed at 'PQ' as shown.

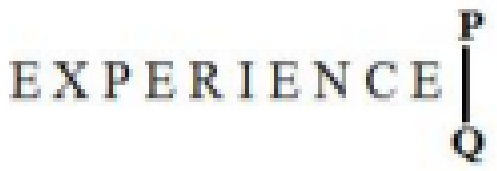

SSC CGL 24/08/2021 (Afternoon)

(a) 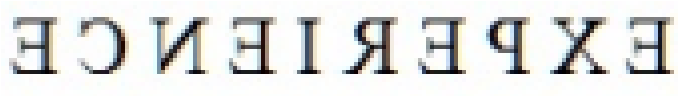

(b) 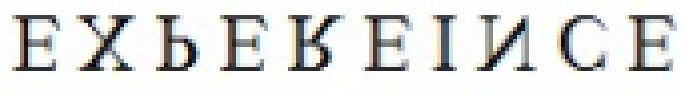

(c) 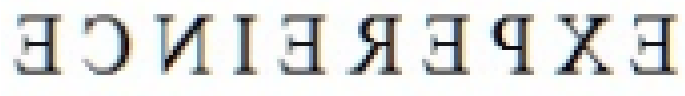

(d) 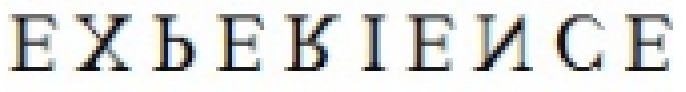

**Q.246.** Select the correct mirror image of the given combination when the mirror is placed at 'PQ' as shown.



SSC CGL 24/08/2021 (Evening)

[a] 

(b) 

(c) 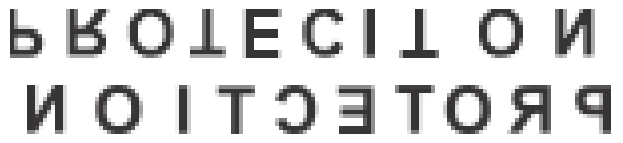

(d) 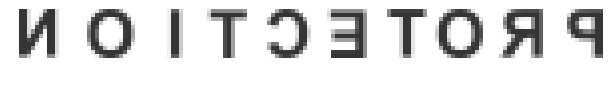

## SSC MTS 2020

**Q.247.** Select the correct mirror image of the given figure when the mirror is placed to the right side of the figure.

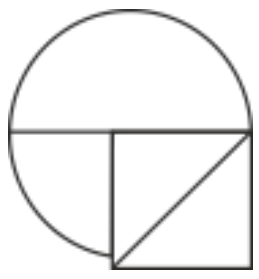

SSC MTS 05/10/2021 ( Morning )

(a) 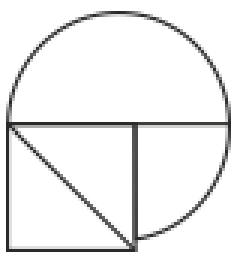

(b) 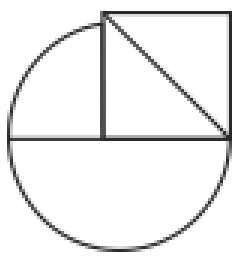

(c) 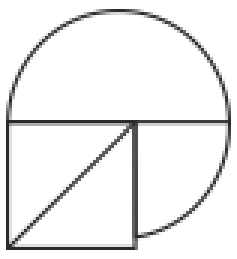

(d) 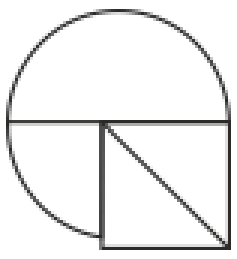

**Q.248.** Select the correct mirror image of the given figure when the mirror is placed to the right side of the figure.

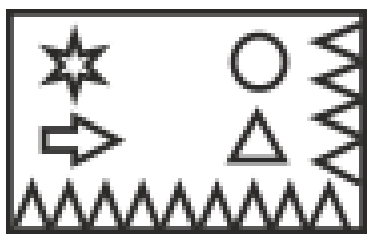

SSC MTS 05/10/2021 (Afternoon )

(a) 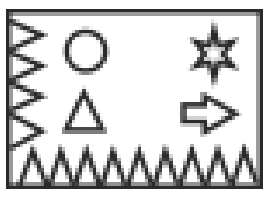

(b) 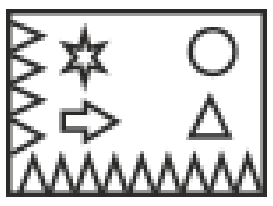

(c) 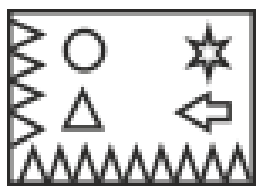

(d) 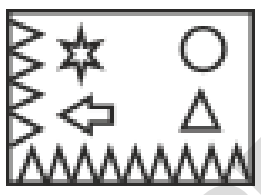

**Q.249.** Select the correct mirror image of the given figure when the mirror is placed to the right side of the figure.

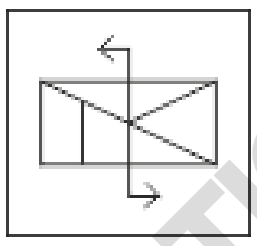

SSC MTS 05/10/2021 ( Evening )

(a) 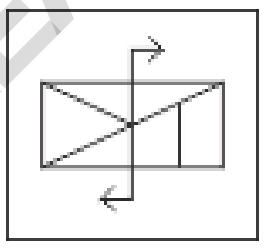

(b) 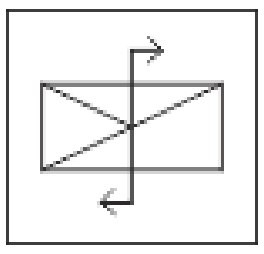

(c) 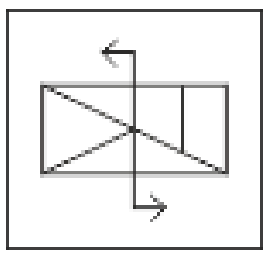

(d) 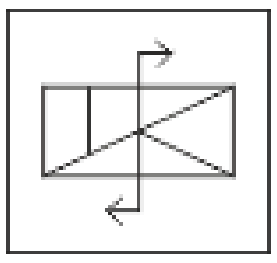

**Q.250.** Select the correct mirror image of the given figure when the mirror is placed to the right side of the figure.

RLKQSN

SSC MTS 06/10/2021 (Morning)

(a) NSQKLR

(b) 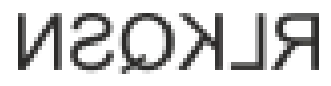

(c) 

(d) 

**Q.251.** Select the correct mirror image of the given combination when the mirror is placed at MN as shown below.



SSC MTS 06/10/2021 (Afternoon)

(a) 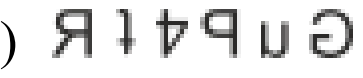

(b) 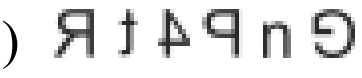

(c) 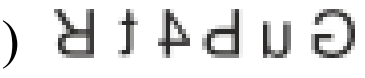

(d) 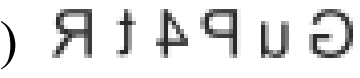

**Q.252.** Select the correct mirror image of the given combination when the mirror is placed to the right side of it.

Ù&Á?FS

SSC MTS 06/10/2021 ( Evening )

[a] 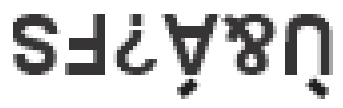

(b) 

(c) 

(d) 

**Q.253.** Select the correct mirror image of the given figure when the mirror is placed at MN as shown below.

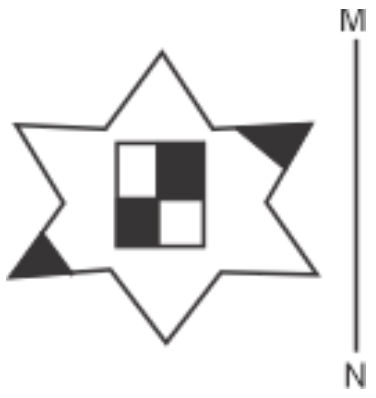

SSC MTS 07/10/2021 ( Morning )

(a) 

(b) 

(c) 

(d) 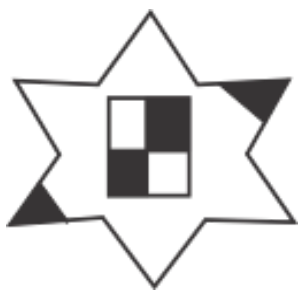

**Q.254.** Select the correct mirror image of the given figure when the mirror is placed at MN as shown below.



SSC MTS 07/10/2021 ( Afternoon )

(a) 

(b) 

(c) 

(d) 

**Q.255.** Select the mirror image of the figure, when the mirror is placed on the right side of the figure.

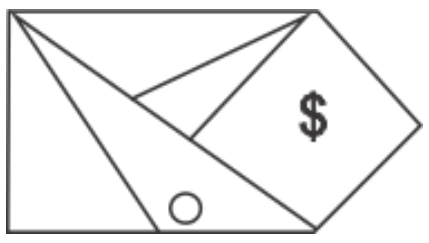

SSC MTS 07/10/2021 ( Evening )

(a) 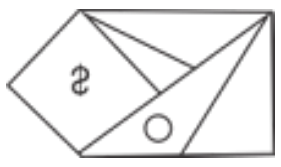

(b) 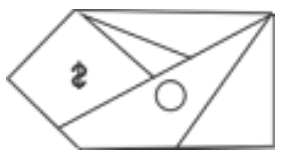

(c) 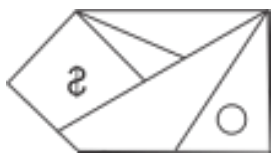

(d) 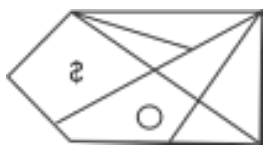

**Q.256.** Select the correct mirror image of the given figure when the mirror is placed to the right side of the figure.

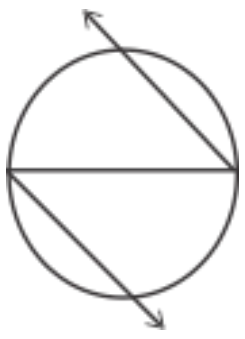

SSC MTS 08/10/2021 ( Morning )

(a) 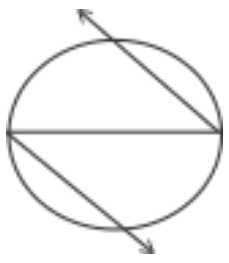

(b) 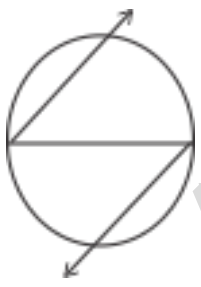

(c) 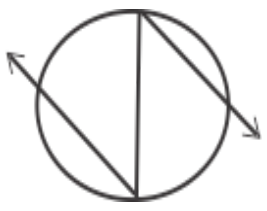

(d) 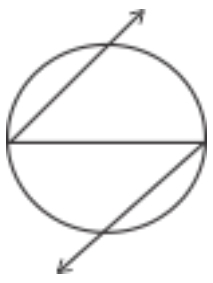

**Q.257.** Select the correct mirror image of the given combinations when the mirror is placed at MN as shown below.



SSC MTS 08/10/2021 (Afternoon)

(a) 

(b) 

(c) 

(d) 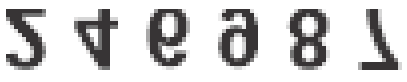

**Q.258.** Select the correct mirror image of the given combination when the mirror is placed at MN as shown below.

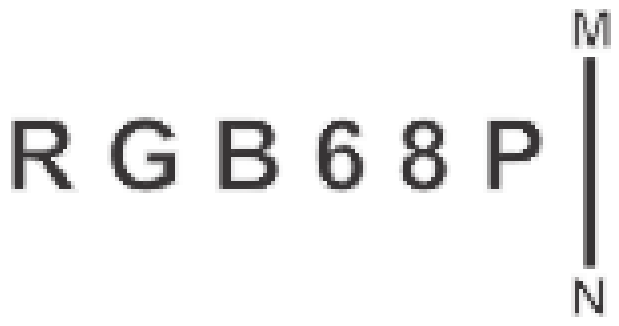

SSC MTS 08/10/2021 (Evening )

(a) 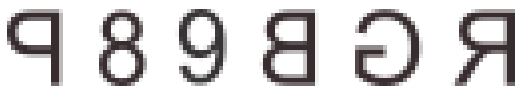

(b) 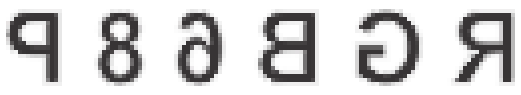

(c) 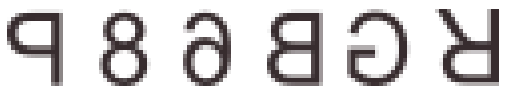

(d) 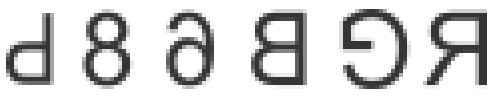

**Q.259.** Select the mirror image of the figure marked 'X', when the mirror is placed on the right side of the figure.

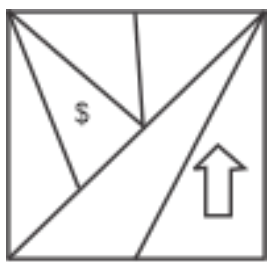

SSC MTS 11/10/2021 (Morning)

(a) 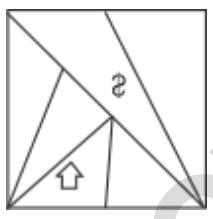

(b) 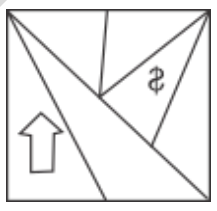

(c) 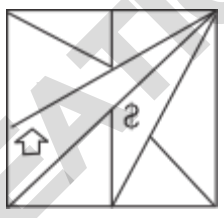

(d) 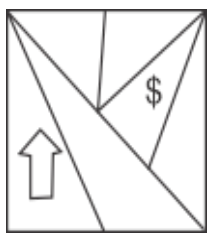

**Q.260.** Select the correct mirror image of the given figure when the mirror is placed to the right side of the figure.

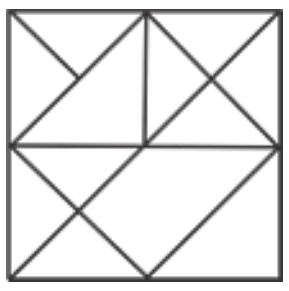

SSC MTS 11/10/2021 ( Afternoon)

(a) 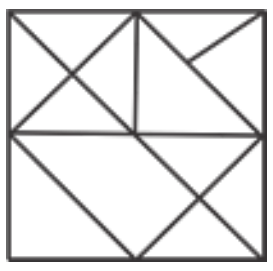

(b) 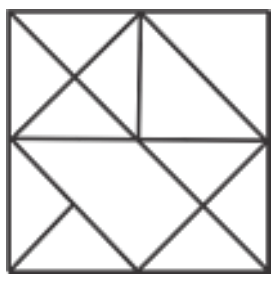

(c) 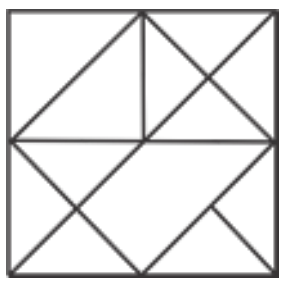

(d) 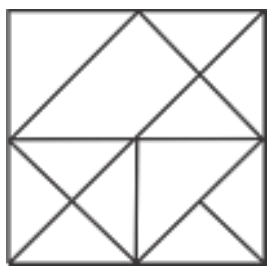

**Q.261.** Select the correct mirror image of the given figure when the mirror is placed to the right side of the figure.



SSC MTS 11/10/2021 ( Evening )

(a) 

(b) 

(c) 

(d) 

**Q.262.** Select the correct mirror image of the given figure when the mirror is placed to the right side of the figure.
SSC MTS 12/10/2021(Morning)

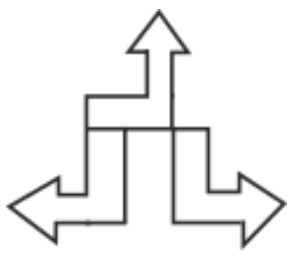

(a) 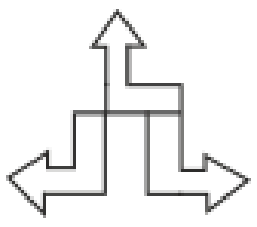

(b) 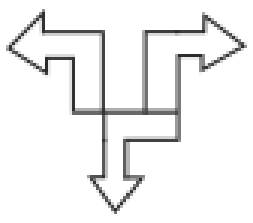

(c) 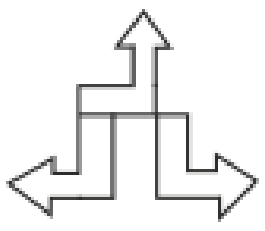

(d) 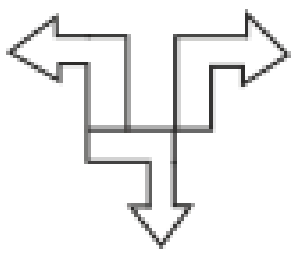

**Q.263.** Select the correct mirror image of the given figure when the mirror is placed to the right side of the figure.



SSC MTS 12/10/2021(Afternoon)

(a) 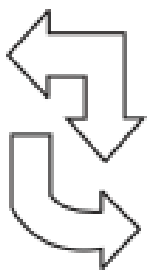

(b) 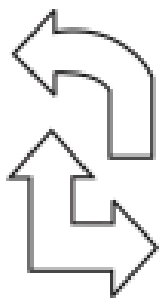

(c) 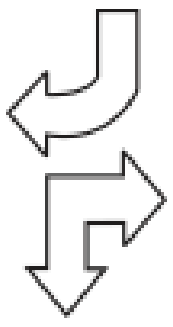

(d) 

**Q.264.** Select the mirror image of the figure marked 'X', when the mirror is placed on the right side of the figure.
SSC MTS 12/10/2021(Evening)

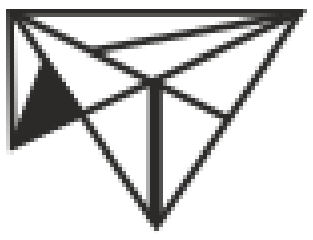

(a) 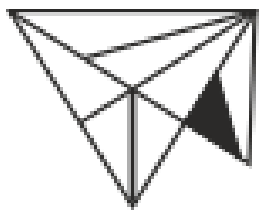

(b) 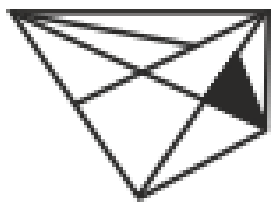

(c) 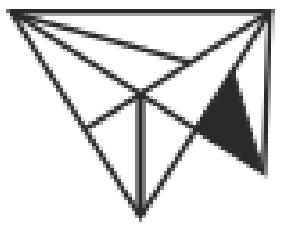

(d) 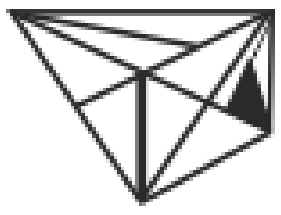

**Q.265.** Select the correct mirror image of the given combination when the mirror is placed to the right side of it.

& VEcTORANaL YsIS2

SSC MTS 13/10/2021(Morning)

(a) 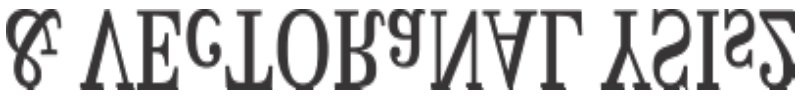

(b) 

(c) 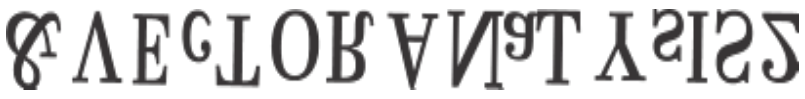

(d) 

**Q.266.** Select the correct mirror image of the given combination when the mirror is placed at MN as shown below.

SSC MTS 13/10/2021(Afternoon)

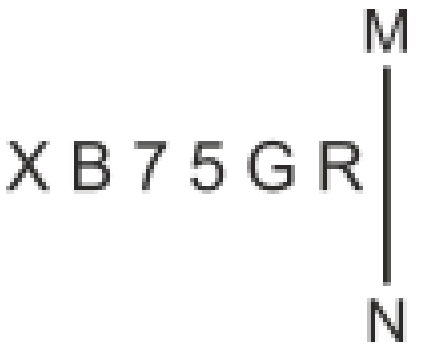

(a) 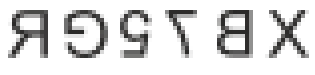

(b) 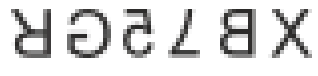

(c) 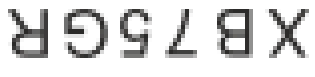

(d) 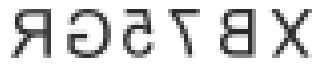

**Q.267.** Select the correct mirror image of the given figure when the mirror is placed to the right side of the figure.

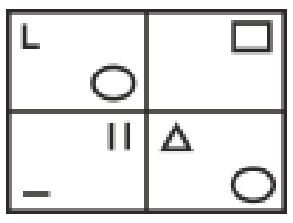

SSC MTS 13/10/2021(Evening)

(a) 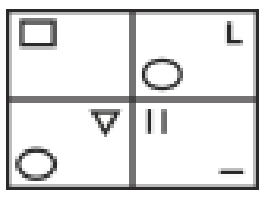

(b) 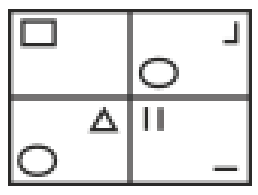

(c) 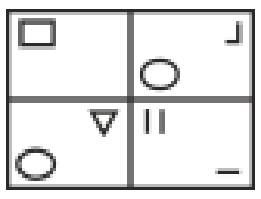

(d) 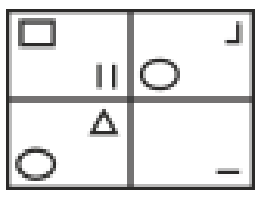

**Q.268.** Select the correct mirror image of the given figure when the mirror is placed to the right side of the figure.

SSC MTS 14/10/2021(Morning)

**SYMPTOMS**

(a) 

(b) 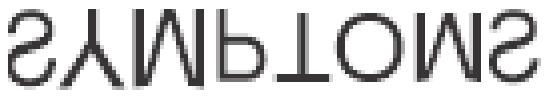

(c) 

(d) 

**Q.269.** Select the mirror image of the following figure, when the mirror is placed on the right side of the figure.

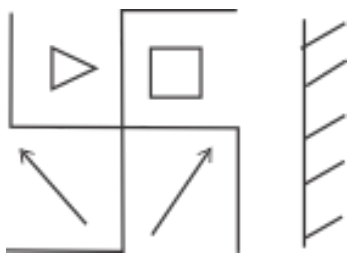

SSC MTS 14/10/2021(Afternoon)

(a) 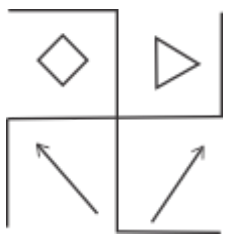

(b) 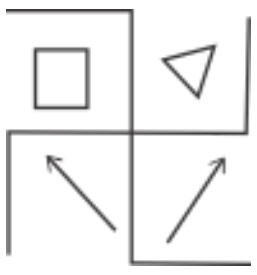

(c) 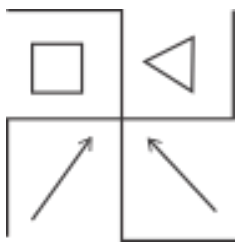

(d) 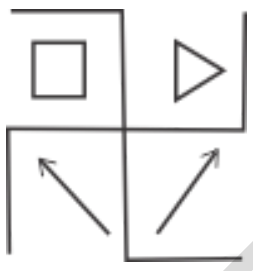

**Q.270.** Select the correct mirror image of the given figure when the mirror is placed to the right side of the figure.

SSC MTS 14/10/2021(Evening)

ß & Q @ £

(a) 

(b) 

(c) 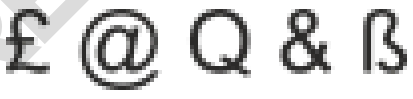

(d) 

**Q.271.** Select the mirror image of the following figure.

SSC MTS 18/10/2021(Morning)

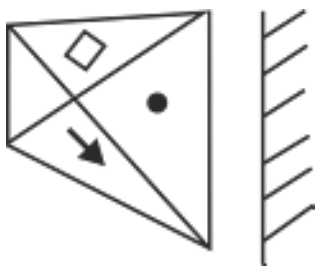

(a) 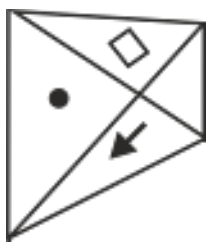

(b) 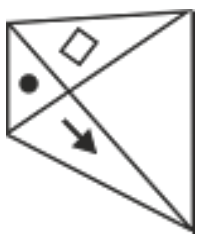

(c) 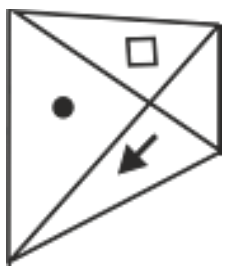

(d) 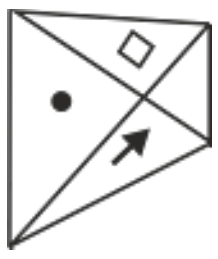

**Q.272.** Select the correct mirror image of the given figure when the mirror is placed to the right side of the figure.



SSC MTS 18/10/2021(Afternoon)

(a) 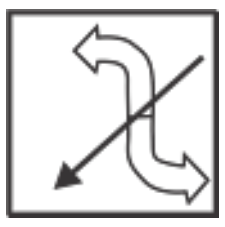

(b) 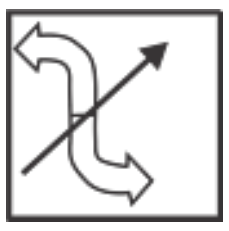

(c) 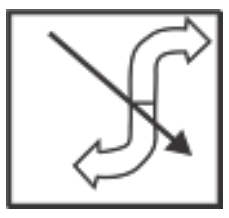

(d) 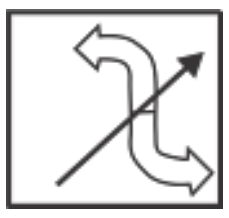

**Q.273.** Select the correct mirror image of the given figure when the mirror is placed at MN as shown below.

SSC MTS 18/10/2021(Evening)

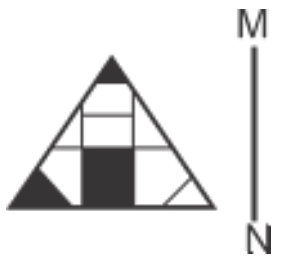

(a) 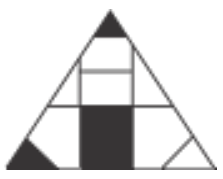

(b) 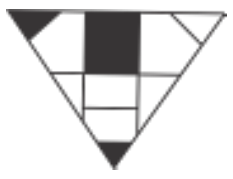

(c) 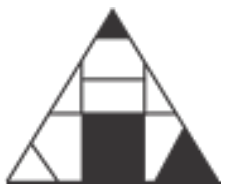

(d) 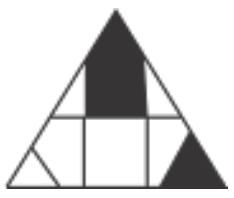

**Q.274.** Select the correct mirror image of the given figure when the mirror is placed to the right side of the figure.

SSC MTS 20/10/2021(Morning)



(a) 

(b) 

(c) 

(d) 

**Q.275.** Select the mirror image of the figure marked ‘x’ when the mirror is placed on the right side of the figure.

SSC MTS 20/10/2021(Afternoon)

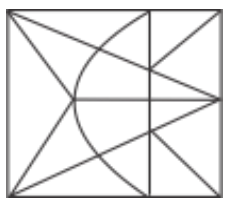

(a) 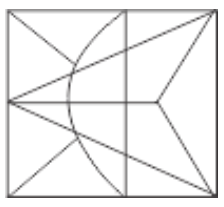

(b) 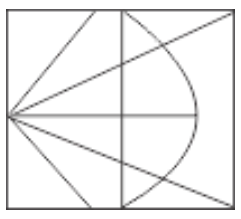

A.R. CREATIVE CENTRE

(c) 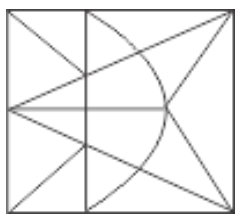 (d) 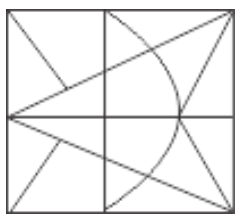

**Q.276.** Select the correct mirror image of the given figure when the mirror is placed at MN as shown below.
SSC MTS 20/10/2021(Evening)



(a)  (b) 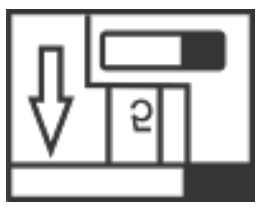
(c)  (d) 

**Q.277.** Select the correct mirror image of the given figure when the mirror is placed to the right side of the figure.
SSC MTS 22-10-2021 (Morning)

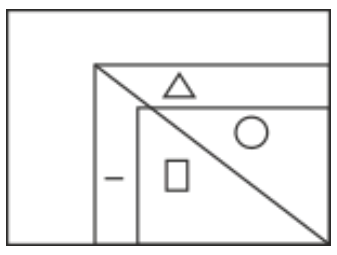

(a) 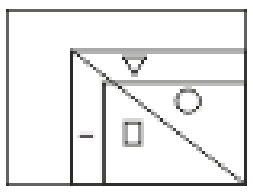 (b) 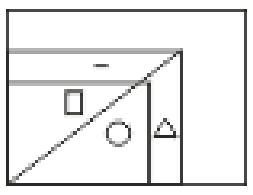
(c) 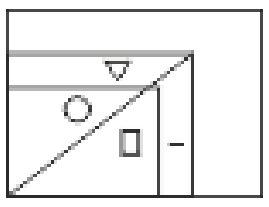 (d) 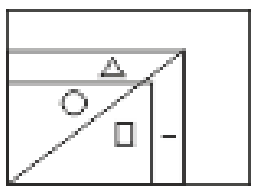

**Q.278.** Select the correct image of figure (x) when the mirror is placed at the right side of the figure.
SSC MTS 22-10-2021 (Afternoon)

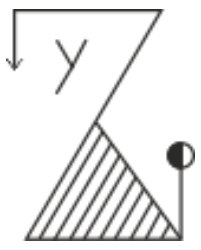

(a) 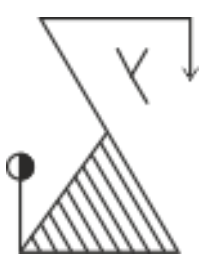 (b) 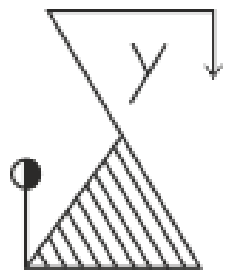
(c) 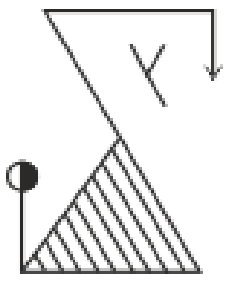 (d) 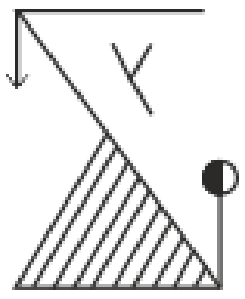

**Q.279.** Select the correct mirror image of the given figure when the mirror is placed to the right side of the figure.
SSC MTS 22-10-2021 (Evening)

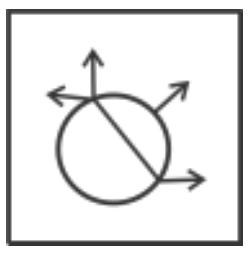

(a) 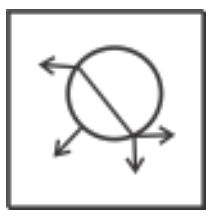 (b) 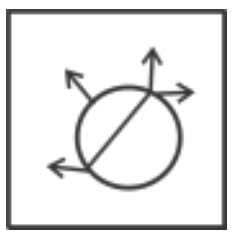
(c) 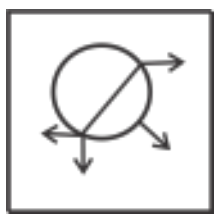 (d) 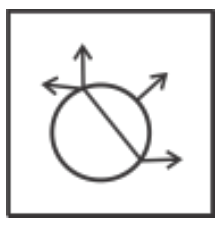

**Q.280.** Select the correct mirror image of the given figure when the mirror is placed to the right side of the figure.
SSC MTS 26-10-2021 (Morning)

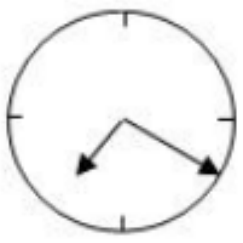

(a) 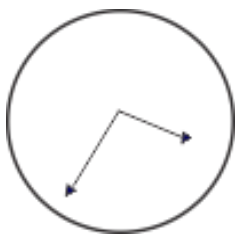 (b) 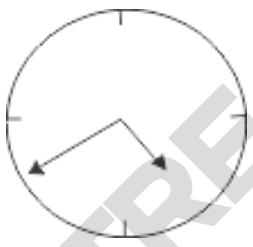
(c) 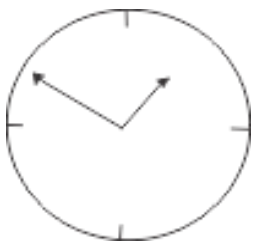 (d) 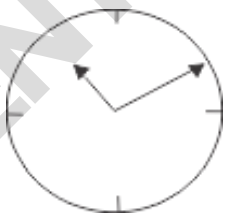

**Q.281.** Select the correct mirror image of figure (x) when the mirror is placed at the right side of the figure.
SSC MTS 26-10-2021 (Afternoon)



(a) 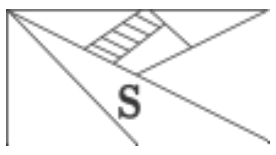 (b) 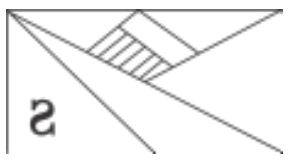
(c) 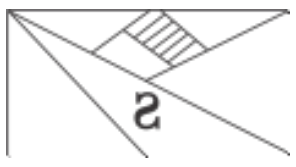 (d) 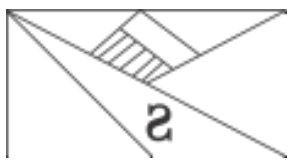

**Q.282.** Select the correct mirror image of the given combination when the mirror is placed at MN as shown below.
SSC MTS 26-10-2021 (Evening)

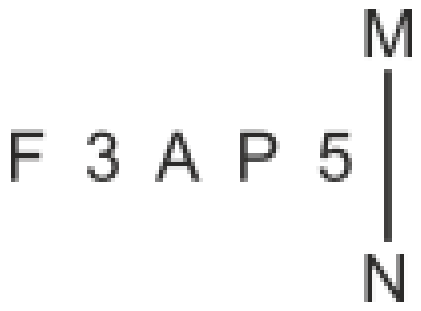

(a) 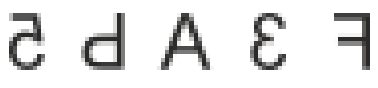
(b) 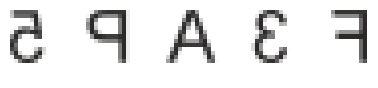
(c) 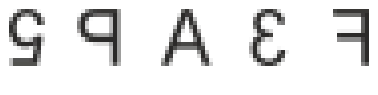
(d) 

**Q.283.** Select the correct image of the given combination when the mirror is placed at MN as shown below.
SSC MTS 27-10-2021 (Morning)

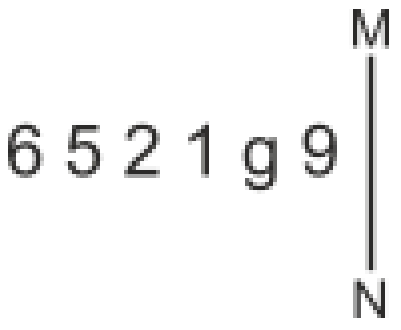

(a) 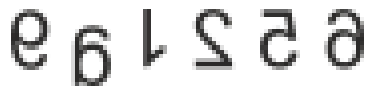
(b) 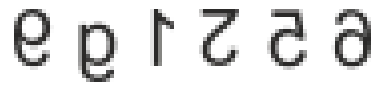
(c) 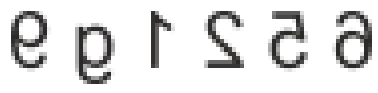
(d) 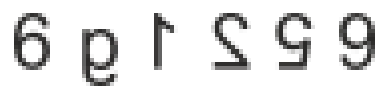

**Q.284.** Select the correct mirror image of the given figure when the mirror is placed to the right side of the figure.
SSC MTS 27-10-2021 (Afternoon)

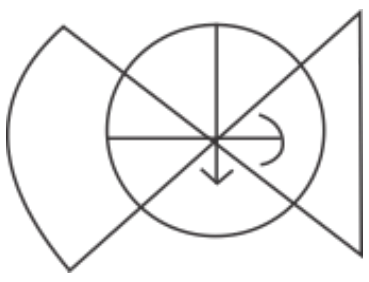

(a) 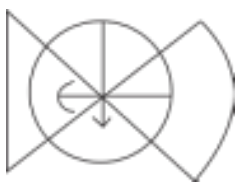 (b) 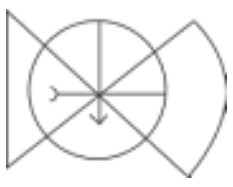
(c) 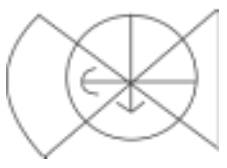 (d) 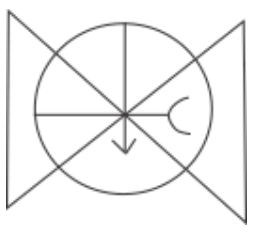

**Q.285.** Select the correct mirror image of the given figure when the mirror is placed to the right side of the figure
SSC MTS 27-10-2021 (Evening)

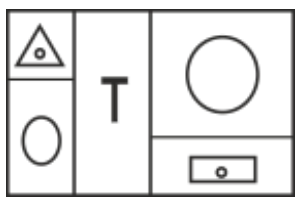

(a) 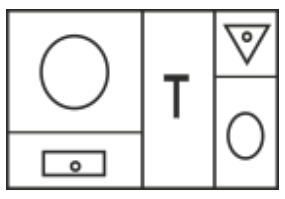 (b) 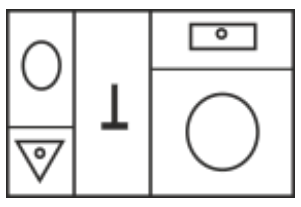
(c) 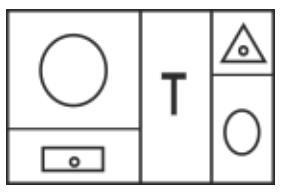 (d) 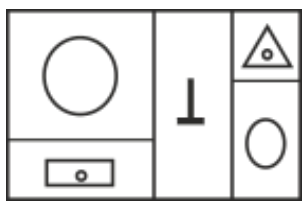

**Q.286.** Select the mirror image of figure marked X when the mirror is placed on right side of the figure ?
SSC MTS 02-11-2021 (Morning)

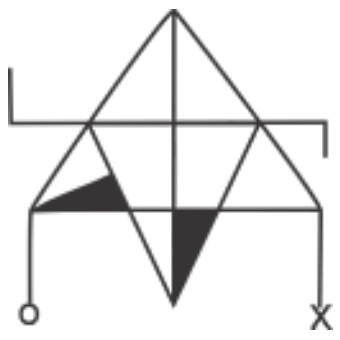

(a) 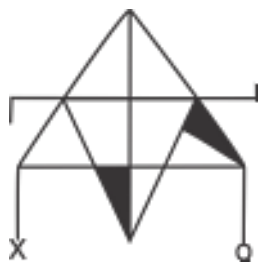
(b) 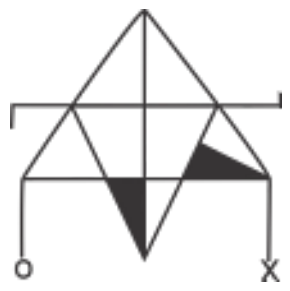

(c) 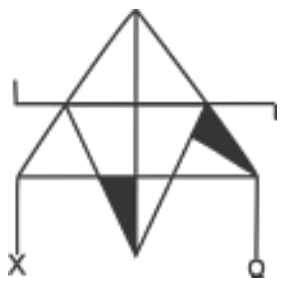
(d) 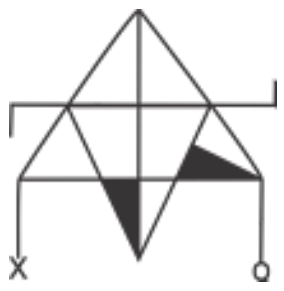

**Q.287.** Select the mirror image of the following figure (note the position of the mirror)

SSC MTS 02-11-2021 (Afternoon)



(a) 
(b) 

(c) 
(d) 

**Q.288.** Select the correct mirror image of the given figure when the mirror is placed to the right side of the figure ?

SSC MTS 2/11/2021(Evening)

ANTONYMS

(a) 

(b) ANTONYMS

(c) 

(d)